Summer Math · 1

At the summer barbecue there are 2 tables. 4 people sit at each table. How many people are there?

Summer Math · 2

Ben shares 32 cupcakes equally among 8 friends. How many cupcakes does each friend get?

Summer Math · 3

The family gets to the beach at 9:00. They stay for 2 hours. What time do they leave?



Summer Math · 4

The family gets to the beach at 9:00. They stay for 4 hours. What time do they leave?



Summer Math · 5

A watermelon is cut into 8 equal slices. The family eats 3 slices. What fraction of the watermelon did they eat?

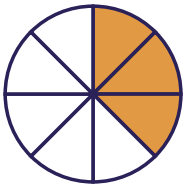

Summer Math · 6

At the summer barbecue there are 9 tables. 6 people sit at each table. How many people are there?

Summer Math · 7

A watermelon is cut into 10 equal slices. The family eats 1 slice. What fraction of the watermelon did they eat?

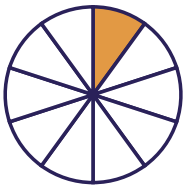

Summer Math · 8

Sam shares 48 cupcakes equally among 6 friends. How many cupcakes does each friend get?

Summer Math · 2

ANSWER

4

Summer Math · 1

ANSWER

8

Summer Math · 4

ANSWER

1:00

Summer Math · 3

ANSWER

11:00

Summer Math · 6

ANSWER

54

Summer Math · 5

ANSWER

$$\frac{3}{8}$$

Summer Math · 8

ANSWER

8

Summer Math · 7

ANSWER

$$\frac{1}{10}$$

Summer Math · 9

Leo shares 45 cupcakes equally among 9 friends. How many cupcakes does each friend get?

Summer Math · 10

At the summer barbecue there are 6 tables. 9 people sit at each table. How many people are there?

Summer Math · 11

At the summer barbecue there are 3 tables. 9 people sit at each table. How many people are there?

Summer Math · 12

A watermelon is cut into 8 equal slices. The family eats 1 slice. What fraction of the watermelon did they eat?

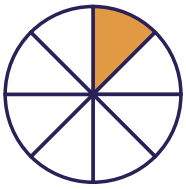

Summer Math · 13

Omar shares 30 blueberry muffins equally among 6 friends. How many blueberry muffins does each friend get?

Summer Math · 14

The family gets to the beach at 9:30. They stay for 5 hours. What time do they leave?



Summer Math · 15

The family gets to the beach at 10:00. They stay for 5 hours. What time do they leave?



Summer Math · 16

The family gets to the beach at 9:30. They stay for 2 hours. What time do they leave?



Summer Math · 10

ANSWER

54

Summer Math · 9

ANSWER

5

Summer Math · 12

ANSWER

$\frac{1}{8}$

Summer Math · 11

ANSWER

27

Summer Math · 14

ANSWER

2:30

Summer Math · 13

ANSWER

5

Summer Math · 16

ANSWER

11:30

Summer Math · 15

ANSWER

3:00

Summer Math · 17

Ella shares 18 cupcakes equally among 3 friends. How many cupcakes does each friend get?

Summer Math · 18

A watermelon is cut into 12 equal slices. The family eats 5 slices. What fraction of the watermelon did they eat?



Summer Math · 19

At the summer barbecue there are 2 tables. 2 people sit at each table. How many people are there?

Summer Math · 20

Ben shares 20 blueberry muffins equally among 2 friends. How many blueberry muffins does each friend get?

Summer Math · 21

The family gets to the beach at 11:00. They stay for 3 hours. What time do they leave?



Summer Math · 22

At the summer barbecue there are 3 tables. 3 people sit at each table. How many people are there?

Summer Math · 23

The family gets to the beach at 9:00. They stay for 5 hours. What time do they leave?



Summer Math · 24

A watermelon is cut into 8 equal slices. The family eats 5 slices. What fraction of the watermelon did they eat?

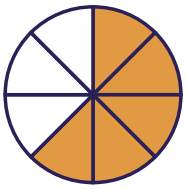

Summer Math · 18

ANSWER

$\frac{5}{12}$

Summer Math · 17

ANSWER

6

Summer Math · 20

ANSWER

10

Summer Math · 19

ANSWER

4

Summer Math · 22

ANSWER

9

Summer Math · 21

ANSWER

2:00

Summer Math · 24

ANSWER

$\frac{5}{8}$

Summer Math · 23

ANSWER

2:00