Summer Math · 1

At the summer barbecue there are 2 tables. 3 people sit at each table. How many people are there?

Summer Math · 2

Lily shares 35 blueberry muffins equally among 7 friends. How many blueberry muffins does each friend get?

Summer Math · 3

A watermelon is cut into 6 equal slices. The family eats 1 slice. What fraction of the watermelon did they eat?

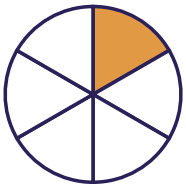

Summer Math · 4

The family gets to the beach at 12:00. They stay for 5 hours. What time do they leave?



Summer Math · 5

A watermelon is cut into 8 equal slices. The family eats 1 slice. What fraction of the watermelon did they eat?

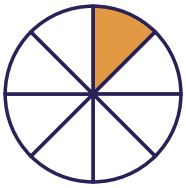

Summer Math · 6

Ava shares 24 cupcakes equally among 6 friends. How many cupcakes does each friend get?

Summer Math · 7

At the summer barbecue there are 6 tables. 3 people sit at each table. How many people are there?

Summer Math · 8

The family gets to the beach at 9:00. They stay for 4 hours. What time do they leave?



Summer Math · 2

ANSWER

5

Summer Math · 1

ANSWER

6

Summer Math · 4

ANSWER

5:00

Summer Math · 3

ANSWER

$\frac{1}{6}$

Summer Math · 6

ANSWER

4

Summer Math · 5

ANSWER

$\frac{1}{8}$

Summer Math · 8

ANSWER

1:00

Summer Math · 7

ANSWER

18

Summer Math · 9

The family gets to the beach at 11:00. They stay for 2 hours. What time do they leave?



Summer Math · 10

At the summer barbecue there are 7 tables. 6 people sit at each table. How many people are there?

Summer Math · 11

Omar shares 20 cupcakes equally among 4 friends. How many cupcakes does each friend get?

Summer Math · 12

Lily shares 10 cupcakes equally among 5 friends. How many cupcakes does each friend get?

Summer Math · 13

A watermelon is cut into 8 equal slices. The family eats 3 slices. What fraction of the watermelon did they eat?

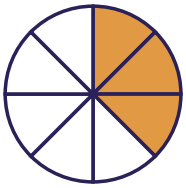

Summer Math · 14

At the summer barbecue there are 6 tables. 6 people sit at each table. How many people are there?

Summer Math · 15

Zoe shares 12 blueberry muffins equally among 4 friends. How many blueberry muffins does each friend get?

Summer Math · 16

The family gets to the beach at 12:00. They stay for 4 hours. What time do they leave?



Summer Math · 10

ANSWER

42

Summer Math · 9

ANSWER

1:00

Summer Math · 12

ANSWER

2

Summer Math · 11

ANSWER

5

Summer Math · 14

ANSWER

36

Summer Math · 13

ANSWER

$$\frac{3}{8}$$

Summer Math · 16

ANSWER

4:00

Summer Math · 15

ANSWER

3

Summer Math · 17

Ava shares 27 lemon bars equally among 9 friends. How many lemon bars does each friend get?

Summer Math · 18

Ava shares 56 lemon bars equally among 8 friends. How many lemon bars does each friend get?

Summer Math · 19

At the summer barbecue there are 8 tables. 6 people sit at each table. How many people are there?

Summer Math · 20

The family gets to the beach at 10:00. They stay for 5 hours. What time do they leave?



Summer Math · 21

At the summer barbecue there are 7 tables. 2 people sit at each table. How many people are there?

Summer Math · 22

At the summer barbecue there are 9 tables. 3 people sit at each table. How many people are there?

Summer Math · 23

A watermelon is cut into 4 equal slices. The family eats 3 slices. What fraction of the watermelon did they eat?



Summer Math · 24

Zoe shares 28 cupcakes equally among 7 friends. How many cupcakes does each friend get?

Summer Math · 18

ANSWER

7

Summer Math · 17

ANSWER

3

Summer Math · 20

ANSWER

3:00

Summer Math · 19

ANSWER

48

Summer Math · 22

ANSWER

27

Summer Math · 21

ANSWER

14

Summer Math · 24

ANSWER

4

Summer Math · 23

ANSWER

$$\frac{3}{4}$$