Task card 1 St. Patrick's Day Math

Leo shares 12 shamrock cookies equally among 4 friends. How many shamrock cookies does each friend get?

Task card 2 St. Patrick's Day Math

The St. Patrick's Day parade starts at 10:00. It lasts 3 hours. What time does the parade end?



Task card 3 St. Patrick's Day Math

At the St. Patrick's Day party there are 6 tables. 7 people sit at each table. How many people are there?

Task card 4 St. Patrick's Day Math

Omar shares 25 mint cupcakes equally among 5 friends. How many mint cupcakes does each friend get?

Task card 5 St. Patrick's Day Math

At the St. Patrick's Day party there are 5 tables. 5 people sit at each table. How many people are there?

Task card 6 St. Patrick's Day Math

The St. Patrick's Day parade starts at 9:00. It lasts 3 hours. What time does the parade end?



Task card 7 St. Patrick's Day Math

A mint cake is cut into 10 equal slices. The family eats 3 slices. What fraction of the mint cake did they eat?

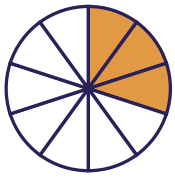

Task card 8 St. Patrick's Day Math

A mint cake is cut into 6 equal slices. The family eats 5 slices. What fraction of the mint cake did they eat?

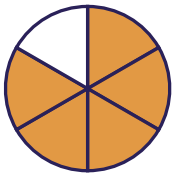

Task card 9 St. Patrick's Day Math

The St. Patrick's Day parade starts at 9:30. It lasts 3 hours. What time does the parade end?



Task card 10 St. Patrick's Day Math

The St. Patrick's Day parade starts at 9:00. It lasts 4 hours. What time does the parade end?



Task card 11 St. Patrick's Day Math

Zoe shares 45 shamrock cookies equally among 9 friends. How many shamrock cookies does each friend get?

Task card 12 St. Patrick's Day Math

A mint cake is cut into 8 equal slices. The family eats 5 slices. What fraction of the mint cake did they eat?

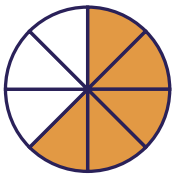

Task card 13 St. Patrick's Day Math

At the St. Patrick's Day party there are 3 tables. 2 people sit at each table. How many people are there?

Task card 14 St. Patrick's Day Math

A mint cake is cut into 10 equal slices. The family eats 1 slice. What fraction of the mint cake did they eat?

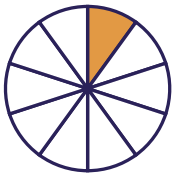

Task card 15 St. Patrick's Day Math

Lily shares 27 mint cupcakes equally among 9 friends. How many mint cupcakes does each friend get?

Task card 16 St. Patrick's Day Math

At the St. Patrick's Day party there are 6 tables. 5 people sit at each table. How many people are there?

Task card 17 St. Patrick's Day Math

The St. Patrick's Day parade starts at 10:00. It lasts 2 hours. What time does the parade end?



Task card 18 St. Patrick's Day Math

The St. Patrick's Day parade starts at 9:00. It lasts 2 hours. What time does the parade end?



Task card 19 St. Patrick's Day Math

Ben shares 36 mint cupcakes equally among 9 friends. How many mint cupcakes does each friend get?

Task card 20 St. Patrick's Day Math

Ava shares 90 shamrock cookies equally among 9 friends. How many shamrock cookies does each friend get?

Task card 21 St. Patrick's Day Math

At the St. Patrick's Day party there are 5 tables. 2 people sit at each table. How many people are there?

Task card 22 St. Patrick's Day Math

A mint cake is cut into 8 equal slices. The family eats 3 slices. What fraction of the mint cake did they eat?

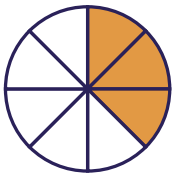

Task card 23 St. Patrick's Day Math

A mint cake is cut into 8 equal slices. The family eats 1 slice. What fraction of the mint cake did they eat?

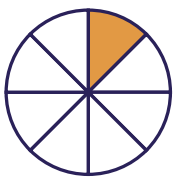

Task card 24 St. Patrick's Day Math

A mint cake is cut into 10 equal slices. The family eats 9 slices. What fraction of the mint cake did they eat?

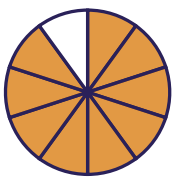

St. Patrick's Day Math Task Cards

Recording sheet · Grade 3 · Read each story and solve. Write times like 3:00 and fractions like 3/8.

Name: _____ Date: _____

Scan to check your answers

1	2	3	4
5	6	7	8
9	10	11	12
13	14	15	16
17	18	19	20
21	22	23	24

St. Patrick's Day Math Task Cards: Answer Key

Grade 3 · Medium

The answers online

1. 3	**2.** 1:00	**3.** 42
4. 5	**5.** 25	**6.** 12:00
7. $\frac{3}{10}$	**8.** $\frac{5}{6}$	**9.** 12:30
10. 1:00	**11.** 5	**12.** $\frac{5}{8}$
13. 6	**14.** $\frac{1}{10}$	**15.** 3
16. 30	**17.** 12:00	**18.** 11:00
19. 4	**20.** 10	**21.** 10
22. $\frac{3}{8}$	**23.** $\frac{1}{8}$	**24.** $\frac{9}{10}$