St. Patrick's Day Math · 1

Leo shares 12 shamrock cookies equally among 4 friends. How many shamrock cookies does each friend get?

St. Patrick's Day Math · 2

The St. Patrick's Day parade starts at 10:00. It lasts 3 hours. What time does the parade end?



St. Patrick's Day Math · 3

At the St. Patrick's Day party there are 6 tables. 7 people sit at each table. How many people are there?

St. Patrick's Day Math · 4

Omar shares 25 mint cupcakes equally among 5 friends. How many mint cupcakes does each friend get?

St. Patrick's Day Math · 5

At the St. Patrick's Day party there are 5 tables. 5 people sit at each table. How many people are there?

St. Patrick's Day Math · 6

The St. Patrick's Day parade starts at 9:00. It lasts 3 hours. What time does the parade end?



St. Patrick's Day Math · 7

A mint cake is cut into 10 equal slices. The family eats 3 slices. What fraction of the mint cake did they eat?

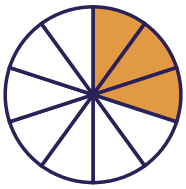

St. Patrick's Day Math · 8

A mint cake is cut into 6 equal slices. The family eats 5 slices. What fraction of the mint cake did they eat?

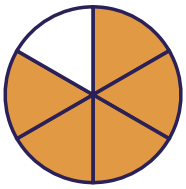

St. Patrick's Day Math · 2

ANSWER

1:00

St. Patrick's Day Math · 1

ANSWER

3

St. Patrick's Day Math · 4

ANSWER

5

St. Patrick's Day Math · 3

ANSWER

42

St. Patrick's Day Math · 6

ANSWER

12:00

St. Patrick's Day Math · 5

ANSWER

25

St. Patrick's Day Math · 8

ANSWER

$$\frac{5}{6}$$

St. Patrick's Day Math · 7

ANSWER

$$\frac{3}{10}$$

St. Patrick's Day Math · 9

The St. Patrick's Day parade starts at 9:30. It lasts 3 hours. What time does the parade end?



St. Patrick's Day Math · 10

The St. Patrick's Day parade starts at 9:00. It lasts 4 hours. What time does the parade end?



St. Patrick's Day Math · 11

Zoe shares 45 shamrock cookies equally among 9 friends. How many shamrock cookies does each friend get?

St. Patrick's Day Math · 12

A mint cake is cut into 8 equal slices. The family eats 5 slices. What fraction of the mint cake did they eat?

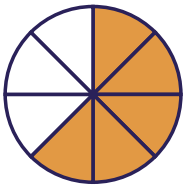

St. Patrick's Day Math · 13

At the St. Patrick's Day party there are 3 tables. 2 people sit at each table. How many people are there?

St. Patrick's Day Math · 14

A mint cake is cut into 10 equal slices. The family eats 1 slice. What fraction of the mint cake did they eat?

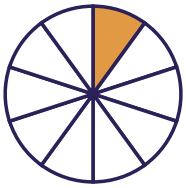

St. Patrick's Day Math · 15

Lily shares 27 mint cupcakes equally among 9 friends. How many mint cupcakes does each friend get?

St. Patrick's Day Math · 16

At the St. Patrick's Day party there are 6 tables. 5 people sit at each table. How many people are there?

St. Patrick's Day Math · 10

ANSWER

1:00

St. Patrick's Day Math · 9

ANSWER

12:30

St. Patrick's Day Math · 12

ANSWER

$$\frac{5}{8}$$

St. Patrick's Day Math · 11

ANSWER

5

St. Patrick's Day Math · 14

ANSWER

$$\frac{1}{10}$$

St. Patrick's Day Math · 13

ANSWER

6

St. Patrick's Day Math · 16

ANSWER

30

St. Patrick's Day Math · 15

ANSWER

3

St. Patrick's Day Math · 17

The St. Patrick's Day parade starts at 10:00. It lasts 2 hours. What time does the parade end?



St. Patrick's Day Math · 18

The St. Patrick's Day parade starts at 9:00. It lasts 2 hours. What time does the parade end?



St. Patrick's Day Math · 19

Ben shares 36 mint cupcakes equally among 9 friends. How many mint cupcakes does each friend get?

St. Patrick's Day Math · 20

Ava shares 90 shamrock cookies equally among 9 friends. How many shamrock cookies does each friend get?

St. Patrick's Day Math · 21

At the St. Patrick's Day party there are 5 tables. 2 people sit at each table. How many people are there?

St. Patrick's Day Math · 22

A mint cake is cut into 8 equal slices. The family eats 3 slices. What fraction of the mint cake did they eat?

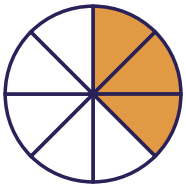

St. Patrick's Day Math · 23

A mint cake is cut into 8 equal slices. The family eats 1 slice. What fraction of the mint cake did they eat?

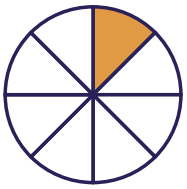

St. Patrick's Day Math · 24

A mint cake is cut into 10 equal slices. The family eats 9 slices. What fraction of the mint cake did they eat?

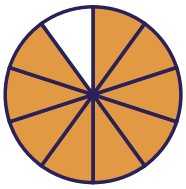

St. Patrick's Day Math · 18

ANSWER

11:00

St. Patrick's Day Math · 17

ANSWER

12:00

St. Patrick's Day Math · 20

ANSWER

10

St. Patrick's Day Math · 19

ANSWER

4

St. Patrick's Day Math · 22

ANSWER

$$\frac{3}{8}$$

St. Patrick's Day Math · 21

ANSWER

10

St. Patrick's Day Math · 24

ANSWER

$$\frac{9}{10}$$

St. Patrick's Day Math · 23

ANSWER

$$\frac{1}{8}$$