Scaled Picture Graphs & Bar Graphs · 1

How many more for Dogs than for Fish?

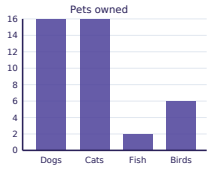

Scaled Picture Graphs & Bar Graphs · 2

What number does the graph show for Green?

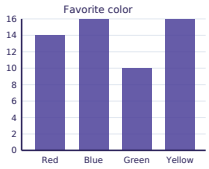

Scaled Picture Graphs & Bar Graphs · 3

How many more for Room 4 than for Room 3?

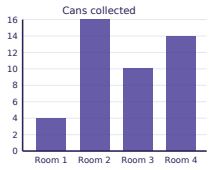

Scaled Picture Graphs & Bar Graphs · 4

What number does the graph show for Birds?

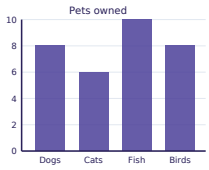

Scaled Picture Graphs & Bar Graphs · 5

What number does the graph show for Grapes?

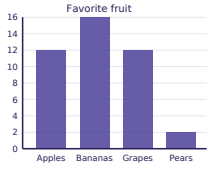

Scaled Picture Graphs & Bar Graphs · 6

How many more for Wed than for Fri?

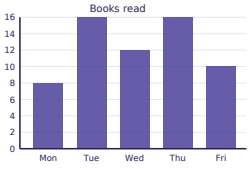

Scaled Picture Graphs & Bar Graphs · 7

What number does the graph show for Room 2?

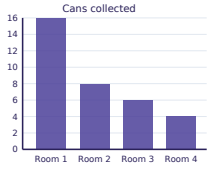

Scaled Picture Graphs & Bar Graphs · 8

How many more for Blue than for Red?

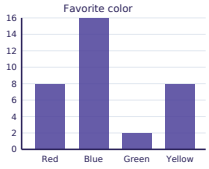

Scaled Picture Graphs & Bar Graphs · 2

ANSWER

10

Scaled Picture Graphs & Bar Graphs · 1

ANSWER

14

Scaled Picture Graphs & Bar Graphs · 4

ANSWER

8

Scaled Picture Graphs & Bar Graphs · 3

ANSWER

4

Scaled Picture Graphs & Bar Graphs · 6

ANSWER

2

Scaled Picture Graphs & Bar Graphs · 5

ANSWER

12

Scaled Picture Graphs & Bar Graphs · 8

ANSWER

8

Scaled Picture Graphs & Bar Graphs · 7

ANSWER

8

What is the total for all the categories?

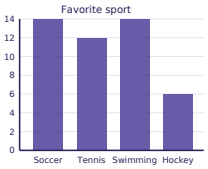

What number does the graph show for Swimming?

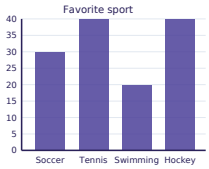

How many more for Fish than for Dogs?

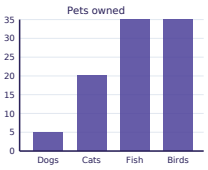

How many for Bananas and Pears together?

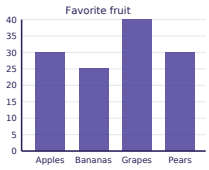

How many for Grapes and Bananas together?

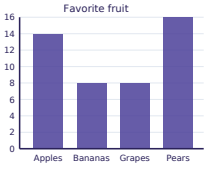

What number does the graph show for Green?

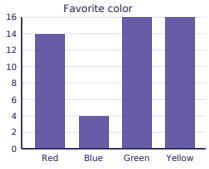

How many more for Apples than for Bananas?

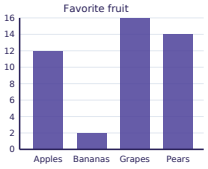

What number does the graph show for Thu?

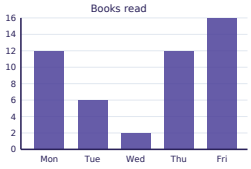

Scaled Picture Graphs & Bar Graphs · 10

ANSWER

20

Scaled Picture Graphs & Bar Graphs · 9

ANSWER

46

Scaled Picture Graphs & Bar Graphs · 12

ANSWER

55

Scaled Picture Graphs & Bar Graphs · 11

ANSWER

30

Scaled Picture Graphs & Bar Graphs · 14

ANSWER

16

Scaled Picture Graphs & Bar Graphs · 13

ANSWER

16

Scaled Picture Graphs & Bar Graphs · 16

ANSWER

12

Scaled Picture Graphs & Bar Graphs · 15

ANSWER

10

Scaled Picture Graphs & Bar Graphs · 17

What number does the graph show for Room 1?

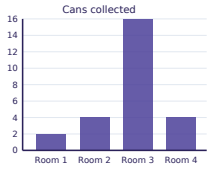

Scaled Picture Graphs & Bar Graphs · 18

How many more for Soccer than for Swimming?

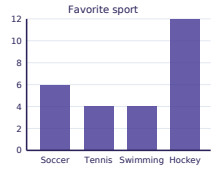

Scaled Picture Graphs & Bar Graphs · 19

What number does the graph show for Room 1?

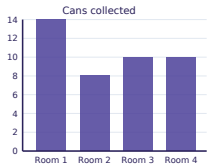

Scaled Picture Graphs & Bar Graphs · 20

How many more for Cats than for Fish?

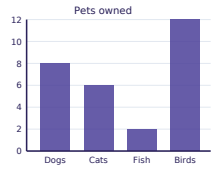

Scaled Picture Graphs & Bar Graphs · 21

What is the total for all the categories?

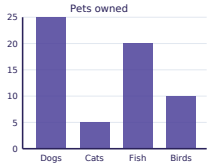

Scaled Picture Graphs & Bar Graphs · 22

What number does the graph show for Room 4?

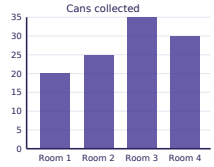

Scaled Picture Graphs & Bar Graphs · 23

How many more for Room 1 than for Room 4?

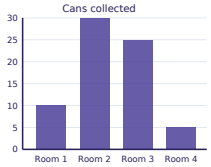

Scaled Picture Graphs & Bar Graphs · 24

How many for Mon and Fri together?

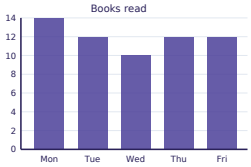

Scaled Picture Graphs & Bar Graphs · 18

ANSWER

2

Scaled Picture Graphs & Bar Graphs · 17

ANSWER

2

Scaled Picture Graphs & Bar Graphs · 20

ANSWER

4

Scaled Picture Graphs & Bar Graphs · 19

ANSWER

14

Scaled Picture Graphs & Bar Graphs · 22

ANSWER

30

Scaled Picture Graphs & Bar Graphs · 21

ANSWER

60

Scaled Picture Graphs & Bar Graphs · 24

ANSWER

26

Scaled Picture Graphs & Bar Graphs · 23

ANSWER

5