Task card 1 Fact Families: Multiplication & Di...

The top number is the product of the two bottom numbers. What is the missing number in this fact family?

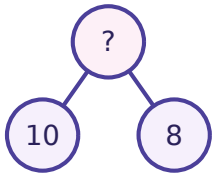

Task card 2 Fact Families: Multiplication & Di...

To find 60 ÷ 10, think: 10 × ___ = 60. What is 60 ÷ 10?

Task card 3 Fact Families: Multiplication & Di...

___ × 10 = 60

Task card 4 Fact Families: Multiplication & Di...

70 ÷ 10 = 7, so 7 × ___ = 70

Task card 5 Fact Families: Multiplication & Di...

55 ÷ 1 = ___

Task card 6 Fact Families: Multiplication & Di...

___ ÷ 3 = 2

Task card 7 Fact Families: Multiplication & Di...

The top number is the product of the two bottom numbers. What is the missing number in this fact family?

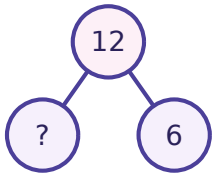

Task card 8 Fact Families: Multiplication & Di...

Which fact is NOT in the fact family of 4, 9 and 36? A) 4 × 9 = 36 B) 36 ÷ 4 = 9 C) 9 × 4 = 36 D) 36 ÷ 9 = 5. Write A, B, C or D.

Task card 9 Fact Families: Multiplication & Di...

The top number is the product of the two bottom numbers. What is the missing number in this fact family?

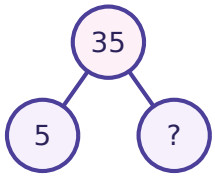

Task card 10 Fact Families: Multiplication & Di...

To find 16 ÷ 8, think: 8 × ___ = 16. What is 16 ÷ 8?

Task card 11 Fact Families: Multiplication & Di...

___ × 10 = 70

Task card 12 Fact Families: Multiplication & Di...

36 ÷ 6 = 6, so 6 × ___ = 36

Task card 13 Fact Families: Multiplication & Di...

$17 \div 1 = ___$

Task card 14 Fact Families: Multiplication & Di...

$___ \times 3 = 21$

Task card 15 Fact Families: Multiplication & Di...

The top number is the product of the two bottom numbers. What is the missing number in this fact family?

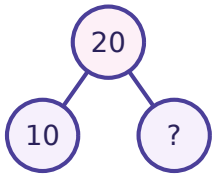

Task card 16 Fact Families: Multiplication & Di...

Which fact is NOT in the fact family of 4, 9 and 36? A) $4 \times 9 = 36$ B) $36 \div 4 = 9$ C) $9 \times 4 = 36$ D) $4 + 9 = 36$. Write A, B, C or D.

Task card 17 Fact Families: Multiplication & Di...

The top number is the product of the two bottom numbers. What is the missing number in this fact family?

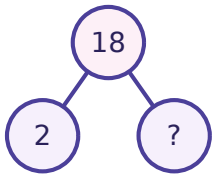

Task card 18 Fact Families: Multiplication & Di...

To find $18 \div 6$, think: $6 \times ___ = 18$. What is $18 \div 6$?

Task card 19 Fact Families: Multiplication & Di...

$81 \div 9 = 9$, so $9 \times ___ = 81$

Task card 20 Fact Families: Multiplication & Di...

$59 \div ___ = 59$

Task card 21 Fact Families: Multiplication & Di...

$21 \div ___ = 7$

Task card 22 Fact Families: Multiplication & Di...

The top number is the product of the two bottom numbers. What is the missing number in this fact family?

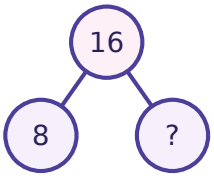

Task card 23 Fact Families: Multiplication & Di...

Which fact is NOT in the fact family of 3, 4 and 12? A) $3 \times 4 = 12$ B) $12 \div 3 = 4$ C) $4 \times 3 = 12$ D) $12 \div 4 = 4$. Write A, B, C or D.

Task card 24 Fact Families: Multiplication & Di...

The top number is the product of the two bottom numbers. What is the missing number in this fact family?

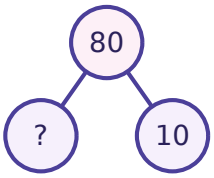

Fact Families: Multiplication & Division Task Cards

Recording sheet · Grade 3 · Find the missing number.

Scan to check your answers

Name: _____ Date: _____

1	2	3	4
5	6	7	8
9	10	11	12
13	14	15	16
17	18	19	20
21	22	23	24

Fact Families: Multiplication & Division Task Cards: Answer Key

Grade 3 · Hard

The answers online

1. 80	**2.** 6	**3.** 6
4. 10	**5.** 55	**6.** 6
7. 2	**8.** D	**9.** 7
10. 2	**11.** 7	**12.** 6
13. 17	**14.** 7	**15.** 2
16. D	**17.** 9	**18.** 3
19. 9	**20.** 1	**21.** 3
22. 2	**23.** D	**24.** 8