Task card 1 Fact Families: Multiplication & Di...

The top number is the product of the two bottom numbers. What is the missing number in this fact family?

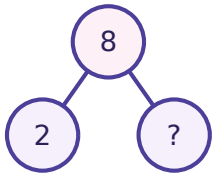

Task card 2 Fact Families: Multiplication & Di...

To find 35 ÷ 5, think: 5 × ___ = 35. What is 35 ÷ 5?

Task card 3 Fact Families: Multiplication & Di...

___ ÷ 7 = 2

Task card 4 Fact Families: Multiplication & Di...

2 × 8 = 16, so 16 ÷ 8 = ___

Task card 5 Fact Families: Multiplication & Di...

0 ÷ 13 = ___

Task card 6 Fact Families: Multiplication & Di...

___ ÷ 8 = 4

Task card 7 Fact Families: Multiplication & Di...

The top number is the product of the two bottom numbers. What is the missing number in this fact family?

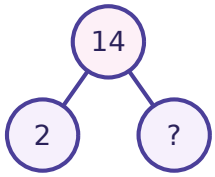

Task card 8 Fact Families: Multiplication & Di...

Which fact is NOT in the fact family of 3, 6 and 18? A) 3 × 6 = 18 B) 18 ÷ 3 = 6 C) 3 + 6 = 18 D) 6 × 3 = 18. Write A, B, C or D.

Task card 9 Fact Families: Multiplication & Di...

The top number is the product of the two bottom numbers. What is the missing number in this fact family?

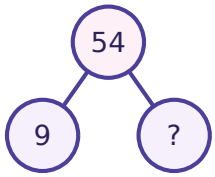

Task card 10 Fact Families: Multiplication & Di...

To find 24 ÷ 6, think: 6 × ___ = 24. What is 24 ÷ 6?

Task card 11 Fact Families: Multiplication & Di...

___ × 2 = 4

Task card 12 Fact Families: Multiplication & Di...

2 × 6 = 12, so 12 ÷ 6 = ___

Task card 13 Fact Families: Multiplication & Di...

$0 \div 17 = ___$

Task card 14 Fact Families: Multiplication & Di...

$8 \div ___ = 4$

Task card 15 Fact Families: Multiplication & Di...

The top number is the product of the two bottom numbers. What is the missing number in this fact family?

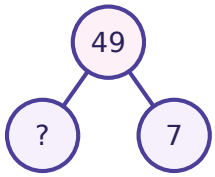

Task card 16 Fact Families: Multiplication & Di...

Which fact is NOT in the fact family of 5, 2 and 10? A) 5 × 2 = 10 B) 5 + 2 = 10 C) 2 × 5 = 10 D) 10 ÷ 5 = 2. Write A, B, C or D.

Task card 17 Fact Families: Multiplication & Di...

The top number is the product of the two bottom numbers. What is the missing number in this fact family?

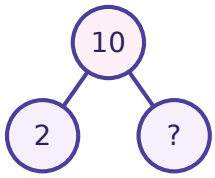

Task card 18 Fact Families: Multiplication & Di...

To find 40 ÷ 5, think: 5 × ___ = 40. What is 40 ÷ 5?

Task card 19 Fact Families: Multiplication & Di...

___ × 4 = 16

Task card 20 Fact Families: Multiplication & Di...

9 × 5 = 45, so

45 ÷ 5 = ___

Task card 21 Fact Families: Multiplication & Di...

58 ÷ 58 = ___

Task card 22 Fact Families: Multiplication & Di...

___ × 10 = 60

Task card 23 Fact Families: Multiplication & Di...

The top number is the product of the two bottom numbers. What is the missing number in this fact family?

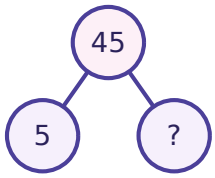

Task card 24 Fact Families: Multiplication & Di...

Which fact is NOT in the fact family of 3, 7 and 21? A) 3 × 7 = 21 B) 21 ÷ 3 = 7 C) 21 ÷ 7 = 4 D) 7 × 3 = 21. Write A, B, C or D.

Fact Families: Multiplication & Division Task Cards

Recording sheet · Grade 3 · Find the missing number.

Scan to check your answers

Name: _____ Date: _____

1	2	3	4
5	6	7	8
9	10	11	12
13	14	15	16
17	18	19	20
21	22	23	24

Fact Families: Multiplication & Division Task Cards: Answer Key

Grade 3 · Medium

The answers online

1. 4	**2.** 7	**3.** 14
4. 2	**5.** 0	**6.** 32
7. 7	**8.** C	**9.** 6
10. 4	**11.** 2	**12.** 2
13. 0	**14.** 2	**15.** 7
16. B	**17.** 5	**18.** 8
19. 4	**20.** 9	**21.** 1
22. 6	**23.** 9	**24.** C