Task card 1 Fact Families: Multiplication & Di...

The top number is the product of the two bottom numbers. What is the missing number in this fact family?

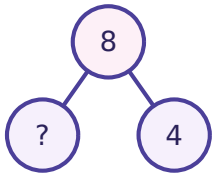

Task card 2 Fact Families: Multiplication & Di...

To find 4 ÷ 2, think: 2 × ___ = 4. What is 4 ÷ 2?

Task card 3 Fact Families: Multiplication & Di...

2 × 4 = 8, so 8 ÷ 4 = ___

Task card 4 Fact Families: Multiplication & Di...

The top number is the product of the two bottom numbers. What is the missing number in this fact family?

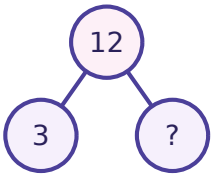

Task card 5 Fact Families: Multiplication & Di...

To find 9 ÷ 3, think: 3 × ___ = 9. What is 9 ÷ 3?

Task card 6 Fact Families: Multiplication & Di...

15 ÷ 5 = 3, so 3 × ___ = 15

Task card 7 Fact Families: Multiplication & Di...

To find 10 ÷ 5, think: 5 × ___ = 10. What is 10 ÷ 5?

Task card 8 Fact Families: Multiplication & Di...

The top number is the product of the two bottom numbers. What is the missing number in this fact family?

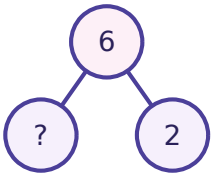

Task card 9 Fact Families: Multiplication & Di...

The top number is the product of the two bottom numbers. What is the missing number in this fact family?

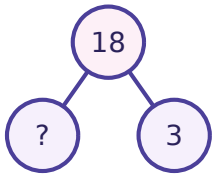

Task card 10 Fact Families: Multiplication & Di...

To find 12 ÷ 4, think: 4 × ___ = 12. What is 12 ÷ 4?

Task card 11 Fact Families: Multiplication & Di...

6 ÷ 3 = 2, so 2 × ___ = 6

Task card 12 Fact Families: Multiplication & Di...

The top number is the product of the two bottom numbers. What is the missing number in this fact family?

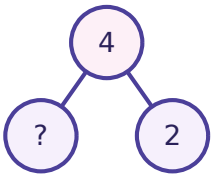

Task card 13 Fact Families: Multiplication & Di...

To find 25 ÷ 5, think: 5 × ___ = 25. What is 25 ÷ 5?

Task card 14 Fact Families: Multiplication & Di...

15 ÷ 3 = 5, so 5 × ___ = 15

Task card 15 Fact Families: Multiplication & Di...

The top number is the product of the two bottom numbers. What is the missing number in this fact family?

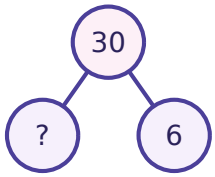

Task card 16 Fact Families: Multiplication & Di...

The top number is the product of the two bottom numbers. What is the missing number in this fact family?

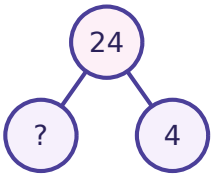

Task card 17 Fact Families: Multiplication & Di...

To find 18 ÷ 3, think: 3 × ___ = 18. What is 18 ÷ 3?

Task card 18 Fact Families: Multiplication & Di...

___ ÷ 2 = 7

Task card 19 Fact Families: Multiplication & Di...

$4 \times 3 = 12$, so

$12 \div 3 =$ ___

Task card 20 Fact Families: Multiplication & Di...

$14 \div 14 =$ ___

Task card 21 Fact Families: Multiplication & Di...

___ $\times 3 = 6$

Task card 22 Fact Families: Multiplication & Di...

The top number is the product of the two bottom numbers. What is the missing number in this fact family?

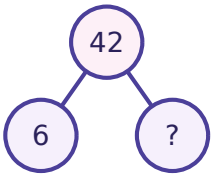

Task card 23 Fact Families: Multiplication & Di...

Which fact is NOT in the fact family of 4, 5 and 20? A) 4 × 5 = 20 B) 20 ÷ 4 = 5 C) 5 × 4 = 20 D) 20 ÷ 5 = 5. Write A, B, C or D.

Task card 24 Fact Families: Multiplication & Di...

The top number is the product of the two bottom numbers. What is the missing number in this fact family?

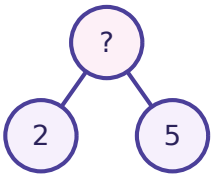

Fact Families: Multiplication & Division Task Cards

Recording sheet · Grade 3 · Find the missing number.

Scan to check your answers

Name: _____ Date: _____

1	2	3	4
5	6	7	8
9	10	11	12
13	14	15	16
17	18	19	20
21	22	23	24

Fact Families: Multiplication & Division Task Cards: Answer Key

Grade 3 · Easy

The answers online

1. 2	**2.** 2	**3.** 2
4. 4	**5.** 3	**6.** 5
7. 2	**8.** 3	**9.** 6
10. 3	**11.** 3	**12.** 2
13. 5	**14.** 3	**15.** 5
16. 6	**17.** 6	**18.** 14
19. 4	**20.** 1	**21.** 2
22. 7	**23.** D	**24.** 10