Fact Families: Multiplication & Division · 1

The top number is the product of the two bottom numbers. What is the missing number in this fact family?

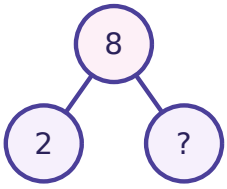

Fact Families: Multiplication & Division · 2

To find 35 ÷ 5, think: 5 × ___ = 35. What is 35 ÷ 5?

Fact Families: Multiplication & Division · 3

___ ÷ 7 = 2

Fact Families: Multiplication & Division · 4

2 × 8 = 16, so 16 ÷ 8 = ___

Fact Families: Multiplication & Division · 5

0 ÷ 13 = ___

Fact Families: Multiplication & Division · 6

___ ÷ 8 = 4

Fact Families: Multiplication & Division · 7

The top number is the product of the two bottom numbers. What is the missing number in this fact family?

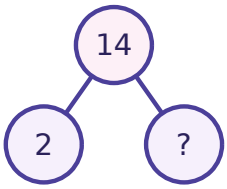

Fact Families: Multiplication & Division · 8

Which fact is NOT in the fact family of 3, 6 and 18? A) 3 × 6 = 18 B) 18 ÷ 3 = 6 C) 3 + 6 = 18 D) 6 × 3 = 18. Write A, B, C or D.

Fact Families: Multiplication & Division · 2

ANSWER

7

Fact Families: Multiplication & Division · 1

ANSWER

4

Fact Families: Multiplication & Division · 4

ANSWER

2

Fact Families: Multiplication & Division · 3

ANSWER

14

Fact Families: Multiplication & Division · 6

ANSWER

32

Fact Families: Multiplication & Division · 5

ANSWER

0

Fact Families: Multiplication & Division · 8

ANSWER

C

Fact Families: Multiplication & Division · 7

ANSWER

7

Fact Families: Multiplication & Division · 9

The top number is the product of the two bottom numbers. What is the missing number in this fact family?

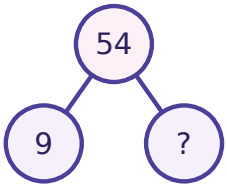

Fact Families: Multiplication & Division · 10

To find 24 ÷ 6, think: 6 × ___ = 24. What is 24 ÷ 6?

Fact Families: Multiplication & Division · 11

___ × 2 = 4

Fact Families: Multiplication & Division · 12

2 × 6 = 12, so 12 ÷ 6 = ___

Fact Families: Multiplication & Division · 13

0 ÷ 17 = ___

Fact Families: Multiplication & Division · 14

8 ÷ ___ = 4

Fact Families: Multiplication & Division · 15

The top number is the product of the two bottom numbers. What is the missing number in this fact family?

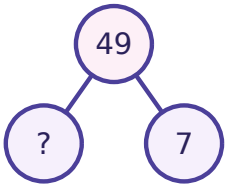

Fact Families: Multiplication & Division · 16

Which fact is NOT in the fact family of 5, 2 and 10? A) 5 × 2 = 10 B) 5 + 2 = 10 C) 2 × 5 = 10 D) 10 ÷ 5 = 2. Write A, B, C or D.

Fact Families: Multiplication & Division · 10

ANSWER

4

Fact Families: Multiplication & Division · 9

ANSWER

6

Fact Families: Multiplication & Division · 12

ANSWER

2

Fact Families: Multiplication & Division · 11

ANSWER

2

Fact Families: Multiplication & Division · 14

ANSWER

2

Fact Families: Multiplication & Division · 13

ANSWER

0

Fact Families: Multiplication & Division · 16

ANSWER

B

Fact Families: Multiplication & Division · 15

ANSWER

7

The top number is the product of the two bottom numbers. What is the missing number in this fact family?

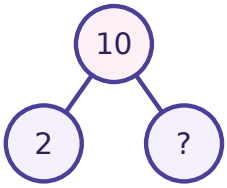

To find 40 ÷ 5, think: 5 × ___ = 40. What is 40 ÷ 5?

___ × 4 = 16

9 × 5 = 45, so 45 ÷ 5 = ___

58 ÷ 58 = ___

___ × 10 = 60

The top number is the product of the two bottom numbers. What is the missing number in this fact family?

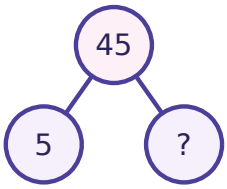

Which fact is NOT in the fact family of 3, 7 and 21? A) 3 × 7 = 21 B) 21 ÷ 3 = 7 C) 21 ÷ 7 = 4 D) 7 × 3 = 21. Write A, B, C or D.

Fact Families: Multiplication & Division · 18

ANSWER

8

Fact Families: Multiplication & Division · 17

ANSWER

5

Fact Families: Multiplication & Division · 20

ANSWER

9

Fact Families: Multiplication & Division · 19

ANSWER

4

Fact Families: Multiplication & Division · 22

ANSWER

6

Fact Families: Multiplication & Division · 21

ANSWER

1

Fact Families: Multiplication & Division · 24

ANSWER

C

Fact Families: Multiplication & Division · 23

ANSWER

9