Fact Families: Multiplication & Division · 1

The top number is the product of the two bottom numbers. What is the missing number in this fact family?

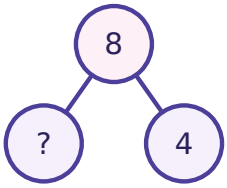

Fact Families: Multiplication & Division · 2

To find 4 ÷ 2, think: 2 × ___ = 4. What is 4 ÷ 2?

Fact Families: Multiplication & Division · 3

2 × 4 = 8, so 8 ÷ 4 = ___

Fact Families: Multiplication & Division · 4

The top number is the product of the two bottom numbers. What is the missing number in this fact family?

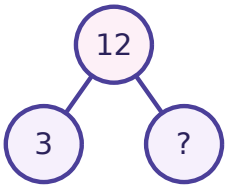

Fact Families: Multiplication & Division · 5

To find 9 ÷ 3, think: 3 × ___ = 9. What is 9 ÷ 3?

Fact Families: Multiplication & Division · 6

15 ÷ 5 = 3, so 3 × ___ = 15

Fact Families: Multiplication & Division · 7

To find 10 ÷ 5, think: 5 × ___ = 10. What is 10 ÷ 5?

Fact Families: Multiplication & Division · 8

The top number is the product of the two bottom numbers. What is the missing number in this fact family?

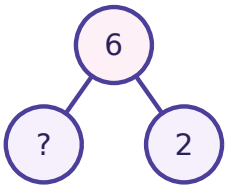

Fact Families: Multiplication & Division · 2

ANSWER

2

Fact Families: Multiplication & Division · 1

ANSWER

2

Fact Families: Multiplication & Division · 4

ANSWER

4

Fact Families: Multiplication & Division · 3

ANSWER

2

Fact Families: Multiplication & Division · 6

ANSWER

5

Fact Families: Multiplication & Division · 5

ANSWER

3

Fact Families: Multiplication & Division · 8

ANSWER

3

Fact Families: Multiplication & Division · 7

ANSWER

2

The top number is the product of the two bottom numbers. What is the missing number in this fact family?

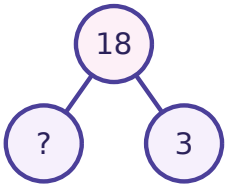

To find 12 ÷ 4, think: 4 × ___ = 12. What is 12 ÷ 4?

6 ÷ 3 = 2, so 2 × ___ = 6

The top number is the product of the two bottom numbers. What is the missing number in this fact family?

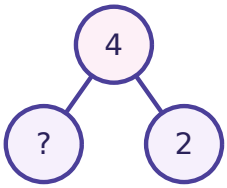

To find 25 ÷ 5, think: 5 × ___ = 25. What is 25 ÷ 5?

15 ÷ 3 = 5, so 5 × ___ = 15

The top number is the product of the two bottom numbers. What is the missing number in this fact family?

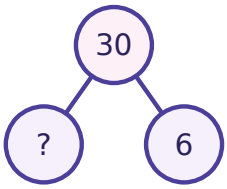

The top number is the product of the two bottom numbers. What is the missing number in this fact family?

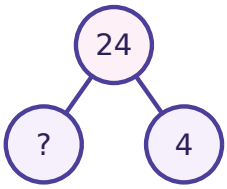

Fact Families: Multiplication & Division · 10

ANSWER

3

Fact Families: Multiplication & Division · 9

ANSWER

6

Fact Families: Multiplication & Division · 12

ANSWER

2

Fact Families: Multiplication & Division · 11

ANSWER

3

Fact Families: Multiplication & Division · 14

ANSWER

3

Fact Families: Multiplication & Division · 13

ANSWER

5

Fact Families: Multiplication & Division · 16

ANSWER

6

Fact Families: Multiplication & Division · 15

ANSWER

5

To find 18 ÷ 3, think: 3 × ___ = 18. What is 18 ÷ 3?

___ ÷ 2 = 7

4 × 3 = 12, so 12 ÷ 3 = ___

14 ÷ 14 = ___

___ × 3 = 6

The top number is the product of the two bottom numbers. What is the missing number in this fact family?

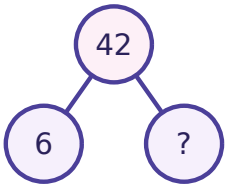

Which fact is NOT in the fact family of 4, 5 and 20? A) 4 × 5 = 20 B) 20 ÷ 4 = 5 C) 5 × 4 = 20 D) 20 ÷ 5 = 5. Write A, B, C or D.

The top number is the product of the two bottom numbers. What is the missing number in this fact family?

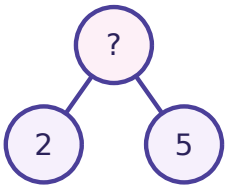

Fact Families: Multiplication & Division · 18

ANSWER

14

Fact Families: Multiplication & Division · 17

ANSWER

6

Fact Families: Multiplication & Division · 20

ANSWER

1

Fact Families: Multiplication & Division · 19

ANSWER

4

Fact Families: Multiplication & Division · 22

ANSWER

7

Fact Families: Multiplication & Division · 21

ANSWER

2

Fact Families: Multiplication & Division · 24

ANSWER

10

Fact Families: Multiplication & Division · 23

ANSWER

D