Task card 1 Quadrilaterals

Which name fits this shape best? Write square, rectangle, rhombus, parallelogram, or trapezoid.

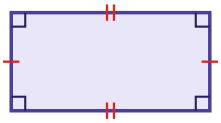

Task card 2 Quadrilaterals

How many right angles does this shape have?

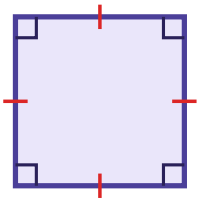

Task card 3 Quadrilaterals

Which name fits this shape best? Write square, rectangle, rhombus, parallelogram, or trapezoid.

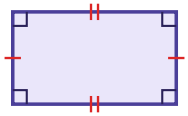

Task card 4 Quadrilaterals

How many pairs of parallel sides does this shape have?

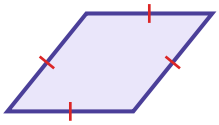

Task card 5 Quadrilaterals

Which name fits this shape best? Write square, rectangle, rhombus, parallelogram, or trapezoid.

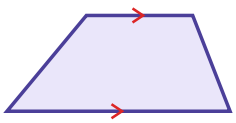

Task card 6 Quadrilaterals

How many right angles does this shape have?

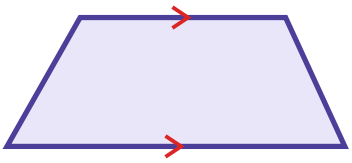

Task card 7 Quadrilaterals

Which name fits this shape best? Write square, rectangle, rhombus, parallelogram, or trapezoid.

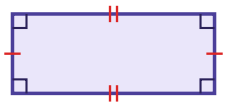

Task card 8 Quadrilaterals

How many pairs of parallel sides does this shape have?

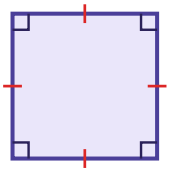

Task card 9 Quadrilaterals

Which name fits this shape best? Write square, rectangle, rhombus, parallelogram, or trapezoid.

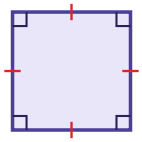

Task card 10 Quadrilaterals

How many right angles does this shape have?

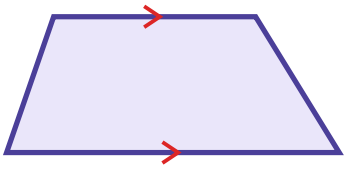

Task card 11 Quadrilaterals

Which name fits this shape best? Write square, rectangle, rhombus, parallelogram, or trapezoid.

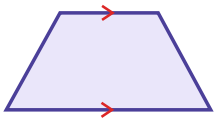

Task card 12 Quadrilaterals

How many pairs of parallel sides does this shape have?

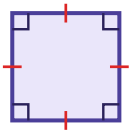

Task card 13 Quadrilaterals

Which name fits this shape best? Write square, rectangle, rhombus, parallelogram, or trapezoid.

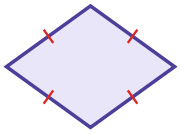

Task card 14 Quadrilaterals

How many right angles does this shape have?

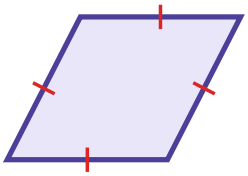

Task card 15 Quadrilaterals

Which name fits this shape best? Write square, rectangle, rhombus, parallelogram, or trapezoid.

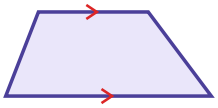

Task card 16 Quadrilaterals

How many pairs of parallel sides does this shape have?

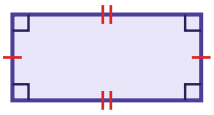

Task card 17 Quadrilaterals

Which name fits this shape best? Write square, rectangle, rhombus, parallelogram, or trapezoid.

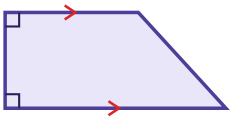

Task card 18 Quadrilaterals

How many right angles does this shape have?

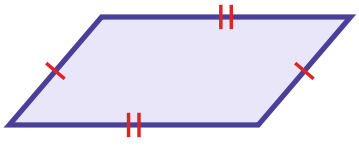

Task card 19 Quadrilaterals

How many pairs of parallel sides does this shape have?

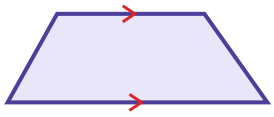

Task card 20 Quadrilaterals

Is every rectangle a square? Write yes or no.

Task card 21 Quadrilaterals

Which name fits this shape best? Write square, rectangle, rhombus, parallelogram, or trapezoid.

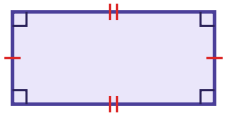

Task card 22 Quadrilaterals

How many pairs of parallel sides does this shape have?

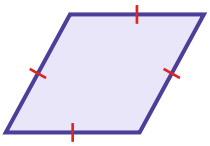

Task card 23 Quadrilaterals

Which name fits this shape best? Write square, rectangle, rhombus, parallelogram, or trapezoid.

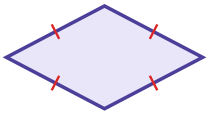

Task card 24 Quadrilaterals

Is every square a quadrilateral? Write yes or no.

Quadrilaterals Task Cards

Recording sheet · Grade 3 · Tick marks show sides of equal length. A small square shows a right angle. Arrows show parallel sides.

Name: _____ Date: _____

Scan to check your answers

1	2	3	4
5	6	7	8
9	10	11	12
13	14	15	16
17	18	19	20
21	22	23	24

Quadrilaterals Task Cards: Answer Key

Grade 3 · Easy

The answers online

1. rectangle	**2.** 4	**3.** rectangle
4. 2	**5.** trapezoid	**6.** 0
7. rectangle	**8.** 2	**9.** square
10. 0	**11.** trapezoid	**12.** 2
13. rhombus	**14.** 0	**15.** trapezoid
16. 2	**17.** trapezoid	**18.** 0
19. 1	**20.** no	**21.** rectangle
22. 2	**23.** rhombus	**24.** yes