Quadrilaterals · 1

Which name fits this shape best? Write square, rectangle, rhombus, parallelogram, or trapezoid.

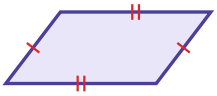

Quadrilaterals · 2

How many right angles does this shape have?

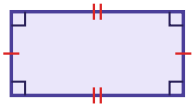

Quadrilaterals · 3

How many pairs of parallel sides does this shape have?

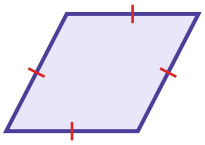

Quadrilaterals · 4

Is every rectangle a square? Write yes or no.

Quadrilaterals · 5

Which name fits this shape best? Write square, rectangle, rhombus, parallelogram, or trapezoid.

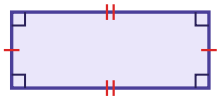

Quadrilaterals · 6

How many pairs of parallel sides does this shape have?

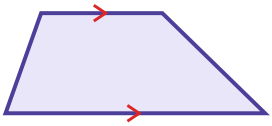

Quadrilaterals · 7

Which name fits this shape best? Write square, rectangle, rhombus, parallelogram, or trapezoid.

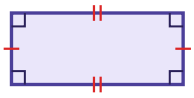

Quadrilaterals · 8

Is every square a rectangle? Write yes or no.

Quadrilaterals · 2

ANSWER

4

Quadrilaterals · 1

ANSWER

parallelogram

Quadrilaterals · 4

ANSWER

no

Quadrilaterals · 3

ANSWER

2

Quadrilaterals · 6

ANSWER

1

Quadrilaterals · 5

ANSWER

rectangle

Quadrilaterals · 8

ANSWER

yes

Quadrilaterals · 7

ANSWER

rectangle

Quadrilaterals · 9

Which name fits this shape best? Write square, rectangle, rhombus, parallelogram, or trapezoid.

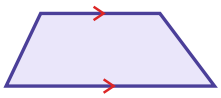

Quadrilaterals · 10

How many right angles does this shape have?

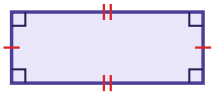

Quadrilaterals · 11

How many pairs of parallel sides does this shape have?

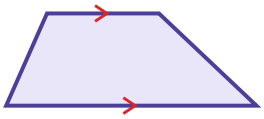

Quadrilaterals · 12

Is every quadrilateral a rectangle? Write yes or no.

Quadrilaterals · 13

Which name fits this shape best? Write square, rectangle, rhombus, parallelogram, or trapezoid.

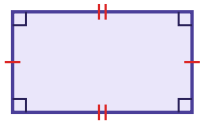

Quadrilaterals · 14

How many pairs of parallel sides does this shape have?

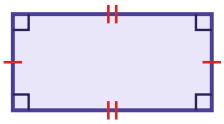

Quadrilaterals · 15

Which name fits this shape best? Write square, rectangle, rhombus, parallelogram, or trapezoid.

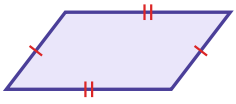

Quadrilaterals · 16

Does every quadrilateral have 4 sides and 4 angles? Write yes or no.

Quadrilaterals · 10

ANSWER

4

Quadrilaterals · 9

ANSWER

trapezoid

Quadrilaterals · 12

ANSWER

no

Quadrilaterals · 11

ANSWER

1

Quadrilaterals · 14

ANSWER

2

Quadrilaterals · 13

ANSWER

rectangle

Quadrilaterals · 16

ANSWER

yes

Quadrilaterals · 15

ANSWER

parallelogram

Quadrilaterals · 17

Which name fits this shape best? Write square, rectangle, rhombus, parallelogram, or trapezoid.

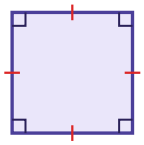

Quadrilaterals · 18

How many right angles does this shape have?

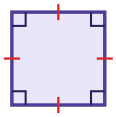

Quadrilaterals · 19

How many pairs of parallel sides does this shape have?

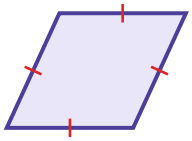

Quadrilaterals · 20

Which name fits this shape best? Write square, rectangle, rhombus, parallelogram, or trapezoid.

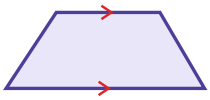

Quadrilaterals · 21

How many pairs of parallel sides does this shape have?

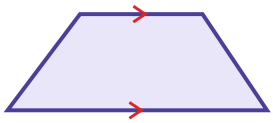

Quadrilaterals · 22

Which name fits this shape best? Write square, rectangle, rhombus, parallelogram, or trapezoid.

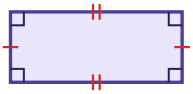

Quadrilaterals · 23

Which name fits this shape best? Write square, rectangle, rhombus, parallelogram, or trapezoid.

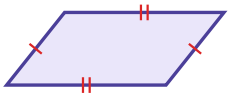

Quadrilaterals · 24

How many right angles does this shape have?

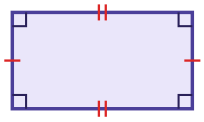

Quadrilaterals · 18

ANSWER

4

Quadrilaterals · 17

ANSWER

square

Quadrilaterals · 20

ANSWER

trapezoid

Quadrilaterals · 19

ANSWER

2

Quadrilaterals · 22

ANSWER

rectangle

Quadrilaterals · 21

ANSWER

1

Quadrilaterals · 24

ANSWER

4

Quadrilaterals · 23

ANSWER

parallelogram