Task card 1 Perimeter of Polygons & Unknown Si...

What is the perimeter of the shape in meters?

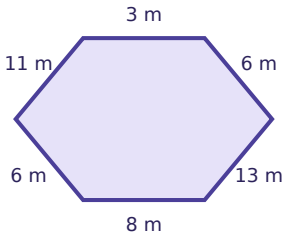

Task card 2 Perimeter of Polygons & Unknown Si...

The perimeter of the shape is 39 feet. How long is the side marked ?

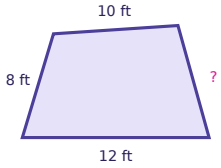

Task card 3 Perimeter of Polygons & Unknown Si...

The rectangle has a perimeter of 18 meters. How long is the side marked ?

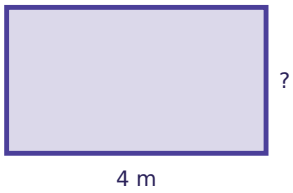

Task card 4 Perimeter of Polygons & Unknown Si...

The perimeter of the shape is 25 inches. How long is the side marked ?

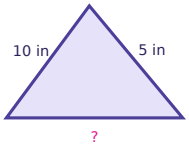

Task card 5 Perimeter of Polygons & Unknown Si...

A square has a perimeter of 12 centimeters. How long is each side in centimeters?

Task card 6 Perimeter of Polygons & Unknown Si...

What is the perimeter of the shape in feet?

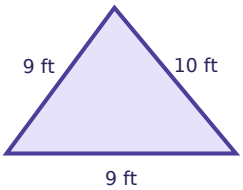

Task card 7 Perimeter of Polygons & Unknown Si...

The perimeter of the shape is 43 feet. How long is the side marked ?

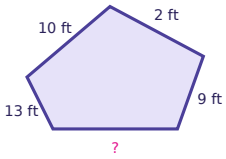

Task card 8 Perimeter of Polygons & Unknown Si...

The rectangle has a perimeter of 26 centimeters. How long is the side marked ?

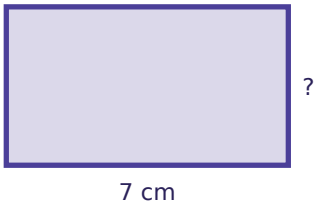

Task card 9 Perimeter of Polygons & Unknown Si...

The perimeter of the shape is 34 inches. How long is the side marked ?

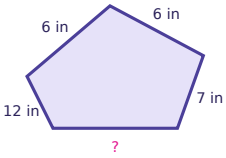

Task card 10 Perimeter of Polygons & Unknown Si...

The rectangle has a perimeter of 34 feet. How long is the side marked ?

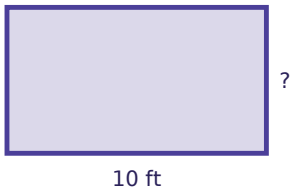

Task card 11 Perimeter of Polygons & Unknown Si...

Rectangle A is 5 in by 2 in. Rectangle B is 6 in by 1 in. Both have a perimeter of 14 inches. Which rectangle has the smaller area? Write A or B.

Task card 12 Perimeter of Polygons & Unknown Si...

The perimeter of the shape is 29 centimeters. How long is the side marked ?

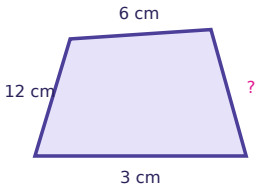

Task card 13 Perimeter of Polygons & Unknown Si...

What is the perimeter of the shape in centimeters?

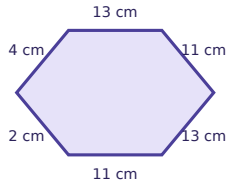

Task card 14 Perimeter of Polygons & Unknown Si...

A square has a perimeter of 8 meters. How long is each side in meters?

Task card 15 Perimeter of Polygons & Unknown Si...

Rectangle A is 11 ft by 1 ft. Rectangle B is 8 ft by 4 ft. Both have a perimeter of 24 feet. Which rectangle has the greater area? Write A or B.

Task card 16 Perimeter of Polygons & Unknown Si...

The perimeter of the shape is 44 centimeters. How long is the side marked ?

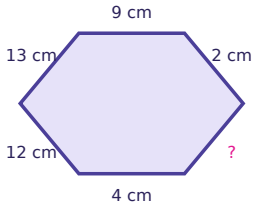

Task card 17 Perimeter of Polygons & Unknown Si...

The perimeter of the shape is 66 inches. How long is the side marked ?

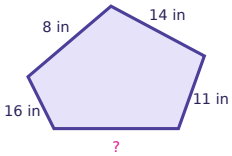

Task card 18 Perimeter of Polygons & Unknown Si...

The rectangle has a perimeter of 20 feet. How long is the side marked ?

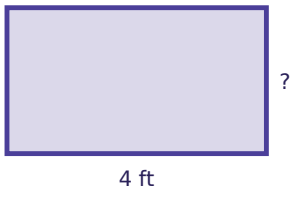

Task card 19 Perimeter of Polygons & Unknown Si...

Rectangle A is 5 cm by 2 cm. Rectangle B is 6 cm by 1 cm. Both have a perimeter of 14 centimeters. Which rectangle has the smaller area? Write A or B.

Task card 20 Perimeter of Polygons & Unknown Si...

The perimeter of the shape is 48 centimeters. How long is the side marked ?

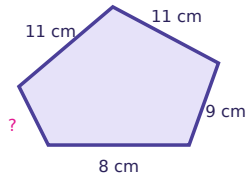

Task card 21 Perimeter of Polygons & Unknown Si...

What is the perimeter of the shape in meters?

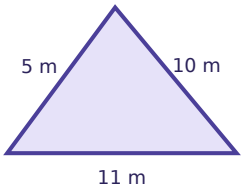

Task card 22 Perimeter of Polygons & Unknown Si...

A square has a perimeter of 28 inches. How long is each side in inches?

Task card 23 Perimeter of Polygons & Unknown Si...

Rectangle A is 4 cm by 3 cm. Rectangle B is 6 cm by 1 cm. Both have a perimeter of 14 centimeters. Which rectangle has the smaller area? Write A or B.

Task card 24 Perimeter of Polygons & Unknown Si...

The perimeter of the shape is 40 feet. How long is the side marked ?

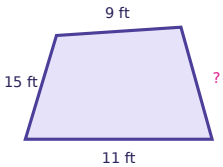

Perimeter of Polygons & Unknown Sides Task Cards

Recording sheet · Grade 3 · Solve each problem. Shapes are not drawn to scale.

Scan to check your answers

Name: _____ Date: _____

1	2	3	4
5	6	7	8
9	10	11	12
13	14	15	16
17	18	19	20
21	22	23	24

Perimeter of Polygons & Unknown Sides Task Cards: Answer Key

Grade 3 · Medium

The answers online

1. 47	**2.** 9	**3.** 5
4. 10	**5.** 3	**6.** 28
7. 9	**8.** 6	**9.** 3
10. 7	**11.** B	**12.** 8
13. 54	**14.** 2	**15.** B
16. 4	**17.** 17	**18.** 6
19. B	**20.** 9	**21.** 26
22. 7	**23.** B	**24.** 5