Task card 1 Perimeter of Polygons & Unknown Si...

What is the perimeter of the shape in centimeters?

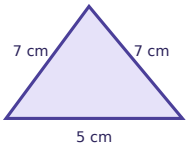

Task card 2 Perimeter of Polygons & Unknown Si...

What is the perimeter of the shape in centimeters?

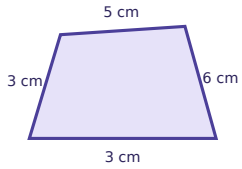

Task card 3 Perimeter of Polygons & Unknown Si...

The perimeter of the shape is 8 meters. How long is the side marked ?

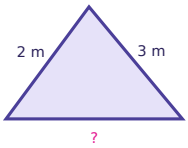

Task card 4 Perimeter of Polygons & Unknown Si...

What is the perimeter of the shape in feet?

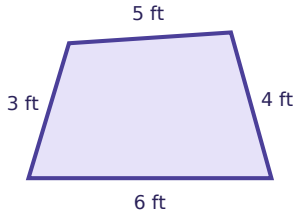

Task card 5 Perimeter of Polygons & Unknown Si...

The rectangle has a perimeter of 16 centimeters. How long is the side marked ?



Task card 6 Perimeter of Polygons & Unknown Si...

What is the perimeter of the shape in centimeters?

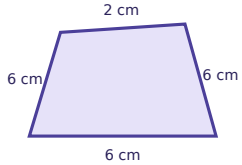

Task card 7 Perimeter of Polygons & Unknown Si...

The perimeter of the shape is 17 inches. How long is the side marked ?

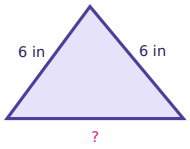

Task card 8 Perimeter of Polygons & Unknown Si...

A square has a perimeter of 8 feet. How long is each side in feet?

Task card 9 Perimeter of Polygons & Unknown Si...

What is the perimeter of the shape in inches?

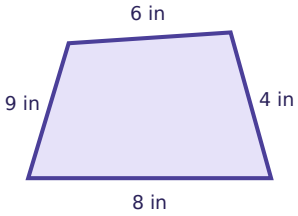

Task card 10 Perimeter of Polygons & Unknown Si...

What is the perimeter of the shape in meters?

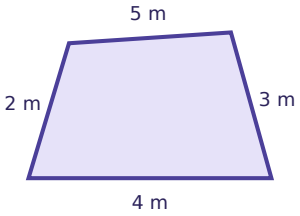

Task card 11 Perimeter of Polygons & Unknown Si...

The perimeter of the shape is 11 centimeters. How long is the side marked ?

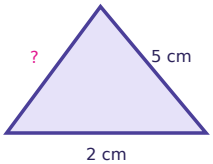

Task card 12 Perimeter of Polygons & Unknown Si...

What is the perimeter of the shape in feet?

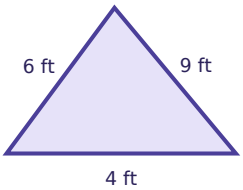

Task card 13 Perimeter of Polygons & Unknown Si...

The rectangle has a perimeter of 22 inches. How long is the side marked ?

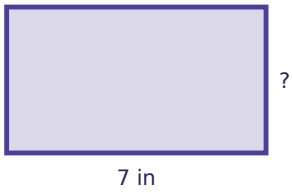

Task card 14 Perimeter of Polygons & Unknown Si...

What is the perimeter of the shape in centimeters?

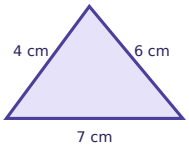

Task card 15 Perimeter of Polygons & Unknown Si...

The perimeter of the shape is 23 inches. How long is the side marked ?

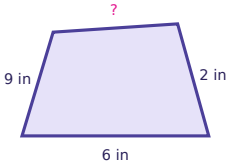

Task card 16 Perimeter of Polygons & Unknown Si...

A square has a perimeter of 12 inches. How long is each side in inches?

Task card 17 Perimeter of Polygons & Unknown Si...

What is the perimeter of the shape in feet?

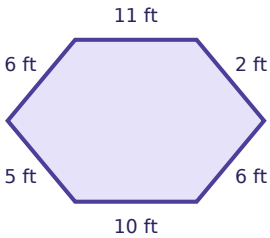

Task card 18 Perimeter of Polygons & Unknown Si...

The perimeter of the shape is 34 centimeters. How long is the side marked ?

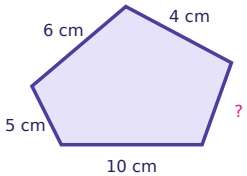

Task card 19 Perimeter of Polygons & Unknown Si...

The rectangle has a perimeter of 10 inches. How long is the side marked ?

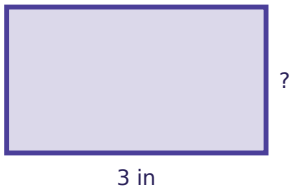

Task card 20 Perimeter of Polygons & Unknown Si...

The perimeter of the shape is 23 feet. How long is the side marked ?

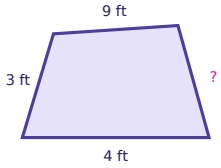

Task card 21 Perimeter of Polygons & Unknown Si...

A square has a perimeter of 24 meters. How long is each side in meters?

Task card 22 Perimeter of Polygons & Unknown Si...

What is the perimeter of the shape in meters?

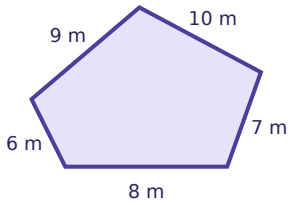

Task card 23 Perimeter of Polygons & Unknown Si...

The perimeter of the shape is 47 meters. How long is the side marked ?

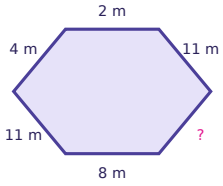

Task card 24 Perimeter of Polygons & Unknown Si...

The rectangle has a perimeter of 14 meters. How long is the side marked ?

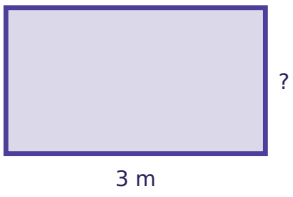

Perimeter of Polygons & Unknown Sides Task Cards

Recording sheet · Grade 3 · Solve each problem. Shapes are not drawn to scale.

Scan to check your answers

Name: _____ Date: _____

1	2	3	4
5	6	7	8
9	10	11	12
13	14	15	16
17	18	19	20
21	22	23	24

Perimeter of Polygons & Unknown Sides Task Cards: Answer Key

Grade 3 · Easy

The answers online

1. 19	**2.** 17	**3.** 3
4. 18	**5.** 3	**6.** 20
7. 5	**8.** 2	**9.** 27
10. 14	**11.** 4	**12.** 19
13. 4	**14.** 17	**15.** 6
16. 3	**17.** 40	**18.** 9
19. 2	**20.** 7	**21.** 6
22. 40	**23.** 11	**24.** 4