Perimeter of Polygons & Unknown Sides · 1

What is the perimeter of the shape in meters?

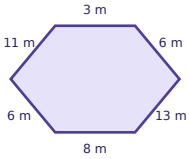

Perimeter of Polygons & Unknown Sides · 2

The perimeter of the shape is 39 feet. How long is the side marked ?

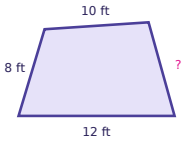

Perimeter of Polygons & Unknown Sides · 3

The rectangle has a perimeter of 18 meters. How long is the side marked ?

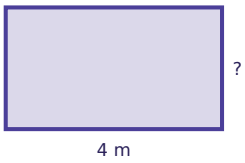

Perimeter of Polygons & Unknown Sides · 4

The perimeter of the shape is 25 inches. How long is the side marked ?

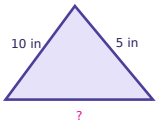

Perimeter of Polygons & Unknown Sides · 5

A square has a perimeter of 12 centimeters. How long is each side in centimeters?

Perimeter of Polygons & Unknown Sides · 6

What is the perimeter of the shape in feet?

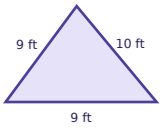

Perimeter of Polygons & Unknown Sides · 7

The perimeter of the shape is 43 feet. How long is the side marked ?

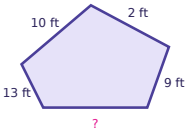

Perimeter of Polygons & Unknown Sides · 8

The rectangle has a perimeter of 26 centimeters. How long is the side marked ?

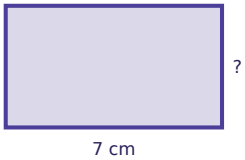

Perimeter of Polygons & Unknown Sides · 2

ANSWER

9

Perimeter of Polygons & Unknown Sides · 1

ANSWER

47

Perimeter of Polygons & Unknown Sides · 4

ANSWER

10

Perimeter of Polygons & Unknown Sides · 3

ANSWER

5

Perimeter of Polygons & Unknown Sides · 6

ANSWER

28

Perimeter of Polygons & Unknown Sides · 5

ANSWER

3

Perimeter of Polygons & Unknown Sides · 8

ANSWER

6

Perimeter of Polygons & Unknown Sides · 7

ANSWER

9

Perimeter of Polygons & Unknown Sides · 9

The perimeter of the shape is 34 inches. How long is the side marked ?

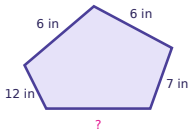

Perimeter of Polygons & Unknown Sides · 10

The rectangle has a perimeter of 34 feet. How long is the side marked ?

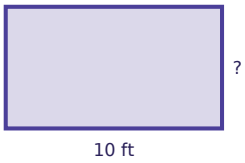

Perimeter of Polygons & Unknown Sides · 11

Rectangle A is 5 in by 2 in. Rectangle B is 6 in by 1 in. Both have a perimeter of 14 inches. Which rectangle has the smaller area? Write A or B.

Perimeter of Polygons & Unknown Sides · 12

The perimeter of the shape is 29 centimeters. How long is the side marked ?

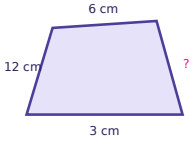

Perimeter of Polygons & Unknown Sides · 13

What is the perimeter of the shape in centimeters?

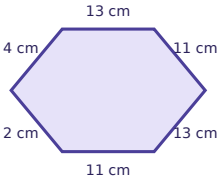

Perimeter of Polygons & Unknown Sides · 14

A square has a perimeter of 8 meters. How long is each side in meters?

Perimeter of Polygons & Unknown Sides · 15

Rectangle A is 11 ft by 1 ft. Rectangle B is 8 ft by 4 ft. Both have a perimeter of 24 feet. Which rectangle has the greater area? Write A or B.

Perimeter of Polygons & Unknown Sides · 16

The perimeter of the shape is 44 centimeters. How long is the side marked ?

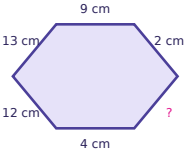

Perimeter of Polygons & Unknown Sides · 10

ANSWER

7

Perimeter of Polygons & Unknown Sides · 9

ANSWER

3

Perimeter of Polygons & Unknown Sides · 12

ANSWER

8

Perimeter of Polygons & Unknown Sides · 11

ANSWER

B

Perimeter of Polygons & Unknown Sides · 14

ANSWER

2

Perimeter of Polygons & Unknown Sides · 13

ANSWER

54

Perimeter of Polygons & Unknown Sides · 16

ANSWER

4

Perimeter of Polygons & Unknown Sides · 15

ANSWER

B

Perimeter of Polygons & Unknown Sides · 17

The perimeter of the shape is 66 inches. How long is the side marked ?

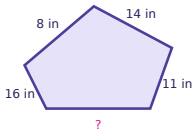

Perimeter of Polygons & Unknown Sides · 18

The rectangle has a perimeter of 20 feet. How long is the side marked ?

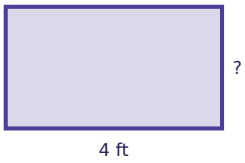

Perimeter of Polygons & Unknown Sides · 19

Rectangle A is 5 cm by 2 cm. Rectangle B is 6 cm by 1 cm. Both have a perimeter of 14 centimeters. Which rectangle has the smaller area? Write A or B.

Perimeter of Polygons & Unknown Sides · 20

The perimeter of the shape is 48 centimeters. How long is the side marked ?

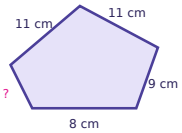

Perimeter of Polygons & Unknown Sides · 21

What is the perimeter of the shape in meters?

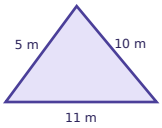

Perimeter of Polygons & Unknown Sides · 22

A square has a perimeter of 28 inches. How long is each side in inches?

Perimeter of Polygons & Unknown Sides · 23

Rectangle A is 4 cm by 3 cm. Rectangle B is 6 cm by 1 cm. Both have a perimeter of 14 centimeters. Which rectangle has the smaller area? Write A or B.

Perimeter of Polygons & Unknown Sides · 24

The perimeter of the shape is 40 feet. How long is the side marked ?

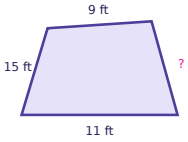

Perimeter of Polygons & Unknown Sides · 18

ANSWER

6

Perimeter of Polygons & Unknown Sides · 17

ANSWER

17

Perimeter of Polygons & Unknown Sides · 20

ANSWER

9

Perimeter of Polygons & Unknown Sides · 19

ANSWER

B

Perimeter of Polygons & Unknown Sides · 22

ANSWER

7

Perimeter of Polygons & Unknown Sides · 21

ANSWER

26

Perimeter of Polygons & Unknown Sides · 24

ANSWER

5

Perimeter of Polygons & Unknown Sides · 23

ANSWER

B