Perimeter of Polygons & Unknown Sides · 1

The perimeter of the shape is 46 feet. How long is the side marked ?

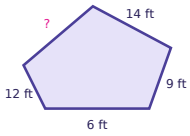

Perimeter of Polygons & Unknown Sides · 2

The rectangle has a perimeter of 34 centimeters. How long is the side marked ?

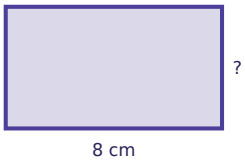

Perimeter of Polygons & Unknown Sides · 3

Rectangle A is 7 m by 4 m. Rectangle B is 10 m by 1 m. Both have a perimeter of 22 meters. Which rectangle has the smaller area? Write A or B.

Perimeter of Polygons & Unknown Sides · 4

The perimeter of the shape is 61 meters. How long is the side marked ?

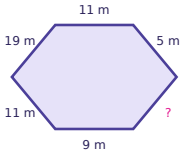

Perimeter of Polygons & Unknown Sides · 5

What is the perimeter of the shape in feet?

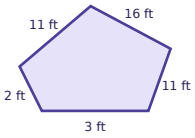

Perimeter of Polygons & Unknown Sides · 6

A square has a perimeter of 12 centimeters. How long is each side in centimeters?

Perimeter of Polygons & Unknown Sides · 7

Rectangle A is 5 cm by 4 cm. Rectangle B is 7 cm by 2 cm. Both have a perimeter of 18 centimeters. Which rectangle has the smaller area? Write A or B.

Perimeter of Polygons & Unknown Sides · 8

The perimeter of the shape is 33 feet. How long is the side marked ?

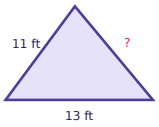

Perimeter of Polygons & Unknown Sides · 2

ANSWER

9

Perimeter of Polygons & Unknown Sides · 1

ANSWER

5

Perimeter of Polygons & Unknown Sides · 4

ANSWER

6

Perimeter of Polygons & Unknown Sides · 3

ANSWER

B

Perimeter of Polygons & Unknown Sides · 6

ANSWER

3

Perimeter of Polygons & Unknown Sides · 5

ANSWER

43

Perimeter of Polygons & Unknown Sides · 8

ANSWER

9

Perimeter of Polygons & Unknown Sides · 7

ANSWER

B

Perimeter of Polygons & Unknown Sides · 9

The perimeter of the shape is 55 centimeters. How long is the side marked ?

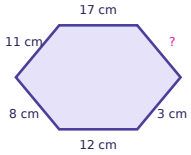

Perimeter of Polygons & Unknown Sides · 10

The rectangle has a perimeter of 26 feet. How long is the side marked ?

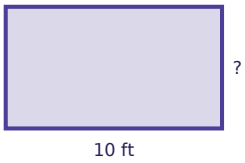

Perimeter of Polygons & Unknown Sides · 11

Rectangle A is 3 cm by 3 cm. Rectangle B is 5 cm by 1 cm. Both have a perimeter of 12 centimeters. Which rectangle has the smaller area? Write A or B.

Perimeter of Polygons & Unknown Sides · 12

The perimeter of the shape is 58 feet. How long is the side marked ?

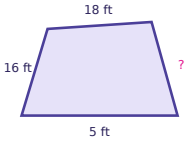

Perimeter of Polygons & Unknown Sides · 13

What is the perimeter of the shape in meters?

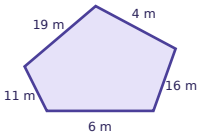

Perimeter of Polygons & Unknown Sides · 14

A square has a perimeter of 8 inches. How long is each side in inches?

Perimeter of Polygons & Unknown Sides · 15

Rectangle A is 6 m by 6 m. Rectangle B is 10 m by 2 m. Both have a perimeter of 24 meters. Which rectangle has the greater area? Write A or B.

Perimeter of Polygons & Unknown Sides · 16

The perimeter of the shape is 79 centimeters. How long is the side marked ?

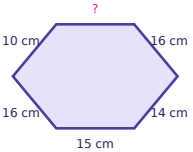

Perimeter of Polygons & Unknown Sides · 10

ANSWER

3

Perimeter of Polygons & Unknown Sides · 9

ANSWER

4

Perimeter of Polygons & Unknown Sides · 12

ANSWER

19

Perimeter of Polygons & Unknown Sides · 11

ANSWER

B

Perimeter of Polygons & Unknown Sides · 14

ANSWER

2

Perimeter of Polygons & Unknown Sides · 13

ANSWER

56

Perimeter of Polygons & Unknown Sides · 16

ANSWER

8

Perimeter of Polygons & Unknown Sides · 15

ANSWER

A

Perimeter of Polygons & Unknown Sides · 17

The perimeter of the shape is 32 centimeters. How long is the side marked ?

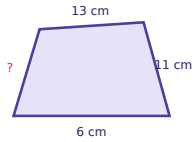

Perimeter of Polygons & Unknown Sides · 18

The rectangle has a perimeter of 22 centimeters. How long is the side marked ?

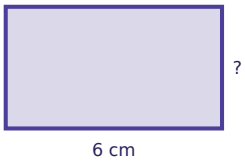

Perimeter of Polygons & Unknown Sides · 19

Rectangle A is 11 in by 1 in. Rectangle B is 7 in by 5 in. Both have a perimeter of 24 inches. Which rectangle has the greater area? Write A or B.

Perimeter of Polygons & Unknown Sides · 20

The perimeter of the shape is 41 inches. How long is the side marked ?

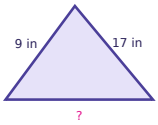

Perimeter of Polygons & Unknown Sides · 21

What is the perimeter of the shape in inches?

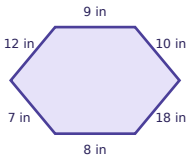

Perimeter of Polygons & Unknown Sides · 22

A square has a perimeter of 20 meters. How long is each side in meters?

Perimeter of Polygons & Unknown Sides · 23

Rectangle A is 7 in by 1 in. Rectangle B is 5 in by 3 in. Both have a perimeter of 16 inches. Which rectangle has the smaller area? Write A or B.

Perimeter of Polygons & Unknown Sides · 24

The perimeter of the shape is 54 meters. How long is the side marked ?

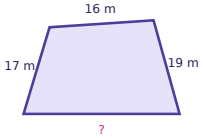

Perimeter of Polygons & Unknown Sides · 18

ANSWER

5

Perimeter of Polygons & Unknown Sides · 17

ANSWER

2

Perimeter of Polygons & Unknown Sides · 20

ANSWER

15

Perimeter of Polygons & Unknown Sides · 19

ANSWER

B

Perimeter of Polygons & Unknown Sides · 22

ANSWER

5

Perimeter of Polygons & Unknown Sides · 21

ANSWER

64

Perimeter of Polygons & Unknown Sides · 24

ANSWER

2

Perimeter of Polygons & Unknown Sides · 23

ANSWER

A