Perimeter of Polygons & Unknown Sides · 1

What is the perimeter of the shape in centimeters?

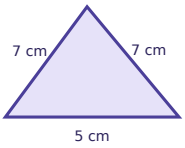

Perimeter of Polygons & Unknown Sides · 2

What is the perimeter of the shape in centimeters?

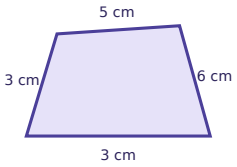

Perimeter of Polygons & Unknown Sides · 3

The perimeter of the shape is 8 meters. How long is the side marked ?

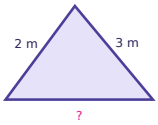

Perimeter of Polygons & Unknown Sides · 4

What is the perimeter of the shape in feet?

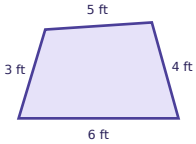

Perimeter of Polygons & Unknown Sides · 5

The rectangle has a perimeter of 16 centimeters. How long is the side marked ?

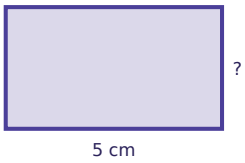

Perimeter of Polygons & Unknown Sides · 6

What is the perimeter of the shape in centimeters?

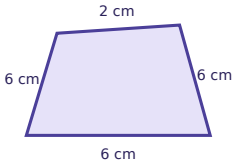

Perimeter of Polygons & Unknown Sides · 7

The perimeter of the shape is 17 inches. How long is the side marked ?

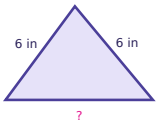

Perimeter of Polygons & Unknown Sides · 8

A square has a perimeter of 8 feet. How long is each side in feet?

Perimeter of Polygons & Unknown Sides · 2

ANSWER

17

Perimeter of Polygons & Unknown Sides · 1

ANSWER

19

Perimeter of Polygons & Unknown Sides · 4

ANSWER

18

Perimeter of Polygons & Unknown Sides · 3

ANSWER

3

Perimeter of Polygons & Unknown Sides · 6

ANSWER

20

Perimeter of Polygons & Unknown Sides · 5

ANSWER

3

Perimeter of Polygons & Unknown Sides · 8

ANSWER

2

Perimeter of Polygons & Unknown Sides · 7

ANSWER

5

Perimeter of Polygons & Unknown Sides · 9

What is the perimeter of the shape in inches?

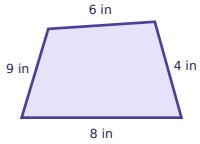

Perimeter of Polygons & Unknown Sides · 10

What is the perimeter of the shape in meters?

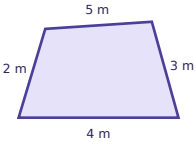

Perimeter of Polygons & Unknown Sides · 11

The perimeter of the shape is 11 centimeters. How long is the side marked ?

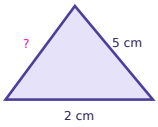

Perimeter of Polygons & Unknown Sides · 12

What is the perimeter of the shape in feet?

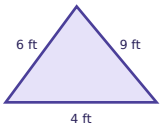

Perimeter of Polygons & Unknown Sides · 13

The rectangle has a perimeter of 22 inches. How long is the side marked ?

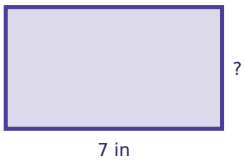

Perimeter of Polygons & Unknown Sides · 14

What is the perimeter of the shape in centimeters?

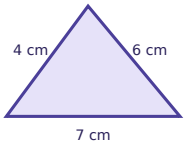

Perimeter of Polygons & Unknown Sides · 15

The perimeter of the shape is 23 inches. How long is the side marked ?

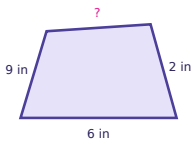

Perimeter of Polygons & Unknown Sides · 16

A square has a perimeter of 12 inches. How long is each side in inches?

Perimeter of Polygons & Unknown Sides · 10

ANSWER

14

Perimeter of Polygons & Unknown Sides · 9

ANSWER

27

Perimeter of Polygons & Unknown Sides · 12

ANSWER

19

Perimeter of Polygons & Unknown Sides · 11

ANSWER

4

Perimeter of Polygons & Unknown Sides · 14

ANSWER

17

Perimeter of Polygons & Unknown Sides · 13

ANSWER

4

Perimeter of Polygons & Unknown Sides · 16

ANSWER

3

Perimeter of Polygons & Unknown Sides · 15

ANSWER

6

What is the perimeter of the shape in feet?

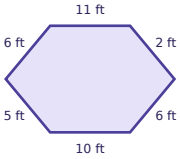

The perimeter of the shape is 34 centimeters. How long is the side marked ?

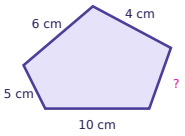

The rectangle has a perimeter of 10 inches. How long is the side marked ?

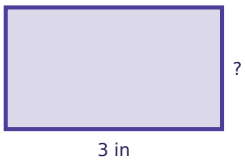

The perimeter of the shape is 23 feet. How long is the side marked ?

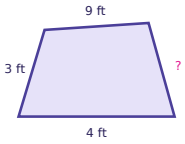

A square has a perimeter of 24 meters. How long is each side in meters?

What is the perimeter of the shape in meters?

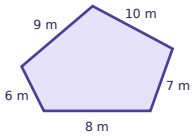

The perimeter of the shape is 47 meters. How long is the side marked ?

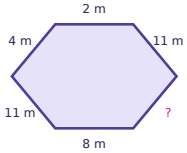

The rectangle has a perimeter of 14 meters. How long is the side marked ?

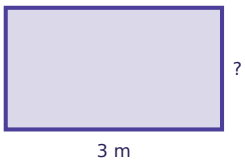

Perimeter of Polygons & Unknown Sides · 18

ANSWER

9

Perimeter of Polygons & Unknown Sides · 17

ANSWER

40

Perimeter of Polygons & Unknown Sides · 20

ANSWER

7

Perimeter of Polygons & Unknown Sides · 19

ANSWER

2

Perimeter of Polygons & Unknown Sides · 22

ANSWER

40

Perimeter of Polygons & Unknown Sides · 21

ANSWER

6

Perimeter of Polygons & Unknown Sides · 24

ANSWER

4

Perimeter of Polygons & Unknown Sides · 23

ANSWER

11