Partitioning Shapes into Equal Areas · 1

The shape is split into equal parts. What fraction of the whole area is the shaded part?



Partitioning Shapes into Equal Areas · 2

The shape is split into equal parts. What fraction of the whole area is shaded?

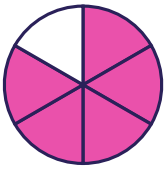

Partitioning Shapes into Equal Areas · 3

Is this rectangle split into equal parts? Write yes or no.



Partitioning Shapes into Equal Areas · 4

The whole rectangle has an area of 16 square units. It is split into equal parts. What is the area of one part in square units?



Partitioning Shapes into Equal Areas · 5

The shape is split into equal parts. What fraction of the whole area is the shaded part?



Partitioning Shapes into Equal Areas · 6

The shape is split into equal parts. What fraction of the whole area is shaded?

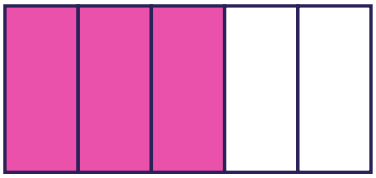

Partitioning Shapes into Equal Areas · 7

The whole rectangle has an area of 36 square units. It is split into equal parts. What is the area of one part in square units?



Partitioning Shapes into Equal Areas · 8

Is this rectangle split into equal parts? Write yes or no.



Partitioning Shapes into Equal Areas · 2

ANSWER

$\frac{5}{6}$

Partitioning Shapes into Equal Areas · 1

ANSWER

$\frac{1}{2}$

Partitioning Shapes into Equal Areas · 4

ANSWER

2

Partitioning Shapes into Equal Areas · 3

ANSWER

no

Partitioning Shapes into Equal Areas · 6

ANSWER

$\frac{3}{5}$

Partitioning Shapes into Equal Areas · 5

ANSWER

$\frac{1}{4}$

Partitioning Shapes into Equal Areas · 8

ANSWER

no

Partitioning Shapes into Equal Areas · 7

ANSWER

9

Partitioning Shapes into Equal Areas · 9

The shape is split into equal parts. What fraction of the whole area is the shaded part?



Partitioning Shapes into Equal Areas · 10

The shape is split into equal parts. What fraction of the whole area is shaded?

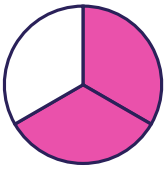

Partitioning Shapes into Equal Areas · 11

Is this rectangle split into equal parts? Write yes or no.



Partitioning Shapes into Equal Areas · 12

The whole rectangle has an area of 4 square units. It is split into equal parts. What is the area of one part in square units?



Partitioning Shapes into Equal Areas · 13

The shape is split into equal parts. What fraction of the whole area is the shaded part?



Partitioning Shapes into Equal Areas · 14

The whole rectangle has an area of 16 square units. It is split into equal parts. What is the area of one part in square units?

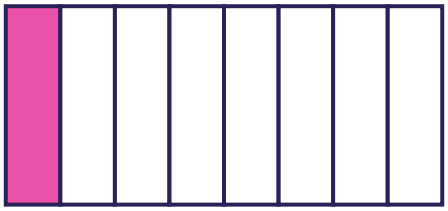

Partitioning Shapes into Equal Areas · 15

Is this rectangle split into equal parts? Write yes or no.



Partitioning Shapes into Equal Areas · 16

The shape is split into equal parts. What fraction of the whole area is the shaded part?

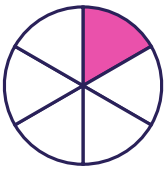

Partitioning Shapes into Equal Areas · 10

ANSWER

$\frac{2}{3}$

Partitioning Shapes into Equal Areas · 9

ANSWER

$\frac{1}{8}$

Partitioning Shapes into Equal Areas · 12

ANSWER

2

Partitioning Shapes into Equal Areas · 11

ANSWER

yes

Partitioning Shapes into Equal Areas · 14

ANSWER

2

Partitioning Shapes into Equal Areas · 13

ANSWER

$\frac{1}{4}$

Partitioning Shapes into Equal Areas · 16

ANSWER

$\frac{1}{6}$

Partitioning Shapes into Equal Areas · 15

ANSWER

yes

Partitioning Shapes into Equal Areas · 17

The shape is split into equal parts. What fraction of the whole area is shaded?

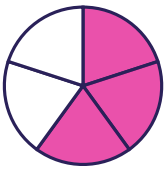

Partitioning Shapes into Equal Areas · 18

The whole rectangle has an area of 30 square units. It is split into equal parts. What is the area of one part in square units?



Partitioning Shapes into Equal Areas · 19

The shape is split into equal parts. What fraction of the whole area is the shaded part?

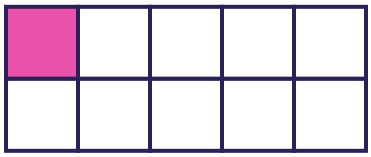

Partitioning Shapes into Equal Areas · 20

The shape is split into equal parts. What fraction of the whole area is shaded?



Partitioning Shapes into Equal Areas · 21

The whole rectangle has an area of 16 square units. It is split into equal parts. What is the area of one part in square units?



Partitioning Shapes into Equal Areas · 22

Is this rectangle split into equal parts? Write yes or no.



Partitioning Shapes into Equal Areas · 23

The shape is split into equal parts. What fraction of the whole area is the shaded part?



Partitioning Shapes into Equal Areas · 24

The shape is split into equal parts. What fraction of the whole area is shaded?



Partitioning Shapes into Equal Areas · 18

ANSWER

5

Partitioning Shapes into Equal Areas · 17

ANSWER

$\frac{3}{5}$

Partitioning Shapes into Equal Areas · 20

ANSWER

$\frac{2}{3}$

Partitioning Shapes into Equal Areas · 19

ANSWER

$\frac{1}{10}$

Partitioning Shapes into Equal Areas · 22

ANSWER

no

Partitioning Shapes into Equal Areas · 21

ANSWER

8

Partitioning Shapes into Equal Areas · 24

ANSWER

$\frac{3}{4}$

Partitioning Shapes into Equal Areas · 23

ANSWER

$\frac{1}{7}$