Task card 1 Naming Fractions of Shapes

What fraction of the circle is shaded?



Task card 2 Naming Fractions of Shapes

What fraction of the rectangle is shaded?



Task card 3 Naming Fractions of Shapes

What fraction of the rectangle is shaded?



Task card 4 Naming Fractions of Shapes

What fraction of the bar is shaded?



Task card 5 Naming Fractions of Shapes

What fraction of the rectangle is shaded?



Task card 6 Naming Fractions of Shapes

What fraction of the bar is shaded?



Task card 7 Naming Fractions of Shapes

What fraction of the bar is shaded?



Task card 8 Naming Fractions of Shapes

What fraction of the circle is shaded?

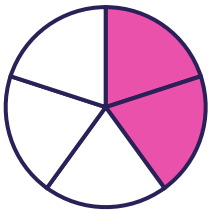

Task card 9 Naming Fractions of Shapes

What fraction of the bar is shaded?



Task card 10 Naming Fractions of Shapes

What fraction of the rectangle is shaded?



Task card 11 Naming Fractions of Shapes

What fraction of the rectangle is shaded?



Task card 12 Naming Fractions of Shapes

What fraction of the circle is shaded?



Task card 13 Naming Fractions of Shapes

What fraction of the circle is shaded?



Task card 14 Naming Fractions of Shapes

What fraction of the bar is shaded?



Task card 15 Naming Fractions of Shapes

What fraction of the bar is shaded?



Task card 16 Naming Fractions of Shapes

What fraction of the circle is shaded?



Task card 17 Naming Fractions of Shapes

What fraction of the bar is shaded?



Task card 18 Naming Fractions of Shapes

What fraction of the rectangle is NOT shaded?



Task card 19 Naming Fractions of Shapes

What fraction of the bar is shaded?



Task card 20 Naming Fractions of Shapes

What fraction of the circle is NOT shaded?

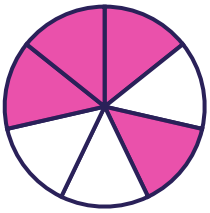

Task card 21 Naming Fractions of Shapes

What fraction of the rectangle is shaded?



Task card 22 Naming Fractions of Shapes

What fraction of the bar is NOT shaded?



Task card 23 Naming Fractions of Shapes

What fraction of the circle is shaded?



Task card 24 Naming Fractions of Shapes

What fraction of the circle is NOT shaded?

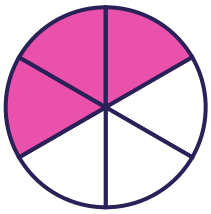

Naming Fractions of Shapes Task Cards

Recording sheet · Grade 3 · Write the fraction for each picture. Count the parts; do not simplify.

Name: _____ Date: _____

Scan to check your answers

1	2	3	4
5	6	7	8
9	10	11	12
13	14	15	16
17	18	19	20
21	22	23	24

Naming Fractions of Shapes Task Cards: Answer Key

Grade 3 · Medium

The answers online

1. $\frac{3}{8}$	**2.** $\frac{7}{8}$	**3.** $\frac{1}{8}$
4. $\frac{1}{3}$	**5.** $\frac{2}{4}$	**6.** $\frac{1}{4}$
7. $\frac{3}{5}$	**8.** $\frac{2}{5}$	**9.** $\frac{1}{4}$
10. $\frac{5}{8}$	**11.** $\frac{1}{4}$	**12.** $\frac{3}{7}$
13. $\frac{3}{4}$	**14.** $\frac{2}{4}$	**15.** $\frac{2}{8}$
16. $\frac{1}{4}$	**17.** $\frac{3}{6}$	**18.** $\frac{2}{8}$
19. $\frac{1}{3}$	**20.** $\frac{3}{7}$	**21.** $\frac{5}{8}$
22. $\frac{3}{6}$	**23.** $\frac{4}{5}$	**24.** $\frac{3}{6}$