Naming Fractions of Shapes · 1

What fraction of the bar is shaded?



Naming Fractions of Shapes · 2

What fraction of the circle is shaded?

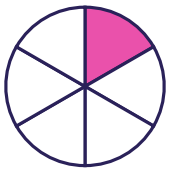

Naming Fractions of Shapes · 3

What fraction of the bar is shaded?



Naming Fractions of Shapes · 4

What fraction of the bar is shaded?



Naming Fractions of Shapes · 5

What fraction of the bar is shaded?



Naming Fractions of Shapes · 6

What fraction of the circle is shaded?

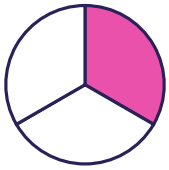

Naming Fractions of Shapes · 7

What fraction of the circle is shaded?



Naming Fractions of Shapes · 8

What fraction of the bar is shaded?



Naming Fractions of Shapes · 2

ANSWER

$\frac{1}{6}$

Naming Fractions of Shapes · 1

ANSWER

$\frac{1}{4}$

Naming Fractions of Shapes · 4

ANSWER

$\frac{1}{3}$

Naming Fractions of Shapes · 3

ANSWER

$\frac{1}{2}$

Naming Fractions of Shapes · 6

ANSWER

$\frac{1}{3}$

Naming Fractions of Shapes · 5

ANSWER

$\frac{1}{5}$

Naming Fractions of Shapes · 8

ANSWER

$\frac{1}{6}$

Naming Fractions of Shapes · 7

ANSWER

$\frac{1}{4}$

Naming Fractions of Shapes · 9

What fraction of the circle is shaded?



Naming Fractions of Shapes · 10

What fraction of the circle is shaded?

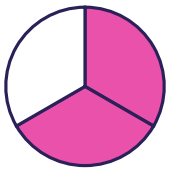

Naming Fractions of Shapes · 11

What fraction of the bar is shaded?



Naming Fractions of Shapes · 12

What fraction of the bar is shaded?



Naming Fractions of Shapes · 13

What fraction of the circle is shaded?

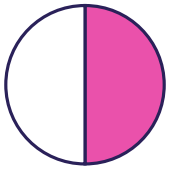

Naming Fractions of Shapes · 14

What fraction of the bar is shaded?



Naming Fractions of Shapes · 15

What fraction of the circle is shaded?

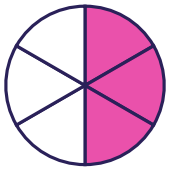

Naming Fractions of Shapes · 16

What fraction of the bar is shaded?



Naming Fractions of Shapes · 10

ANSWER

$\frac{2}{3}$

Naming Fractions of Shapes · 9

ANSWER

$\frac{3}{4}$

Naming Fractions of Shapes · 12

ANSWER

$\frac{2}{4}$

Naming Fractions of Shapes · 11

ANSWER

$\frac{3}{4}$

Naming Fractions of Shapes · 14

ANSWER

$\frac{2}{3}$

Naming Fractions of Shapes · 13

ANSWER

$\frac{1}{2}$

Naming Fractions of Shapes · 16

ANSWER

$\frac{5}{6}$

Naming Fractions of Shapes · 15

ANSWER

$\frac{3}{6}$

Naming Fractions of Shapes · 17

What fraction of the circle is shaded?

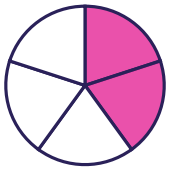

Naming Fractions of Shapes · 18

What fraction of the rectangle is shaded?



Naming Fractions of Shapes · 19

What fraction of the circle is shaded?

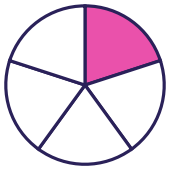

Naming Fractions of Shapes · 20

What fraction of the rectangle is shaded?



Naming Fractions of Shapes · 21

What fraction of the rectangle is shaded?



Naming Fractions of Shapes · 22

What fraction of the circle is shaded?

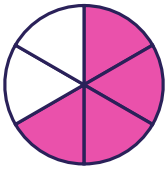

Naming Fractions of Shapes · 23

What fraction of the bar is shaded?



Naming Fractions of Shapes · 24

What fraction of the circle is shaded?



Naming Fractions of Shapes · 18

ANSWER

$\frac{5}{6}$

Naming Fractions of Shapes · 17

ANSWER

$\frac{2}{5}$

Naming Fractions of Shapes · 20

ANSWER

$\frac{4}{6}$

Naming Fractions of Shapes · 19

ANSWER

$\frac{1}{5}$

Naming Fractions of Shapes · 22

ANSWER

$\frac{4}{6}$

Naming Fractions of Shapes · 21

ANSWER

$\frac{3}{4}$

Naming Fractions of Shapes · 24

ANSWER

$\frac{2}{4}$

Naming Fractions of Shapes · 23

ANSWER

$\frac{4}{6}$