Task card 1 Multiplication: Equal Groups & Arr...

There are 9 equal groups of dots. How many dots are there in all?



Task card 2 Multiplication: Equal Groups & Arr...

Count the rows and how many stars are in each row. How many stars are in the array?



Task card 3 Multiplication: Equal Groups & Arr...

Write 8 + 8 + 8 + 8 + 8 + 8 + 8 as a multiplication. What is the product?

Task card 4 Multiplication: Equal Groups & Arr...

There are 9 vases with 10 flowers in each. How many flowers are there in all?

Task card 5 Multiplication: Equal Groups & Arr...

There are 8 equal groups of dots. How many dots are there in all?



Task card 6 Multiplication: Equal Groups & Arr...

Count the rows and how many stars are in each row. How many stars are in the array?



Task card 7 Multiplication: Equal Groups & Arr...

Write 2 + 2 + 2 + 2 + 2 + 2 as a multiplication. What is the product?

Task card 8 Multiplication: Equal Groups & Arr...

There are 8 rows of chairs with 8 chairs in each row. How many chairs are there?

Task card 9 Multiplication: Equal Groups & Arr...

There are 3 equal groups of dots. How many dots are there in all?



Task card 10 Multiplication: Equal Groups & Arr...

Count the rows and how many stars are in each row. How many stars are in the array?



Task card 11 Multiplication: Equal Groups & Arr...

Write 6 + 6 + 6 + 6 + 6 + 6 + 6 as a multiplication. What is the product?

Task card 12 Multiplication: Equal Groups & Arr...

There are 9 rows of plants with 5 plants in each row. How many plants are there?

Task card 13 Multiplication: Equal Groups & Arr...

There are 2 equal groups of dots. How many dots are there in all?

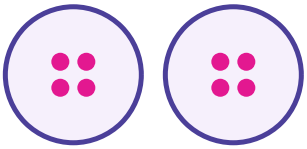

Task card 14 Multiplication: Equal Groups & Arr...

Count the rows and how many stars are in each row. How many stars are in the array?



Task card 15 Multiplication: Equal Groups & Arr...

Write 8 + 8 + 8 + 8 as a multiplication. What is the product?

Task card 16 Multiplication: Equal Groups & Arr...

There are 2 rows of desks with 2 desks in each row. How many desks are there?

Task card 17 Multiplication: Equal Groups & Arr...

There are 4 equal groups of dots. How many dots are there in all?

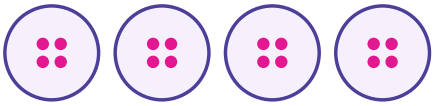

Task card 18 Multiplication: Equal Groups & Arr...

Count the rows and how many stars are in each row. How many stars are in the array?



Task card 19 Multiplication: Equal Groups & Arr...

Write 9 + 9 + 9 + 9 + 9 + 9 as a multiplication. What is the product?

Task card 20 Multiplication: Equal Groups & Arr...

There are 5 rows of desks with 6 desks in each row. How many desks are there?

Task card 21 Multiplication: Equal Groups & Arr...

There are 9 equal groups of dots. How many dots are there in all?



Task card 22 Multiplication: Equal Groups & Arr...

Count the rows and how many stars are in each row. How many stars are in the array?



Task card 23 Multiplication: Equal Groups & Arr...

Write 10 + 10 + 10 + 10 + 10 as a multiplication. What is the product?

Task card 24 Multiplication: Equal Groups & Arr...

There are 3 rows of plants with 2 plants in each row. How many plants are there?

Multiplication: Equal Groups & Arrays Task Cards

Recording sheet · Grade 3 · Use the groups or the array to find how many in all.

Name: _____ Date: _____

Scan to check your answers

1	2	3	4
5	6	7	8
9	10	11	12
13	14	15	16
17	18	19	20
21	22	23	24

Multiplication: Equal Groups & Arrays Task Cards: Answer Key

Grade 3 · Hard

The answers online

1. 81	**2.** 12	**3.** 56
4. 90	**5.** 48	**6.** 27
7. 12	**8.** 64	**9.** 27
10. 20	**11.** 42	**12.** 45
13. 8	**14.** 10	**15.** 32
16. 4	**17.** 16	**18.** 8
19. 54	**20.** 30	**21.** 72
22. 15	**23.** 50	**24.** 6