Multiplication: Equal Groups & Arrays · 1

There are 5 equal groups of dots. How many dots are there in all?



Multiplication: Equal Groups & Arrays · 2

Count the rows and how many stars are in each row. How many stars are in the array?



Multiplication: Equal Groups & Arrays · 3

Write 6 + 6 + 6 + 6 + 6 + 6 + 6 as a multiplication. What is the product?

Multiplication: Equal Groups & Arrays · 4

There are 4 bags with 2 marbles in each. How many marbles are there in all?

Multiplication: Equal Groups & Arrays · 5

There are 2 equal groups of dots. How many dots are there in all?

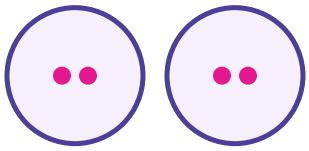

Multiplication: Equal Groups & Arrays · 6

Count the rows and how many stars are in each row. How many stars are in the array?



Multiplication: Equal Groups & Arrays · 7

Write 3 + 3 as a multiplication. What is the product?

Multiplication: Equal Groups & Arrays · 8

There are 3 boxes with 6 crayons in each. How many crayons are there in all?

Multiplication: Equal Groups & Arrays · 2

ANSWER

42

Multiplication: Equal Groups & Arrays · 1

ANSWER

35

Multiplication: Equal Groups & Arrays · 4

ANSWER

8

Multiplication: Equal Groups & Arrays · 3

ANSWER

42

Multiplication: Equal Groups & Arrays · 6

ANSWER

18

Multiplication: Equal Groups & Arrays · 5

ANSWER

4

Multiplication: Equal Groups & Arrays · 8

ANSWER

18

Multiplication: Equal Groups & Arrays · 7

ANSWER

6

Multiplication: Equal Groups & Arrays · 9

There are 4 equal groups of dots. How many dots are there in all?

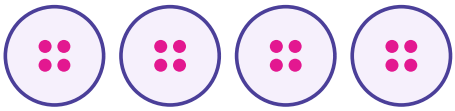

Multiplication: Equal Groups & Arrays · 10

Write 4 + 4 + 4 + 4 + 4 + 4 as a multiplication. What is the product?

Multiplication: Equal Groups & Arrays · 11

There are 8 boxes with 3 crayons in each. How many crayons are there in all?

Multiplication: Equal Groups & Arrays · 12

There are 2 equal groups of dots. How many dots are there in all?

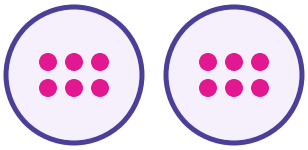

Multiplication: Equal Groups & Arrays · 13

Count the rows and how many stars are in each row. How many stars are in the array?



Multiplication: Equal Groups & Arrays · 14

Write 8 + 8 + 8 + 8 + 8 + 8 + 8 as a multiplication. What is the product?

Multiplication: Equal Groups & Arrays · 15

There are 7 rows of desks with 6 desks in each row. How many desks are there?

Multiplication: Equal Groups & Arrays · 16

There are 6 equal groups of dots. How many dots are there in all?



Multiplication: Equal Groups & Arrays · 10

ANSWER

24

Multiplication: Equal Groups & Arrays · 9

ANSWER

16

Multiplication: Equal Groups & Arrays · 12

ANSWER

12

Multiplication: Equal Groups & Arrays · 11

ANSWER

24

Multiplication: Equal Groups & Arrays · 14

ANSWER

56

Multiplication: Equal Groups & Arrays · 13

ANSWER

4

Multiplication: Equal Groups & Arrays · 16

ANSWER

18

Multiplication: Equal Groups & Arrays · 15

ANSWER

42

Multiplication: Equal Groups & Arrays · 17

Write 4 + 4 + 4 + 4 + 4 + 4 + 4 + 4 as a multiplication. What is the product?

Multiplication: Equal Groups & Arrays · 18

There are 8 boxes with 4 crayons in each. How many crayons are there in all?

Multiplication: Equal Groups & Arrays · 19

There are 6 equal groups of dots. How many dots are there in all?

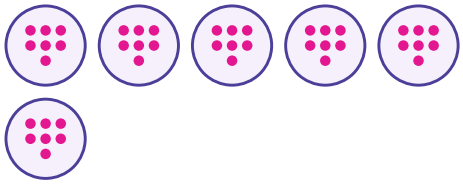

Multiplication: Equal Groups & Arrays · 20

Write 3 + 3 + 3 + 3 + 3 + 3 + 3 as a multiplication. What is the product?

Multiplication: Equal Groups & Arrays · 21

There are 4 bags with 8 marbles in each. How many marbles are there in all?

Multiplication: Equal Groups & Arrays · 22

There are 4 equal groups of dots. How many dots are there in all?

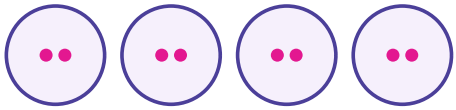

Multiplication: Equal Groups & Arrays · 23

Count the rows and how many stars are in each row. How many stars are in the array?



Multiplication: Equal Groups & Arrays · 24

Write 4 + 4 as a multiplication. What is the product?

Multiplication: Equal Groups & Arrays · 18

ANSWER

32

Multiplication: Equal Groups & Arrays · 17

ANSWER

32

Multiplication: Equal Groups & Arrays · 20

ANSWER

21

Multiplication: Equal Groups & Arrays · 19

ANSWER

42

Multiplication: Equal Groups & Arrays · 22

ANSWER

8

Multiplication: Equal Groups & Arrays · 21

ANSWER

32

Multiplication: Equal Groups & Arrays · 24

ANSWER

8

Multiplication: Equal Groups & Arrays · 23

ANSWER

14