Multiplication: Equal Groups & Arrays · 1

There are 9 equal groups of dots. How many dots are there in all?



Multiplication: Equal Groups & Arrays · 2

Count the rows and how many stars are in each row. How many stars are in the array?



Multiplication: Equal Groups & Arrays · 3

Write 8 + 8 + 8 + 8 + 8 + 8 + 8 as a multiplication. What is the product?

Multiplication: Equal Groups & Arrays · 4

There are 9 vases with 10 flowers in each. How many flowers are there in all?

Multiplication: Equal Groups & Arrays · 5

There are 8 equal groups of dots. How many dots are there in all?



Multiplication: Equal Groups & Arrays · 6

Count the rows and how many stars are in each row. How many stars are in the array?



Multiplication: Equal Groups & Arrays · 7

Write 2 + 2 + 2 + 2 + 2 + 2 as a multiplication. What is the product?

Multiplication: Equal Groups & Arrays · 8

There are 8 rows of chairs with 8 chairs in each row. How many chairs are there?

Multiplication: Equal Groups & Arrays · 2

ANSWER

12

Multiplication: Equal Groups & Arrays · 1

ANSWER

81

Multiplication: Equal Groups & Arrays · 4

ANSWER

90

Multiplication: Equal Groups & Arrays · 3

ANSWER

56

Multiplication: Equal Groups & Arrays · 6

ANSWER

27

Multiplication: Equal Groups & Arrays · 5

ANSWER

48

Multiplication: Equal Groups & Arrays · 8

ANSWER

64

Multiplication: Equal Groups & Arrays · 7

ANSWER

12

Multiplication: Equal Groups & Arrays · 9

There are 3 equal groups of dots. How many dots are there in all?



Multiplication: Equal Groups & Arrays · 10

Count the rows and how many stars are in each row. How many stars are in the array?



Multiplication: Equal Groups & Arrays · 11

Write 6 + 6 + 6 + 6 + 6 + 6 + 6 as a multiplication. What is the product?

Multiplication: Equal Groups & Arrays · 12

There are 9 rows of plants with 5 plants in each row. How many plants are there?

Multiplication: Equal Groups & Arrays · 13

There are 2 equal groups of dots. How many dots are there in all?

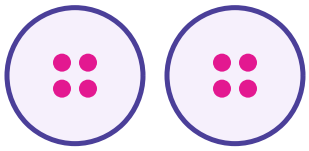

Multiplication: Equal Groups & Arrays · 14

Count the rows and how many stars are in each row. How many stars are in the array?



Multiplication: Equal Groups & Arrays · 15

Write 8 + 8 + 8 + 8 as a multiplication. What is the product?

Multiplication: Equal Groups & Arrays · 16

There are 2 rows of desks with 2 desks in each row. How many desks are there?

Multiplication: Equal Groups & Arrays · 10

ANSWER

20

Multiplication: Equal Groups & Arrays · 9

ANSWER

27

Multiplication: Equal Groups & Arrays · 12

ANSWER

45

Multiplication: Equal Groups & Arrays · 11

ANSWER

42

Multiplication: Equal Groups & Arrays · 14

ANSWER

10

Multiplication: Equal Groups & Arrays · 13

ANSWER

8

Multiplication: Equal Groups & Arrays · 16

ANSWER

4

Multiplication: Equal Groups & Arrays · 15

ANSWER

32

Multiplication: Equal Groups & Arrays · 17

There are 4 equal groups of dots. How many dots are there in all?

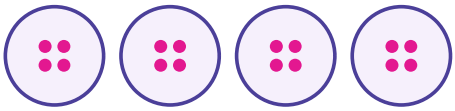

Multiplication: Equal Groups & Arrays · 18

Count the rows and how many stars are in each row. How many stars are in the array?



Multiplication: Equal Groups & Arrays · 19

Write 9 + 9 + 9 + 9 + 9 + 9 as a multiplication. What is the product?

Multiplication: Equal Groups & Arrays · 20

There are 5 rows of desks with 6 desks in each row. How many desks are there?

Multiplication: Equal Groups & Arrays · 21

There are 9 equal groups of dots. How many dots are there in all?



Multiplication: Equal Groups & Arrays · 22

Count the rows and how many stars are in each row. How many stars are in the array?



Multiplication: Equal Groups & Arrays · 23

Write 10 + 10 + 10 + 10 + 10 as a multiplication. What is the product?

Multiplication: Equal Groups & Arrays · 24

There are 3 rows of plants with 2 plants in each row. How many plants are there?

Multiplication: Equal Groups & Arrays · 18

ANSWER

8

Multiplication: Equal Groups & Arrays · 17

ANSWER

16

Multiplication: Equal Groups & Arrays · 20

ANSWER

30

Multiplication: Equal Groups & Arrays · 19

ANSWER

54

Multiplication: Equal Groups & Arrays · 22

ANSWER

15

Multiplication: Equal Groups & Arrays · 21

ANSWER

72

Multiplication: Equal Groups & Arrays · 24

ANSWER

6

Multiplication: Equal Groups & Arrays · 23

ANSWER

50