Multiplication: Equal Groups & Arrays · 1

There are 3 equal groups of dots. How many dots are there in all?



Multiplication: Equal Groups & Arrays · 2

Count the rows and how many stars are in each row. How many stars are in the array?



Multiplication: Equal Groups & Arrays · 3

Write 4 + 4 + 4 + 4 as a multiplication. What is the product?

Multiplication: Equal Groups & Arrays · 4

There are 2 rows of chairs with 2 chairs in each row. How many chairs are there?



Multiplication: Equal Groups & Arrays · 5

There are 2 equal groups of dots. How many dots are there in all?

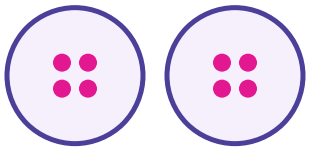

Multiplication: Equal Groups & Arrays · 6

Count the rows and how many stars are in each row. How many stars are in the array?



Multiplication: Equal Groups & Arrays · 7

Write 2 + 2 as a multiplication. What is the product?

Multiplication: Equal Groups & Arrays · 8

There are 4 rows of chairs with 2 chairs in each row. How many chairs are there?



Multiplication: Equal Groups & Arrays · 2

**ANSWER**

**12**

Multiplication: Equal Groups & Arrays · 1

**ANSWER**

**9**

Multiplication: Equal Groups & Arrays · 4

**ANSWER**

**4**

Multiplication: Equal Groups & Arrays · 3

**ANSWER**

**16**

Multiplication: Equal Groups & Arrays · 6

**ANSWER**

**4**

Multiplication: Equal Groups & Arrays · 5

**ANSWER**

**8**

Multiplication: Equal Groups & Arrays · 8

**ANSWER**

**8**

Multiplication: Equal Groups & Arrays · 7

**ANSWER**

**4**

Multiplication: Equal Groups & Arrays · 9

There are 2 equal groups of dots. How many dots are there in all?

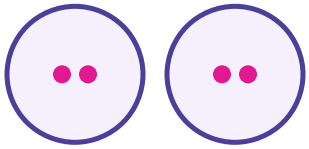

Multiplication: Equal Groups & Arrays · 10

Count the rows and how many stars are in each row. How many stars are in the array?



Multiplication: Equal Groups & Arrays · 11

There are 4 packs with 2 stickers in each. How many stickers are there in all?

Multiplication: Equal Groups & Arrays · 12

There are 5 equal groups of dots. How many dots are there in all?



Multiplication: Equal Groups & Arrays · 13

Count the rows and how many stars are in each row. How many stars are in the array?



Multiplication: Equal Groups & Arrays · 14

Write 5 + 5 + 5 + 5 as a multiplication. What is the product?

Multiplication: Equal Groups & Arrays · 15

There are 4 bags with 5 marbles in each. How many marbles are there in all?

Multiplication: Equal Groups & Arrays · 16

There are 4 equal groups of dots. How many dots are there in all?



Multiplication: Equal Groups & Arrays · 10

**ANSWER**

**12**

Multiplication: Equal Groups & Arrays · 9

**ANSWER**

**4**

Multiplication: Equal Groups & Arrays · 12

**ANSWER**

**10**

Multiplication: Equal Groups & Arrays · 11

**ANSWER**

**8**

Multiplication: Equal Groups & Arrays · 14

**ANSWER**

**20**

Multiplication: Equal Groups & Arrays · 13

**ANSWER**

**6**

Multiplication: Equal Groups & Arrays · 16

**ANSWER**

**20**

Multiplication: Equal Groups & Arrays · 15

**ANSWER**

**20**

Multiplication: Equal Groups & Arrays · 17

Count the rows and how many stars are in each row. How many stars are in the array?



Multiplication: Equal Groups & Arrays · 18

Write 6 + 6 as a multiplication. What is the product?

Multiplication: Equal Groups & Arrays · 19

There are 3 rows of chairs with 3 chairs in each row. How many chairs are there?



Multiplication: Equal Groups & Arrays · 20

There are 6 equal groups of dots. How many dots are there in all?

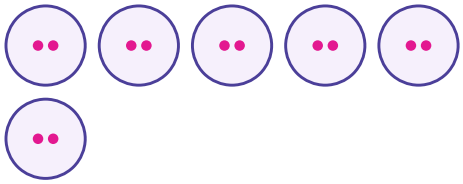

Multiplication: Equal Groups & Arrays · 21

Count the rows and how many stars are in each row. How many stars are in the array?



Multiplication: Equal Groups & Arrays · 22

Write 6 + 6 + 6 + 6 as a multiplication. What is the product?

Multiplication: Equal Groups & Arrays · 23

There are 2 boxes with 3 crayons in each. How many crayons are there in all?

Multiplication: Equal Groups & Arrays · 24

Count the rows and how many stars are in each row. How many stars are in the array?



Multiplication: Equal Groups & Arrays · 18

**ANSWER**

**12**

Multiplication: Equal Groups & Arrays · 17

**ANSWER**

**8**

Multiplication: Equal Groups & Arrays · 20

**ANSWER**

**12**

Multiplication: Equal Groups & Arrays · 19

**ANSWER**

**9**

Multiplication: Equal Groups & Arrays · 22

**ANSWER**

**24**

Multiplication: Equal Groups & Arrays · 21

**ANSWER**

**15**

Multiplication: Equal Groups & Arrays · 24

**ANSWER**

**4**

Multiplication: Equal Groups & Arrays · 23

**ANSWER**

**6**