Multiplication: Equal Groups & Arrays · 1

There are 3 equal groups of dots. How many dots are there in all?



Multiplication: Equal Groups & Arrays · 2

Count the rows and how many stars are in each row. How many stars are in the array?



Multiplication: Equal Groups & Arrays · 3

Write 4 + 4 + 4 + 4 as a multiplication. What is the product?

Multiplication: Equal Groups & Arrays · 4

There are 2 rows of chairs with 2 chairs in each row. How many chairs are there?



Multiplication: Equal Groups & Arrays · 5

There are 2 equal groups of dots. How many dots are there in all?

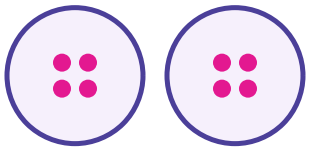

Multiplication: Equal Groups & Arrays · 6

Count the rows and how many stars are in each row. How many stars are in the array?



Multiplication: Equal Groups & Arrays · 7

Write 2 + 2 as a multiplication. What is the product?

Multiplication: Equal Groups & Arrays · 8

There are 4 rows of chairs with 2 chairs in each row. How many chairs are there?



Multiplication: Equal Groups & Arrays · 2

ANSWER

12

Multiplication: Equal Groups & Arrays · 1

ANSWER

9

Multiplication: Equal Groups & Arrays · 4

ANSWER

4

Multiplication: Equal Groups & Arrays · 3

ANSWER

16

Multiplication: Equal Groups & Arrays · 6

ANSWER

4

Multiplication: Equal Groups & Arrays · 5

ANSWER

8

Multiplication: Equal Groups & Arrays · 8

ANSWER

8

Multiplication: Equal Groups & Arrays · 7

ANSWER

4

Multiplication: Equal Groups & Arrays · 9

There are 2 equal groups of dots. How many dots are there in all?

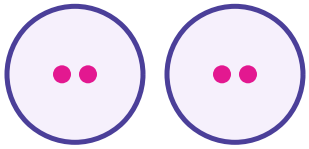

Multiplication: Equal Groups & Arrays · 10

Count the rows and how many stars are in each row. How many stars are in the array?



Multiplication: Equal Groups & Arrays · 11

There are 4 packs with 2 stickers in each. How many stickers are there in all?

Multiplication: Equal Groups & Arrays · 12

There are 5 equal groups of dots. How many dots are there in all?



Multiplication: Equal Groups & Arrays · 13

Count the rows and how many stars are in each row. How many stars are in the array?



Multiplication: Equal Groups & Arrays · 14

Write 5 + 5 + 5 + 5 as a multiplication. What is the product?

Multiplication: Equal Groups & Arrays · 15

There are 4 bags with 5 marbles in each. How many marbles are there in all?

Multiplication: Equal Groups & Arrays · 16

There are 4 equal groups of dots. How many dots are there in all?



Multiplication: Equal Groups & Arrays · 10

ANSWER

12

Multiplication: Equal Groups & Arrays · 9

ANSWER

4

Multiplication: Equal Groups & Arrays · 12

ANSWER

10

Multiplication: Equal Groups & Arrays · 11

ANSWER

8

Multiplication: Equal Groups & Arrays · 14

ANSWER

20

Multiplication: Equal Groups & Arrays · 13

ANSWER

6

Multiplication: Equal Groups & Arrays · 16

ANSWER

20

Multiplication: Equal Groups & Arrays · 15

ANSWER

20

Multiplication: Equal Groups & Arrays · 17

Count the rows and how many stars are in each row. How many stars are in the array?



Multiplication: Equal Groups & Arrays · 18

Write 6 + 6 as a multiplication. What is the product?

Multiplication: Equal Groups & Arrays · 19

There are 3 rows of chairs with 3 chairs in each row. How many chairs are there?



Multiplication: Equal Groups & Arrays · 20

There are 6 equal groups of dots. How many dots are there in all?

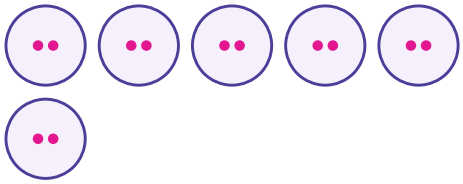

Multiplication: Equal Groups & Arrays · 21

Count the rows and how many stars are in each row. How many stars are in the array?



Multiplication: Equal Groups & Arrays · 22

Write 6 + 6 + 6 + 6 as a multiplication. What is the product?

Multiplication: Equal Groups & Arrays · 23

There are 2 boxes with 3 crayons in each. How many crayons are there in all?

Multiplication: Equal Groups & Arrays · 24

Count the rows and how many stars are in each row. How many stars are in the array?



Multiplication: Equal Groups & Arrays · 18

ANSWER

12

Multiplication: Equal Groups & Arrays · 17

ANSWER

8

Multiplication: Equal Groups & Arrays · 20

ANSWER

12

Multiplication: Equal Groups & Arrays · 19

ANSWER

9

Multiplication: Equal Groups & Arrays · 22

ANSWER

24

Multiplication: Equal Groups & Arrays · 21

ANSWER

15

Multiplication: Equal Groups & Arrays · 24

ANSWER

4

Multiplication: Equal Groups & Arrays · 23

ANSWER

6