Task card 1 Liquid Volume & Mass

How many liters of water are in the container?

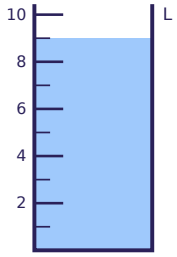

Task card 2 Liquid Volume & Mass

The scale shows the mass of a bag of soil. How many kilograms is it?



Task card 3 Liquid Volume & Mass

A tub has 30 liters of water. 13 liters drain out. How many liters are left?

Task card 4 Liquid Volume & Mass

Which unit would you use to measure the mass of a pencil? Write grams or kilograms.

Task card 5 Liquid Volume & Mass

How many liters of water are in the container?

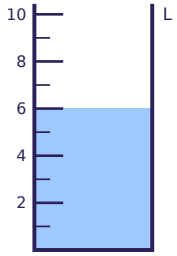

Task card 6 Liquid Volume & Mass

A farmer splits 35 kilograms of rice equally into 5 sacks. How many kilograms are in each sack?

Task card 7 Liquid Volume & Mass

The scale shows the mass of a package. How many grams is it?



Task card 8 Liquid Volume & Mass

About how much water does a swimming pool hold: 50 liters or 50000 liters? Write the number.

Task card 9 Liquid Volume & Mass

How many liters of water are in the container?

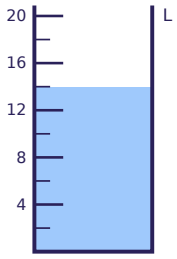

Task card 10 Liquid Volume & Mass

The scale shows the mass of a box of books. How many kilograms is it?



Task card 11 Liquid Volume & Mass

A farmer splits 9 kilograms of rice equally into 3 sacks. How many kilograms are in each sack?

Task card 12 Liquid Volume & Mass

Which unit would you use to measure the mass of a paper clip? Write grams or kilograms.

Task card 13 Liquid Volume & Mass

How many liters of water are in the container?

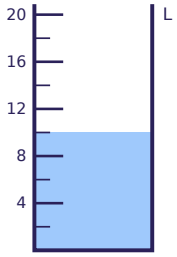

Task card 14 Liquid Volume & Mass

A tub has 21 liters of water. 11 liters drain out. How many liters are left?

Task card 15 Liquid Volume & Mass

The scale shows the mass of a box of books. How many kilograms is it?



Task card 16 Liquid Volume & Mass

About how much water does a bathtub hold: 2 liters or 200 liters? Write the number.

Task card 17 Liquid Volume & Mass

How many liters of water are in the container?

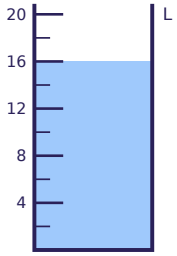

Task card 18 Liquid Volume & Mass

The scale shows the mass of a bag of soil. How many kilograms is it?



Task card 19 Liquid Volume & Mass

A melon has a mass of 300 grams. An apple has a mass of 140 grams. How many more grams is the melon than the apple?

Task card 20 Liquid Volume & Mass

Which unit would you use to measure the mass of a sheet of paper? Write grams or kilograms.

Task card 21 Liquid Volume & Mass

How many liters of water are in the container?

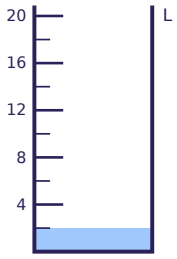

Task card 22 Liquid Volume & Mass

A tub has 51 liters of water. 34 liters drain out. How many liters are left?

Task card 23 Liquid Volume & Mass

The scale shows the mass of a block of cheese. How many grams is it?



Task card 24 Liquid Volume & Mass

About how much water does a cooking pot hold: 4 liters or 400 liters? Write the number.

Liquid Volume & Mass Task Cards

Recording sheet · Grade 3 · Read each scale or solve each problem. Write only the number or the word asked for.

Name: _____ Date: _____

Scan to check your answers

1	2	3	4
5	6	7	8
9	10	11	12
13	14	15	16
17	18	19	20
21	22	23	24

Liquid Volume & Mass Task Cards: Answer Key

Grade 3 · Medium

The answers online

1. 9	**2.** 6	**3.** 17
4. grams	**5.** 6	**6.** 7
7. 350	**8.** 50000	**9.** 14
10. 13	**11.** 3	**12.** grams
13. 10	**14.** 10	**15.** 19
16. 200	**17.** 16	**18.** 4
19. 160	**20.** grams	**21.** 2
22. 17	**23.** 850	**24.** 4