Task card 1 Liquid Volume & Mass

How many liters of water are in the container?

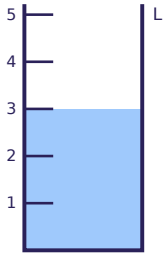

Task card 2 Liquid Volume & Mass

The scale shows the mass of a bag of nuts. How many grams is it?



Task card 3 Liquid Volume & Mass

A farmer splits 16 kilograms of rice equally into 4 sacks. How many kilograms are in each sack?

Task card 4 Liquid Volume & Mass

Which unit would you use to measure the mass of a pencil? Write grams or kilograms.

Task card 5 Liquid Volume & Mass

How many liters of water are in the container?

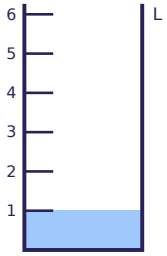

Task card 6 Liquid Volume & Mass

A farmer splits 6 kilograms of rice equally into 3 sacks. How many kilograms are in each sack?

Task card 7 Liquid Volume & Mass

The scale shows the mass of a box of books. How many kilograms is it?



Task card 8 Liquid Volume & Mass

About how much water does a swimming pool hold: 50 liters or 50000 liters? Write the number.

Task card 9 Liquid Volume & Mass

How many liters of water are in the container?

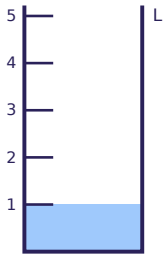

Task card 10 Liquid Volume & Mass

The scale shows the mass of a package. How many grams is it?

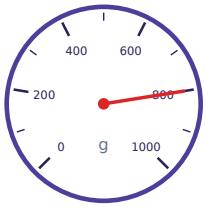

Task card 11 Liquid Volume & Mass

Each jug holds 5 liters of juice. How many liters do 5 jugs hold?

Task card 12 Liquid Volume & Mass

Which unit would you use to measure the mass of a button? Write grams or kilograms.

Task card 13 Liquid Volume & Mass

One fish tank holds 20 liters of water. Another holds 6 liters. How many liters do they hold in all?

Task card 14 Liquid Volume & Mass

The scale shows the mass of a bag of soil. How many kilograms is it?



Task card 15 Liquid Volume & Mass

About how much water does a cooking pot hold: 4 liters or 400 liters? Write the number.

Task card 16 Liquid Volume & Mass

How many liters of water are in the container?

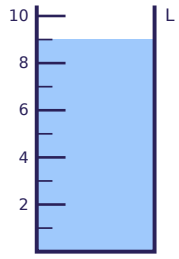

Task card 17 Liquid Volume & Mass

The scale shows the mass of a block of cheese. How many grams is it?



Task card 18 Liquid Volume & Mass

One fish tank holds 15 liters of water. Another holds 6 liters. How many liters do they hold in all?

Task card 19 Liquid Volume & Mass

Which unit would you use to measure the mass of a watermelon? Write grams or kilograms.

Task card 20 Liquid Volume & Mass

How many liters of water are in the container?

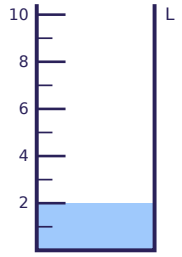

Task card 21 Liquid Volume & Mass

Each jug holds 6 liters of juice. How many liters do 4 jugs hold?

Task card 22 Liquid Volume & Mass

The scale shows the mass of a watermelon. How many kilograms is it?

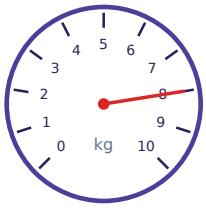

Task card 23 Liquid Volume & Mass

About how much water does a kitchen sink hold: 1 liters or 20 liters? Write the number.

Task card 24 Liquid Volume & Mass

The scale shows the mass of a box of books. How many kilograms is it?



Liquid Volume & Mass Task Cards

Recording sheet · Grade 3 · Read each scale or solve each problem. Write only the number or the word asked for.

Name: _____ Date: _____

Scan to check your answers

1	2	3	4
5	6	7	8
9	10	11	12
13	14	15	16
17	18	19	20
21	22	23	24

Liquid Volume & Mass Task Cards: Answer Key

Grade 3 · Easy

The answers online

1. 3	**2.** 900	**3.** 4
4. grams	**5.** 1	**6.** 2
7. 3	**8.** 50000	**9.** 1
10. 800	**11.** 25	**12.** grams
13. 26	**14.** 4	**15.** 4
16. 9	**17.** 300	**18.** 21
19. kilograms	**20.** 2	**21.** 24
22. 8	**23.** 20	**24.** 7