Liquid Volume & Mass · 1

How many liters of water are in the container?

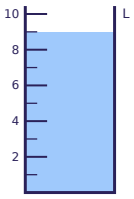

Liquid Volume & Mass · 2

The scale shows the mass of a bag of soil. How many kilograms is it?



Liquid Volume & Mass · 3

A tub has 30 liters of water. 13 liters drain out. How many liters are left?

Liquid Volume & Mass · 4

Which unit would you use to measure the mass of a pencil? Write grams or kilograms.

Liquid Volume & Mass · 5

How many liters of water are in the container?

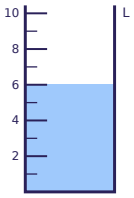

Liquid Volume & Mass · 6

A farmer splits 35 kilograms of rice equally into 5 sacks. How many kilograms are in each sack?

Liquid Volume & Mass · 7

The scale shows the mass of a package. How many grams is it?



Liquid Volume & Mass · 8

About how much water does a swimming pool hold: 50 liters or 50000 liters? Write the number.

Liquid Volume & Mass · 2

ANSWER

6

Liquid Volume & Mass · 1

ANSWER

9

Liquid Volume & Mass · 4

ANSWER

grams

Liquid Volume & Mass · 3

ANSWER

17

Liquid Volume & Mass · 6

ANSWER

7

Liquid Volume & Mass · 5

ANSWER

6

Liquid Volume & Mass · 8

ANSWER

50000

Liquid Volume & Mass · 7

ANSWER

350

Liquid Volume & Mass · 9

How many liters of water are in the container?

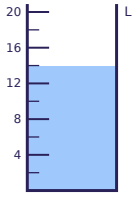

Liquid Volume & Mass · 10

The scale shows the mass of a box of books. How many kilograms is it?



Liquid Volume & Mass · 11

A farmer splits 9 kilograms of rice equally into 3 sacks. How many kilograms are in each sack?

Liquid Volume & Mass · 12

Which unit would you use to measure the mass of a paper clip? Write grams or kilograms.

Liquid Volume & Mass · 13

How many liters of water are in the container?

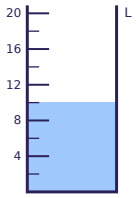

Liquid Volume & Mass · 14

A tub has 21 liters of water. 11 liters drain out. How many liters are left?

Liquid Volume & Mass · 15

The scale shows the mass of a box of books. How many kilograms is it?



Liquid Volume & Mass · 16

About how much water does a bathtub hold: 2 liters or 200 liters? Write the number.

Liquid Volume & Mass · 10

ANSWER

13

Liquid Volume & Mass · 9

ANSWER

14

Liquid Volume & Mass · 12

ANSWER

grams

Liquid Volume & Mass · 11

ANSWER

3

Liquid Volume & Mass · 14

ANSWER

10

Liquid Volume & Mass · 13

ANSWER

10

Liquid Volume & Mass · 16

ANSWER

200

Liquid Volume & Mass · 15

ANSWER

19

Liquid Volume & Mass · 17

How many liters of water are in the container?

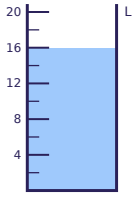

Liquid Volume & Mass · 18

The scale shows the mass of a bag of soil. How many kilograms is it?



Liquid Volume & Mass · 19

A melon has a mass of 300 grams. An apple has a mass of 140 grams. How many more grams is the melon than the apple?

Liquid Volume & Mass · 20

Which unit would you use to measure the mass of a sheet of paper? Write grams or kilograms.

Liquid Volume & Mass · 21

How many liters of water are in the container?



Liquid Volume & Mass · 22

A tub has 51 liters of water. 34 liters drain out. How many liters are left?

Liquid Volume & Mass · 23

The scale shows the mass of a block of cheese. How many grams is it?



Liquid Volume & Mass · 24

About how much water does a cooking pot hold: 4 liters or 400 liters? Write the number.

Liquid Volume & Mass · 18

ANSWER

4

Liquid Volume & Mass · 17

ANSWER

16

Liquid Volume & Mass · 20

ANSWER

grams

Liquid Volume & Mass · 19

ANSWER

160

Liquid Volume & Mass · 22

ANSWER

17

Liquid Volume & Mass · 21

ANSWER

2

Liquid Volume & Mass · 24

ANSWER

4

Liquid Volume & Mass · 23

ANSWER

850