Liquid Volume & Mass · 1

How many liters of water are in the container?

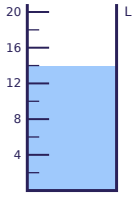

Liquid Volume & Mass · 2

The scale shows the mass of a box of cereal. How many grams is it?



Liquid Volume & Mass · 3

A farmer splits 24 kilograms of rice equally into 4 sacks. How many kilograms are in each sack?

Liquid Volume & Mass · 4

Which unit would you use to measure the mass of a big dictionary? Write grams or kilograms.

Liquid Volume & Mass · 5

How many liters of water are in the container?

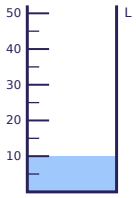

Liquid Volume & Mass · 6

A tub has 55 liters of water. 36 liters drain out. How many liters are left?

Liquid Volume & Mass · 7

The scale shows the mass of a box of books. How many kilograms is it?



Liquid Volume & Mass · 8

About how much water does a cooking pot hold: 4 liters or 400 liters? Write the number.

Liquid Volume & Mass · 2

ANSWER

900

Liquid Volume & Mass · 1

ANSWER

14

Liquid Volume & Mass · 4

ANSWER

kilograms

Liquid Volume & Mass · 3

ANSWER

6

Liquid Volume & Mass · 6

ANSWER

19

Liquid Volume & Mass · 5

ANSWER

10

Liquid Volume & Mass · 8

ANSWER

4

Liquid Volume & Mass · 7

ANSWER

7

Liquid Volume & Mass · 9

How many liters of water are in the container?



Liquid Volume & Mass · 10

The scale shows the mass of a package. How many grams is it?



Liquid Volume & Mass · 11

A farmer splits 28 kilograms of rice equally into 4 sacks. How many kilograms are in each sack?

Liquid Volume & Mass · 12

Which unit would you use to measure the mass of a bicycle? Write grams or kilograms.

Liquid Volume & Mass · 13

How many liters of water are in the container?

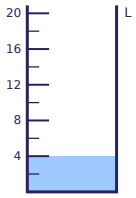

Liquid Volume & Mass · 14

One fish tank holds 8 liters of water. Another holds 7 liters. How many liters do they hold in all?

Liquid Volume & Mass · 15

The scale shows the mass of a package. How many grams is it?



Liquid Volume & Mass · 16

About how much water does a fish tank hold: 3 liters or 60 liters? Write the number.

Liquid Volume & Mass · 10

ANSWER

50

Liquid Volume & Mass · 9

ANSWER

45

Liquid Volume & Mass · 12

ANSWER

kilograms

Liquid Volume & Mass · 11

ANSWER

7

Liquid Volume & Mass · 14

ANSWER

15

Liquid Volume & Mass · 13

ANSWER

4

Liquid Volume & Mass · 16

ANSWER

60

Liquid Volume & Mass · 15

ANSWER

800

Liquid Volume & Mass · 17

How many liters of water are in the container?



Liquid Volume & Mass · 18

The scale shows the mass of a bag of nuts. How many grams is it?



Liquid Volume & Mass · 19

A melon has a mass of 1370 grams. An apple has a mass of 230 grams. How many more grams is the melon than the apple?

Liquid Volume & Mass · 20

Which unit would you use to measure the mass of a bag of potatoes? Write grams or kilograms.

Liquid Volume & Mass · 21

How many liters of water are in the container?

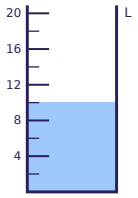

Liquid Volume & Mass · 22

Each jug holds 7 liters of juice. How many liters do 6 jugs hold?

Liquid Volume & Mass · 23

The scale shows the mass of a box of cereal. How many grams is it?



Liquid Volume & Mass · 24

How many liters of water are in the container?

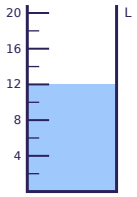

Liquid Volume & Mass · 18

ANSWER

700

Liquid Volume & Mass · 17

ANSWER

5

Liquid Volume & Mass · 20

ANSWER

kilograms

Liquid Volume & Mass · 19

ANSWER

1140

Liquid Volume & Mass · 22

ANSWER

42

Liquid Volume & Mass · 21

ANSWER

10

Liquid Volume & Mass · 24

ANSWER

12

Liquid Volume & Mass · 23

ANSWER

500