Liquid Volume & Mass · 1

How many liters of water are in the container?

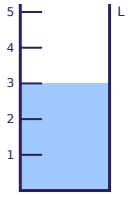

Liquid Volume & Mass · 2

The scale shows the mass of a bag of nuts. How many grams is it?



Liquid Volume & Mass · 3

A farmer splits 16 kilograms of rice equally into 4 sacks. How many kilograms are in each sack?

Liquid Volume & Mass · 4

Which unit would you use to measure the mass of a pencil? Write grams or kilograms.

Liquid Volume & Mass · 5

How many liters of water are in the container?

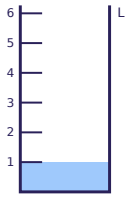

Liquid Volume & Mass · 6

A farmer splits 6 kilograms of rice equally into 3 sacks. How many kilograms are in each sack?

Liquid Volume & Mass · 7

The scale shows the mass of a box of books. How many kilograms is it?



Liquid Volume & Mass · 8

About how much water does a swimming pool hold: 50 liters or 50000 liters? Write the number.

Liquid Volume & Mass · 2

ANSWER

900

Liquid Volume & Mass · 1

ANSWER

3

Liquid Volume & Mass · 4

ANSWER

grams

Liquid Volume & Mass · 3

ANSWER

4

Liquid Volume & Mass · 6

ANSWER

2

Liquid Volume & Mass · 5

ANSWER

1

Liquid Volume & Mass · 8

ANSWER

50000

Liquid Volume & Mass · 7

ANSWER

3

Liquid Volume & Mass · 9

How many liters of water are in the container?

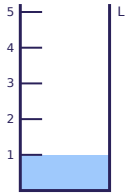

Liquid Volume & Mass · 10

The scale shows the mass of a package. How many grams is it?

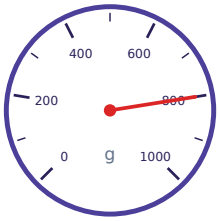

Liquid Volume & Mass · 11

Each jug holds 5 liters of juice. How many liters do 5 jugs hold?

Liquid Volume & Mass · 12

Which unit would you use to measure the mass of a button? Write grams or kilograms.

Liquid Volume & Mass · 13

One fish tank holds 20 liters of water. Another holds 6 liters. How many liters do they hold in all?

Liquid Volume & Mass · 14

The scale shows the mass of a bag of soil. How many kilograms is it?



Liquid Volume & Mass · 15

About how much water does a cooking pot hold: 4 liters or 400 liters? Write the number.

Liquid Volume & Mass · 16

How many liters of water are in the container?

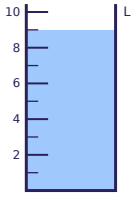

Liquid Volume & Mass · 10

ANSWER

800

Liquid Volume & Mass · 9

ANSWER

1

Liquid Volume & Mass · 12

ANSWER

grams

Liquid Volume & Mass · 11

ANSWER

25

Liquid Volume & Mass · 14

ANSWER

4

Liquid Volume & Mass · 13

ANSWER

26

Liquid Volume & Mass · 16

ANSWER

9

Liquid Volume & Mass · 15

ANSWER

4

Liquid Volume & Mass · 17

The scale shows the mass of a block of cheese. How many grams is it?



Liquid Volume & Mass · 18

One fish tank holds 15 liters of water. Another holds 6 liters. How many liters do they hold in all?

Liquid Volume & Mass · 19

Which unit would you use to measure the mass of a watermelon? Write grams or kilograms.

Liquid Volume & Mass · 20

How many liters of water are in the container?

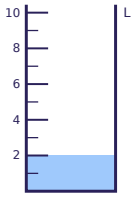

Liquid Volume & Mass · 21

Each jug holds 6 liters of juice. How many liters do 4 jugs hold?

Liquid Volume & Mass · 22

The scale shows the mass of a watermelon. How many kilograms is it?

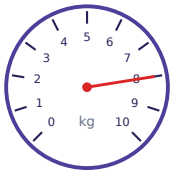

Liquid Volume & Mass · 23

About how much water does a kitchen sink hold: 1 liters or 20 liters? Write the number.

Liquid Volume & Mass · 24

The scale shows the mass of a box of books. How many kilograms is it?



Liquid Volume & Mass · 18

ANSWER

21

Liquid Volume & Mass · 17

ANSWER

300

Liquid Volume & Mass · 20

ANSWER

2

Liquid Volume & Mass · 19

ANSWER

kilograms

Liquid Volume & Mass · 22

ANSWER

8

Liquid Volume & Mass · 21

ANSWER

24

Liquid Volume & Mass · 24

ANSWER

7

Liquid Volume & Mass · 23

ANSWER

20