Task card 1 — Line Plots with Halves & Fourths

How many pencils are 4 inches long?

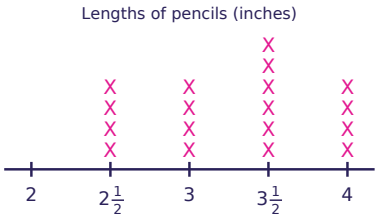

Task card 2 — Line Plots with Halves & Fourths

How many crayons were measured in all?

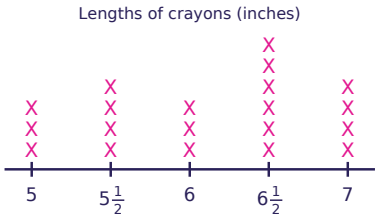

Task card 3 — Line Plots with Halves & Fourths

How many more pencils are 6 inches long than $6\frac{1}{2}$ inches long?

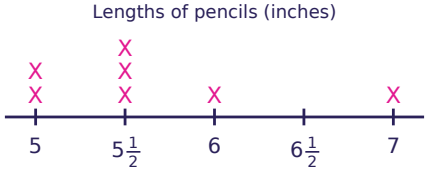

Task card 4 — Line Plots with Halves & Fourths

How many shells are longer than 3 inches?

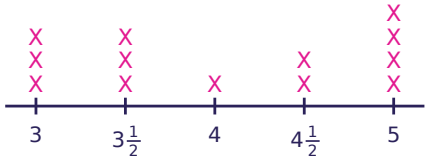

Task card 5 — Line Plots with Halves & Fourths

How many ribbons are $2\frac{1}{2}$ inches long?

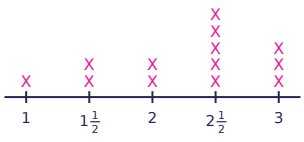

Task card 6 — Line Plots with Halves & Fourths

How many ribbons were measured in all?

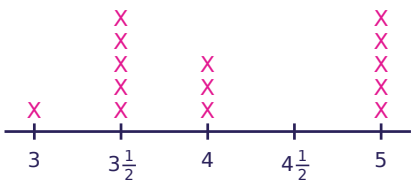

Task card 7 — Line Plots with Halves & Fourths

How many more leaves are 3 inches long than 4 inches long?

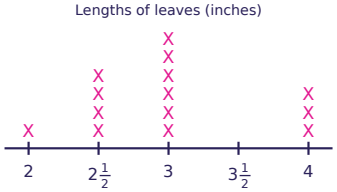

Task card 8 — Line Plots with Halves & Fourths

How many pencils are shorter than 5 inches?



Task card 9 — Line Plots with Halves & Fourths

How many toy cars are 4 inches long?

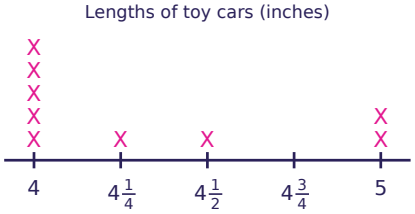

Task card 10 — Line Plots with Halves & Fourths

How many toy cars were measured in all?



Task card 11 — Line Plots with Halves & Fourths

How many more crayons are $4\frac{1}{4}$ inches long than 4 inches long?

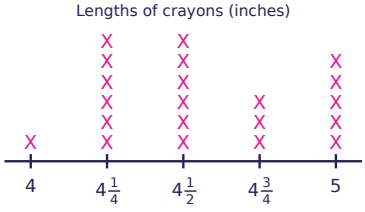

Task card 12 — Line Plots with Halves & Fourths

How many pencils are shorter than $3\frac{1}{2}$ inches?

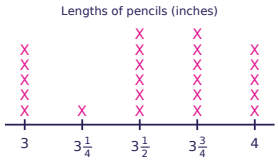

Task card 13 Line Plots with Halves & Fourths

How many leaves are 1 inches long?

Lengths of leaves (inches)

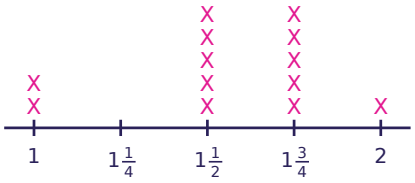

Task card 14 Line Plots with Halves & Fourths

How many crayons were measured in all?

Lengths of crayons (inches)

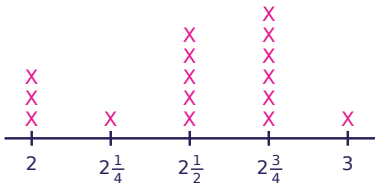

Task card 15 Line Plots with Halves & Fourths

How many more crayons are 3 inches long than $3\frac{3}{4}$ inches long?

Lengths of crayons (inches)

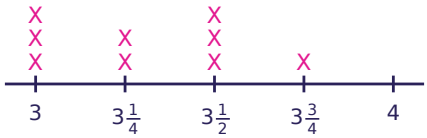

Task card 16 Line Plots with Halves & Fourths

How many leaves are longer than $2\frac{1}{2}$ inches?

Lengths of leaves (inches)

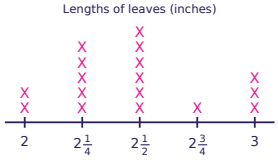

Task card 17 Line Plots with Halves & Fourths

How many ribbons are $4\frac{3}{4}$ inches long?

Lengths of ribbons (inches)

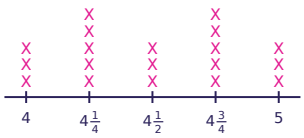

Task card 18 Line Plots with Halves & Fourths

How many toy cars were measured in all?

Lengths of toy cars (inches)

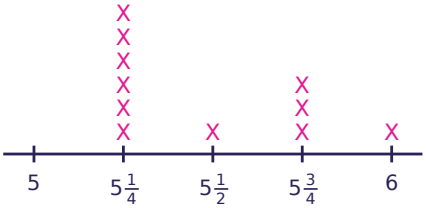

Task card 19 — Line Plots with Halves & Fourths

How many more toy cars are $3\frac{1}{2}$ inches long than $3\frac{3}{4}$ inches long?

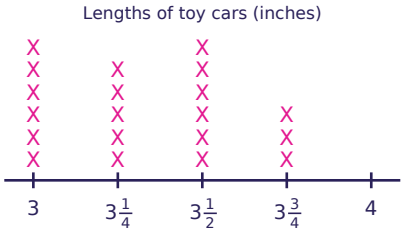

Task card 20 — Line Plots with Halves & Fourths

How many pencils are shorter than $1\frac{3}{4}$ inches?

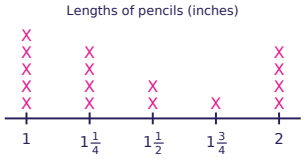

Task card 21 — Line Plots with Halves & Fourths

How many ribbons are $3\frac{1}{2}$ inches long?

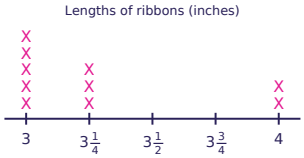

Task card 22 — Line Plots with Halves & Fourths

How many toy cars were measured in all?

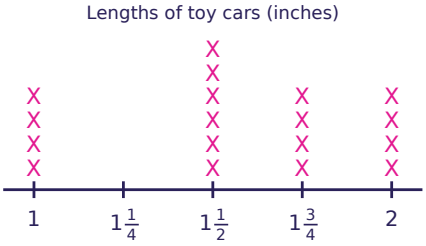

Task card 23 — Line Plots with Halves & Fourths

How many more ribbons are $3\frac{1}{4}$ inches long than 4 inches long?



Task card 24 — Line Plots with Halves & Fourths

How many pencils are longer than 3 inches?

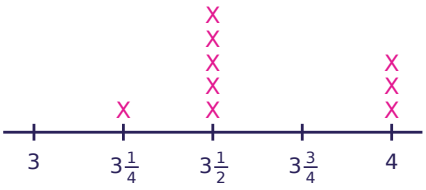

Line Plots with Halves & Fourths Task Cards

Recording sheet · Grade 3 · Each X on the line plot stands for one object. Use the line plot to answer each question.

Name: _____ Date: _____

Scan to check your answers

1	2	3	4
5	6	7	8
9	10	11	12
13	14	15	16
17	18	19	20
21	22	23	24

Line Plots with Halves & Fourths Task Cards: Answer Key

Grade 3 · Medium

The answers online

1. 4	**2.** 20	**3.** 1
4. 10	**5.** 5	**6.** 14
7. 3	**8.** 4	**9.** 5
10. 12	**11.** 5	**12.** 6
13. 2	**14.** 16	**15.** 2
16. 4	**17.** 5	**18.** 11
19. 3	**20.** 11	**21.** 0
22. 18	**23.** 3	**24.** 9