Task card 1 — Line Plots with Halves & Fourths

How many leaves are 2 $\frac{1}{2}$ inches long?

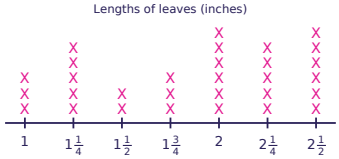

Task card 2 — Line Plots with Halves & Fourths

How many toy cars were measured in all?

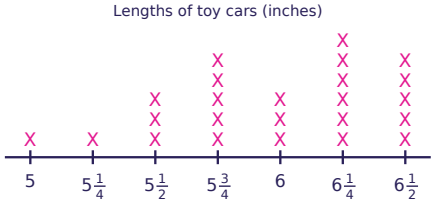

Task card 3 — Line Plots with Halves & Fourths

How many more toy cars are 3 $\frac{1}{4}$ inches long than 3 inches long?

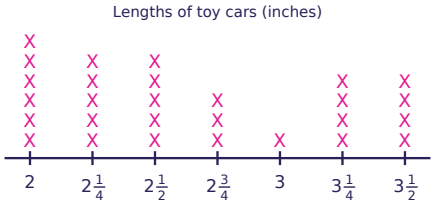

Task card 4 — Line Plots with Halves & Fourths

How many toy cars are shorter than 2 inches?

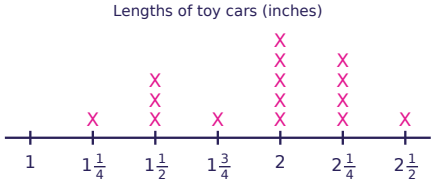

Task card 5 — Line Plots with Halves & Fourths

How many toy cars are 2 $\frac{1}{4}$ inches long?

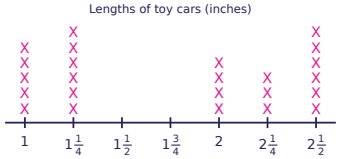

Task card 6 — Line Plots with Halves & Fourths

How many ribbons were measured in all?

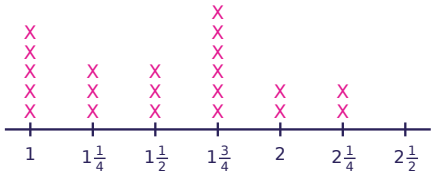

Task card 7 — Line Plots with Halves & Fourths

How many shells are either $2\frac{1}{4}$ or 2 inches long?

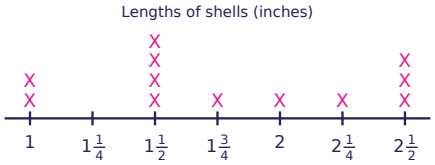

Task card 8 — Line Plots with Halves & Fourths

How many toy cars are shorter than $4\frac{1}{4}$ inches?



Task card 9 — Line Plots with Halves & Fourths

How many crayons are 2 inches long?

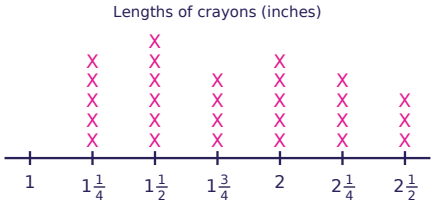

Task card 10 — Line Plots with Halves & Fourths

How many toy cars were measured in all?

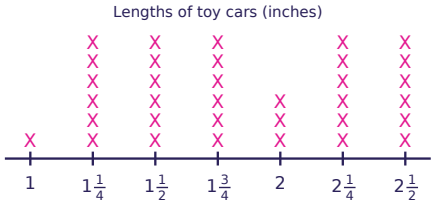

Task card 11 — Line Plots with Halves & Fourths

How many more ribbons are 5 inches long than 6 inches long?

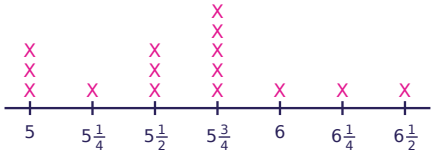

Task card 12 — Line Plots with Halves & Fourths

How many toy cars are longer than 2 inches?

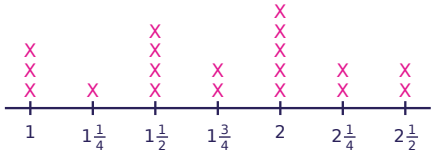

Task card 13 — Line Plots with Halves & Fourths

How many crayons are $3\frac{1}{2}$ inches long?

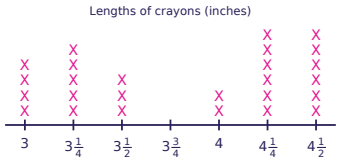

Task card 14 — Line Plots with Halves & Fourths

How many pencils were measured in all?



Task card 15 — Line Plots with Halves & Fourths

How many more pencils are $4\frac{1}{2}$ inches long than $3\frac{1}{2}$ inches long?

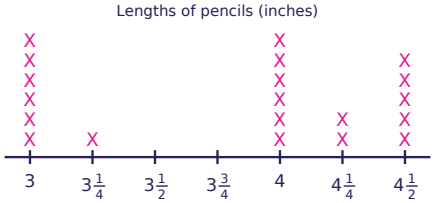

Task card 16 — Line Plots with Halves & Fourths

How many shells are longer than 3 inches?

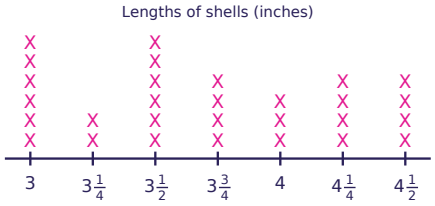

Task card 17 — Line Plots with Halves & Fourths

How many pencils are $5\frac{1}{4}$ inches long?

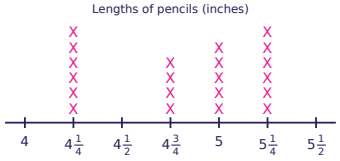

Task card 18 — Line Plots with Halves & Fourths

How many crayons were measured in all?

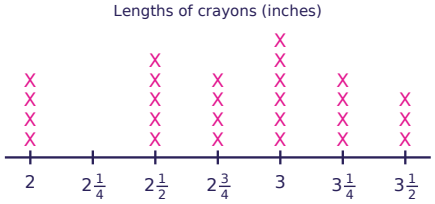

Task card 19 — Line Plots with Halves & Fourths

How many more ribbons are $5\frac{1}{2}$ inches long than 5 inches long?



Task card 20 — Line Plots with Halves & Fourths

How many crayons are longer than $4\frac{1}{4}$ inches?

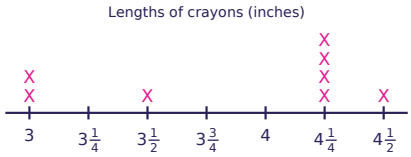

Task card 21 — Line Plots with Halves & Fourths

How many crayons are 2 inches long?

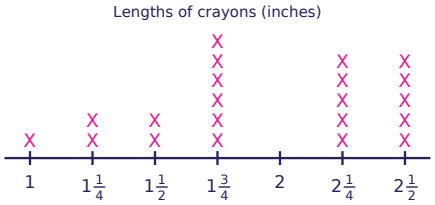

Task card 22 — Line Plots with Halves & Fourths

How many toy cars were measured in all?

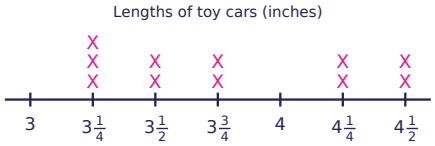

Task card 23 — Line Plots with Halves & Fourths

How many more pencils are $4\frac{1}{4}$ inches long than 4 inches long?

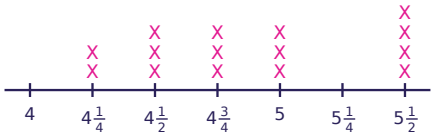

Task card 24 — Line Plots with Halves & Fourths

How many ribbons are longer than $4\frac{1}{4}$ inches?

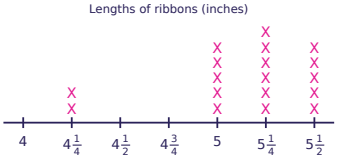

Line Plots with Halves & Fourths Task Cards

Recording sheet · Grade 3 · Each X on the line plot stands for one object. Use the line plot to answer each question.

Name: _____ Date: _____

Scan to check your answers

1	2	3	4
5	6	7	8
9	10	11	12
13	14	15	16
17	18	19	20
21	22	23	24

Line Plots with Halves & Fourths Task Cards: Answer Key

Grade 3 · Hard

The answers online

1. 6	**2.** 24	**3.** 3
4. 5	**5.** 3	**6.** 21
7. 2	**8.** 13	**9.** 5
10. 34	**11.** 2	**12.** 4
13. 3	**14.** 23	**15.** 5
16. 23	**17.** 6	**18.** 26
19. 4	**20.** 1	**21.** 0
22. 11	**23.** 2	**24.** 16