Task card 1 Line Plots with Halves & Fourths

How many leaves are 5 inches long?

Lengths of leaves (inches)

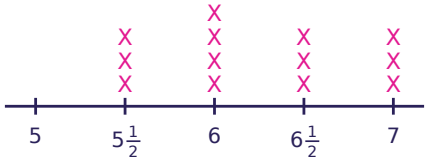

Task card 2 Line Plots with Halves & Fourths

How many leaves were measured in all?

Lengths of leaves (inches)

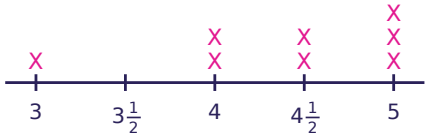

Task card 3 Line Plots with Halves & Fourths

How many more shells are 4 inches long than 2 $\frac{1}{2}$ inches long?

Lengths of shells (inches)

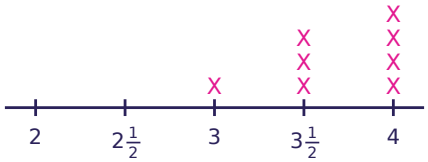

Task card 4 Line Plots with Halves & Fourths

How many leaves are longer than 2 inches?

Lengths of leaves (inches)

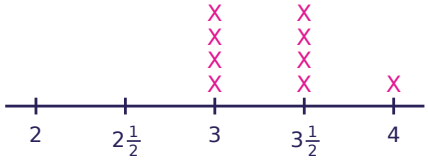

Task card 5 Line Plots with Halves & Fourths

How many leaves are 3 $\frac{1}{2}$ inches long?

Lengths of leaves (inches)

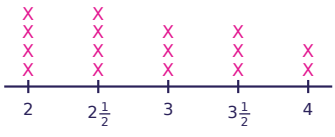

Task card 6 Line Plots with Halves & Fourths

How many pencils were measured in all?

Lengths of pencils (inches)

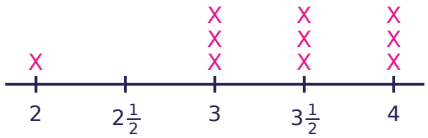

Task card 7 — Line Plots with Halves & Fourths

How many ribbons are either 4 $\frac{1}{2}$ or 5 $\frac{1}{2}$ inches long?

Lengths of ribbons (inches)

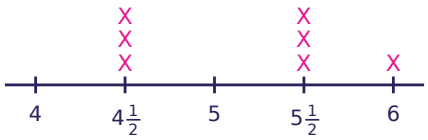

Task card 8 — Line Plots with Halves & Fourths

How many pencils are shorter than 6 inches?

Lengths of pencils (inches)

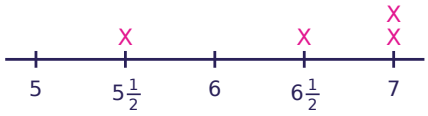

Task card 9 — Line Plots with Halves & Fourths

How many leaves are 5 $\frac{1}{2}$ inches long?

Lengths of leaves (inches)

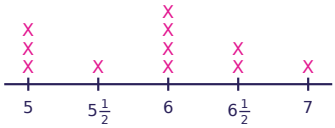

Task card 10 — Line Plots with Halves & Fourths

How many toy cars were measured in all?

Lengths of toy cars (inches)

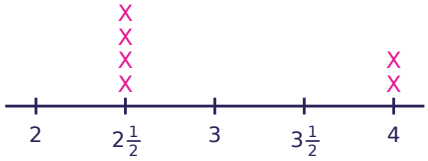

Task card 11 — Line Plots with Halves & Fourths

How many more ribbons are 4 inches long than 3 $\frac{1}{2}$ inches long?

Lengths of ribbons (inches)

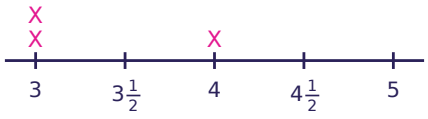

Task card 12 — Line Plots with Halves & Fourths

How many pencils are shorter than 2 inches?

Lengths of pencils (inches)

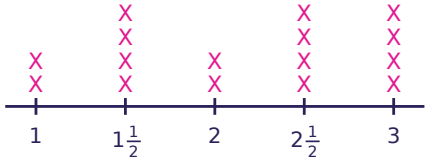

Task card 13 Line Plots with Halves & Fourths

How many crayons are 4 $\frac{1}{2}$ inches long?

Lengths of crayons (inches)

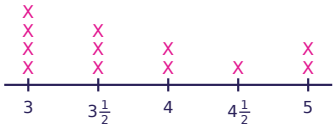

Task card 14 Line Plots with Halves & Fourths

How many crayons were measured in all?

Lengths of crayons (inches)

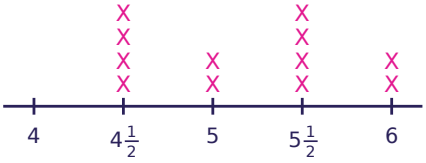

Task card 15 Line Plots with Halves & Fourths

How many more pencils are 1 inches long than 2 $\frac{1}{2}$ inches long?

Lengths of pencils (inches)

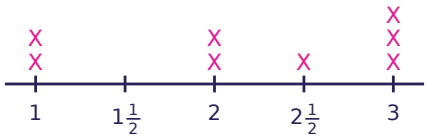

Task card 16 Line Plots with Halves & Fourths

How many crayons are longer than 2 $\frac{1}{2}$ inches?

Lengths of crayons (inches)

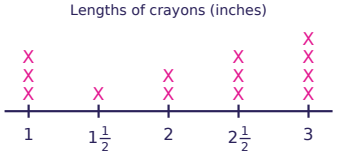

Task card 17 Line Plots with Halves & Fourths

How many crayons are 4 inches long?

Lengths of crayons (inches)



Task card 18 Line Plots with Halves & Fourths

How many shells were measured in all?

Lengths of shells (inches)

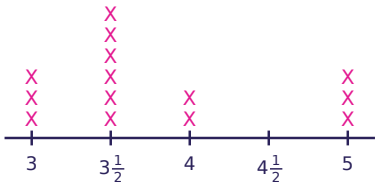

Task card 19 Line Plots with Halves & Fourths

How many more ribbons are 5 inches long than $3\frac{1}{2}$ inches long?

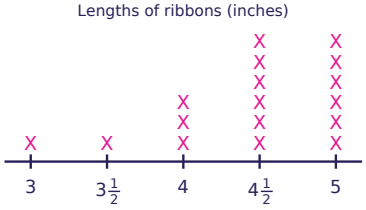

Task card 20 Line Plots with Halves & Fourths

How many pencils are longer than $5\frac{1}{2}$ inches?

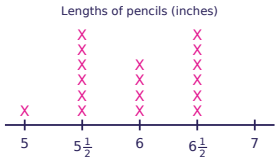

Task card 21 Line Plots with Halves & Fourths

How many pencils are 6 inches long?

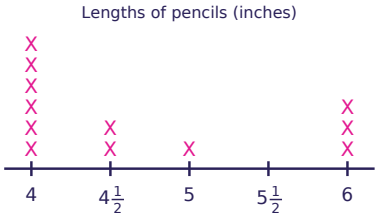

Task card 22 Line Plots with Halves & Fourths

How many ribbons were measured in all?

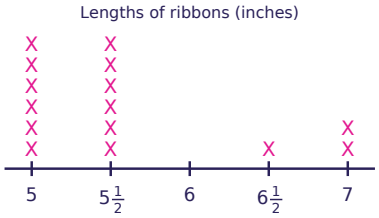

Task card 23 Line Plots with Halves & Fourths

How many more leaves are 4 inches long than $5\frac{1}{2}$ inches long?



Task card 24 Line Plots with Halves & Fourths

How many leaves are longer than $5\frac{1}{2}$ inches?

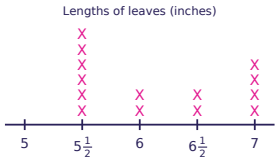

Line Plots with Halves & Fourths Task Cards

Recording sheet · Grade 3 · Each X on the line plot stands for one object. Use the line plot to answer each question.

Name: _____ Date: _____

Scan to check your answers

1	2	3	4
5	6	7	8
9	10	11	12
13	14	15	16
17	18	19	20
21	22	23	24

Line Plots with Halves & Fourths Task Cards: Answer Key

Grade 3 · Easy

The answers online

1. 0	**2.** 8	**3.** 4
4. 9	**5.** 3	**6.** 10
7. 6	**8.** 1	**9.** 1
10. 6	**11.** 1	**12.** 6
13. 1	**14.** 12	**15.** 1
16. 4	**17.** 1	**18.** 14
19. 5	**20.** 10	**21.** 3
22. 15	**23.** 3	**24.** 8