How many pencils are 4 inches long?

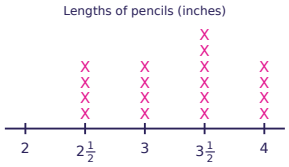

How many crayons were measured in all?

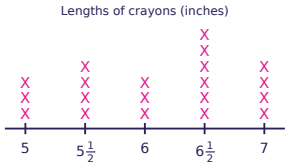

How many more pencils are 6 inches long than $6\frac{1}{2}$ inches long?

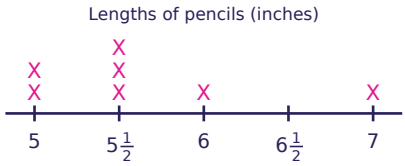

How many shells are longer than 3 inches?

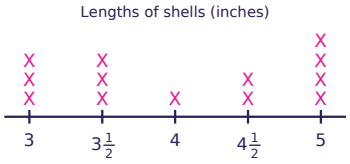

How many ribbons are $2\frac{1}{2}$ inches long?



How many ribbons were measured in all?

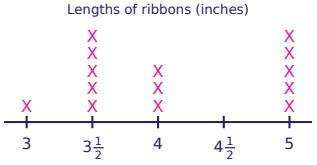

How many more leaves are 3 inches long than 4 inches long?

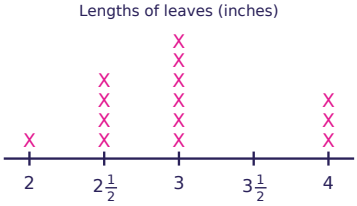

How many pencils are shorter than 5 inches?

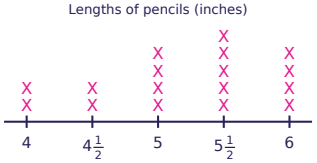

Line Plots with Halves & Fourths · 2

ANSWER

20

Line Plots with Halves & Fourths · 1

ANSWER

4

Line Plots with Halves & Fourths · 4

ANSWER

10

Line Plots with Halves & Fourths · 3

ANSWER

1

Line Plots with Halves & Fourths · 6

ANSWER

14

Line Plots with Halves & Fourths · 5

ANSWER

5

Line Plots with Halves & Fourths · 8

ANSWER

4

Line Plots with Halves & Fourths · 7

ANSWER

3

How many toy cars are 4 inches long?

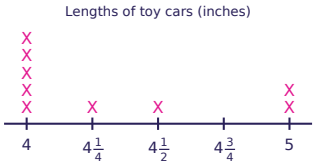

How many toy cars were measured in all?

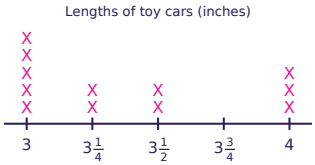

How many more crayons are 4 $\frac{1}{4}$ inches long than 4 inches long?

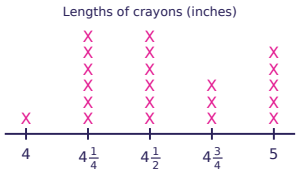

How many pencils are shorter than 3 $\frac{1}{2}$ inches?



How many leaves are 1 inches long?



How many crayons were measured in all?

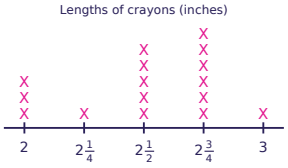

How many more crayons are 3 inches long than 3 $\frac{3}{4}$ inches long?

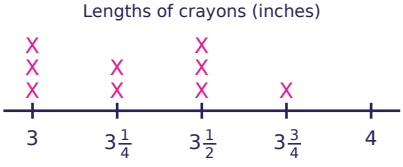

How many leaves are longer than 2 $\frac{1}{2}$ inches?

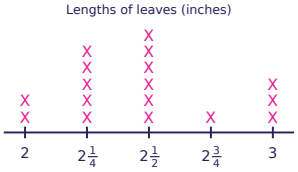

Line Plots with Halves & Fourths · 10

ANSWER

12

Line Plots with Halves & Fourths · 9

ANSWER

5

Line Plots with Halves & Fourths · 12

ANSWER

6

Line Plots with Halves & Fourths · 11

ANSWER

5

Line Plots with Halves & Fourths · 14

ANSWER

16

Line Plots with Halves & Fourths · 13

ANSWER

2

Line Plots with Halves & Fourths · 16

ANSWER

4

Line Plots with Halves & Fourths · 15

ANSWER

2

Line Plots with Halves & Fourths · 17

How many ribbons are $4\frac{3}{4}$ inches long?

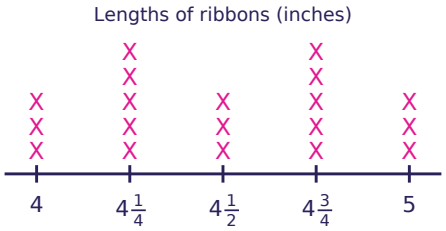

Line Plots with Halves & Fourths · 18

How many toy cars were measured in all?

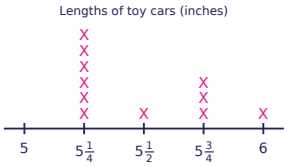

Line Plots with Halves & Fourths · 19

How many more toy cars are $3\frac{1}{2}$ inches long than $3\frac{3}{4}$ inches long?

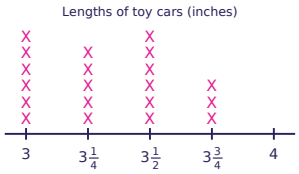

Line Plots with Halves & Fourths · 20

How many pencils are shorter than $1\frac{3}{4}$ inches?

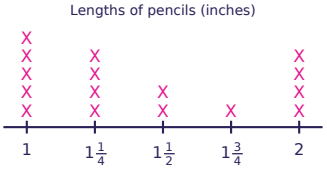

Line Plots with Halves & Fourths · 21

How many ribbons are $3\frac{1}{2}$ inches long?

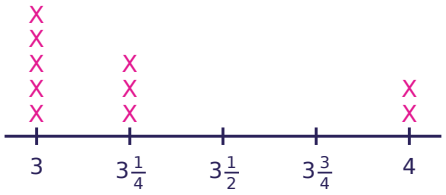

Line Plots with Halves & Fourths · 22

How many toy cars were measured in all?

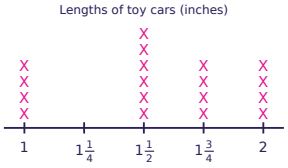

Line Plots with Halves & Fourths · 23

How many more ribbons are $3\frac{1}{4}$ inches long than 4 inches long?

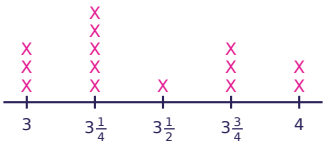

Line Plots with Halves & Fourths · 24

How many pencils are longer than 3 inches?

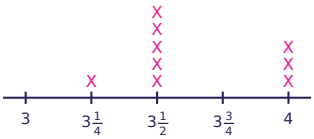

Line Plots with Halves & Fourths · 18

ANSWER

11

Line Plots with Halves & Fourths · 17

ANSWER

5

Line Plots with Halves & Fourths · 20

ANSWER

11

Line Plots with Halves & Fourths · 19

ANSWER

3

Line Plots with Halves & Fourths · 22

ANSWER

18

Line Plots with Halves & Fourths · 21

ANSWER

0

Line Plots with Halves & Fourths · 24

ANSWER

9

Line Plots with Halves & Fourths · 23

ANSWER

3