Line Plots with Halves & Fourths · 1

How many leaves are 5 inches long?

Lengths of leaves (inches)

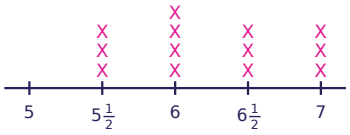

Line Plots with Halves & Fourths · 2

How many leaves were measured in all?

Lengths of leaves (inches)

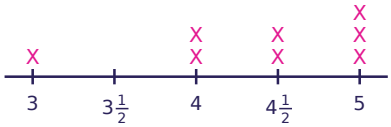

Line Plots with Halves & Fourths · 3

How many more shells are 4 inches long than 2 $\frac{1}{2}$ inches long?

Lengths of shells (inches)

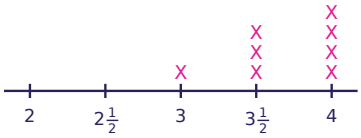

Line Plots with Halves & Fourths · 4

How many leaves are longer than 2 inches?

Lengths of leaves (inches)

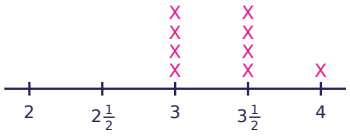

Line Plots with Halves & Fourths · 5

How many leaves are 3 $\frac{1}{2}$ inches long?

Lengths of leaves (inches)

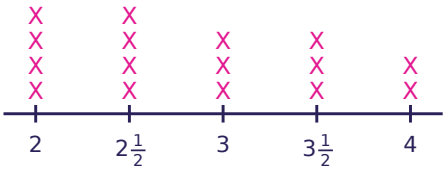

Line Plots with Halves & Fourths · 6

How many pencils were measured in all?

Lengths of pencils (inches)

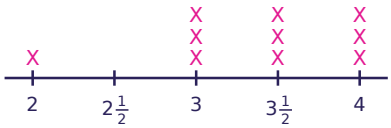

Line Plots with Halves & Fourths · 7

How many ribbons are either 4 $\frac{1}{2}$ or 5 $\frac{1}{2}$ inches long?

Lengths of ribbons (inches)

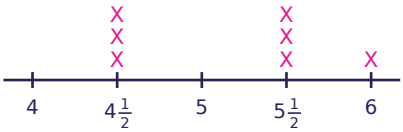

Line Plots with Halves & Fourths · 8

How many pencils are shorter than 6 inches?

Lengths of pencils (inches)

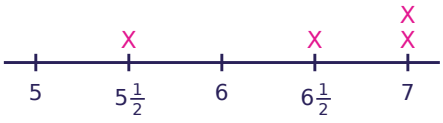

Line Plots with Halves & Fourths · 2

ANSWER

8

Line Plots with Halves & Fourths · 1

ANSWER

0

Line Plots with Halves & Fourths · 4

ANSWER

9

Line Plots with Halves & Fourths · 3

ANSWER

4

Line Plots with Halves & Fourths · 6

ANSWER

10

Line Plots with Halves & Fourths · 5

ANSWER

3

Line Plots with Halves & Fourths · 8

ANSWER

1

Line Plots with Halves & Fourths · 7

ANSWER

6

How many leaves are 5 $\frac{1}{2}$ inches long?

Lengths of leaves (inches)

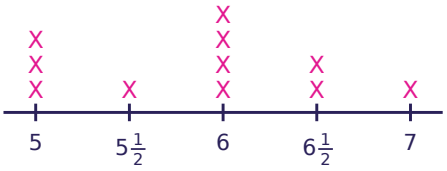

How many toy cars were measured in all?

Lengths of toy cars (inches)

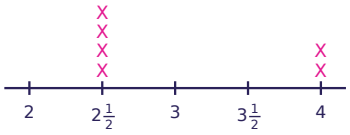

How many more ribbons are 4 inches long than 3 $\frac{1}{2}$ inches long?

Lengths of ribbons (inches)

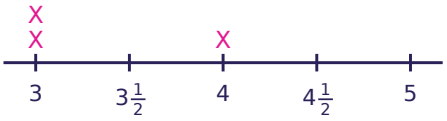

How many pencils are shorter than 2 inches?

Lengths of pencils (inches)

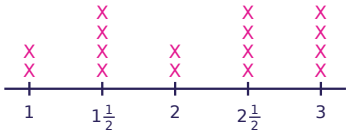

How many crayons are 4 $\frac{1}{2}$ inches long?

Lengths of crayons (inches)

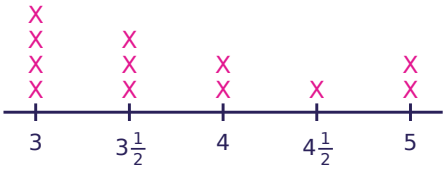

How many crayons were measured in all?

Lengths of crayons (inches)

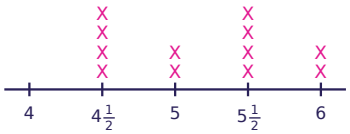

How many more pencils are 1 inches long than 2 $\frac{1}{2}$ inches long?

Lengths of pencils (inches)

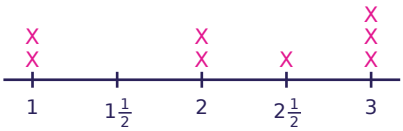

How many crayons are longer than 2 $\frac{1}{2}$ inches?

Lengths of crayons (inches)

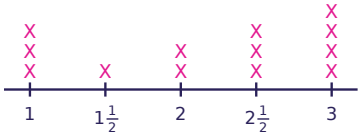

Line Plots with Halves & Fourths · 10

ANSWER

6

Line Plots with Halves & Fourths · 9

ANSWER

1

Line Plots with Halves & Fourths · 12

ANSWER

6

Line Plots with Halves & Fourths · 11

ANSWER

1

Line Plots with Halves & Fourths · 14

ANSWER

12

Line Plots with Halves & Fourths · 13

ANSWER

1

Line Plots with Halves & Fourths · 16

ANSWER

4

Line Plots with Halves & Fourths · 15

ANSWER

1

How many crayons are 4 inches long?



How many shells were measured in all?

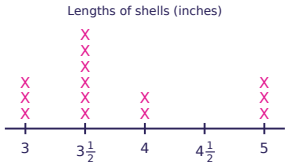

How many more ribbons are 5 inches long than $3\frac{1}{2}$ inches long?

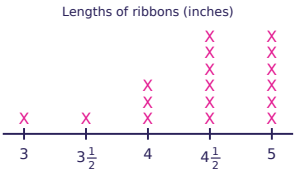

How many pencils are longer than $5\frac{1}{2}$ inches?

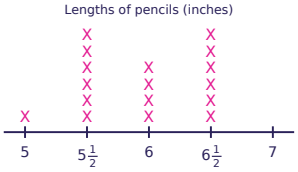

How many pencils are 6 inches long?



How many ribbons were measured in all?

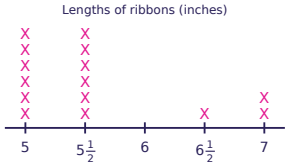

How many more leaves are 4 inches long than $5\frac{1}{2}$ inches long?



How many leaves are longer than $5\frac{1}{2}$ inches?

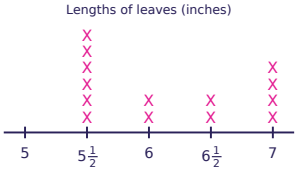

Line Plots with Halves & Fourths · 18

ANSWER

14

Line Plots with Halves & Fourths · 17

ANSWER

1

Line Plots with Halves & Fourths · 20

ANSWER

10

Line Plots with Halves & Fourths · 19

ANSWER

5

Line Plots with Halves & Fourths · 22

ANSWER

15

Line Plots with Halves & Fourths · 21

ANSWER

3

Line Plots with Halves & Fourths · 24

ANSWER

8

Line Plots with Halves & Fourths · 23

ANSWER

3