Task card 1 Halloween Math

At the Halloween party there are 3 tables. 2 people sit at each table. How many people are there?

Task card 2 Halloween Math

A pumpkin cake is cut into 6 equal slices. The family eats 1 slice. What fraction of the pumpkin cake did they eat?

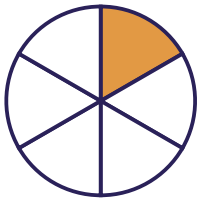

Task card 3 Halloween Math

Ava shares 36 cupcakes equally among 6 friends. How many cupcakes does each friend get?

Task card 4 Halloween Math

Ben starts trick-or-treating at 6:00. Ben walks around for 4 hours. What time does Ben get home?



Task card 5 Halloween Math

Noah starts trick-or-treating at 5:00. Noah walks around for 4 hours. What time does Noah get home?



Task card 6 Halloween Math

At the Halloween party there are 8 tables. 5 people sit at each table. How many people are there?

Task card 7 Halloween Math

Noah shares 72 spider cookies equally among 9 friends. How many spider cookies does each friend get?

Task card 8 Halloween Math

A pumpkin cake is cut into 8 equal slices. The family eats 5 slices. What fraction of the pumpkin cake did they eat?

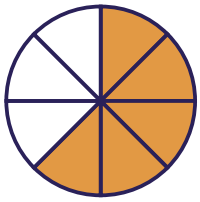

Task card 9 Halloween Math

At the Halloween party there are 2 tables. 6 people sit at each table. How many people are there?

Task card 10 Halloween Math

Noah shares 16 spider cookies equally among 4 friends. How many spider cookies does each friend get?

Task card 11 Halloween Math

A pumpkin cake is cut into 12 equal slices. The family eats 1 slice. What fraction of the pumpkin cake did they eat?



Task card 12 Halloween Math

Ella starts trick-or-treating at 4:00. Ella walks around for 2 hours. What time does Ella get home?



Task card 13 Halloween Math

At the Halloween party there are 7 tables. 2 people sit at each table. How many people are there?

Task card 14 Halloween Math

Ella shares 63 cupcakes equally among 9 friends. How many cupcakes does each friend get?

Task card 15 Halloween Math

Ava starts trick-or-treating at 6:30. Ava walks around for 4 hours. What time does Ava get home?



Task card 16 Halloween Math

A pumpkin cake is cut into 6 equal slices. The family eats 5 slices. What fraction of the pumpkin cake did they eat?

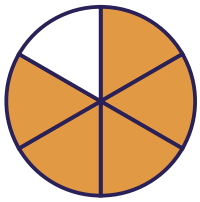

Task card 17 Halloween Math

At the Halloween party there are 6 tables. 9 people sit at each table. How many people are there?

Task card 18 Halloween Math

Zoe starts trick-or-treating at 5:30. Zoe walks around for 4 hours. What time does Zoe get home?



Task card 19 Halloween Math

Leo shares 25 pumpkin muffins equally among 5 friends. How many pumpkin muffins does each friend get?

Task card 20 Halloween Math

A pumpkin cake is cut into 8 equal slices. The family eats 1 slice. What fraction of the pumpkin cake did they eat?

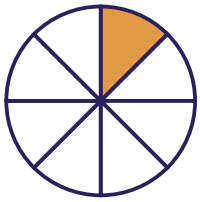

Task card 21 Halloween Math

Noah starts trick-or-treating at 6:00. Noah walks around for 5 hours. What time does Noah get home?



Task card 22 Halloween Math

Ella shares 20 pumpkin muffins equally among 5 friends. How many pumpkin muffins does each friend get?

Task card 23 Halloween Math

At the Halloween party there are 4 tables. 2 people sit at each table. How many people are there?

Task card 24 Halloween Math

At the Halloween party there are 2 tables. 8 people sit at each table. How many people are there?

Halloween Math Task Cards

Recording sheet · Grade 3 · Read each story and solve. Write times like 3:00 and fractions like 3/8.

Name: _____ Date: _____

Scan to check your answers

1	2	3	4
5	6	7	8
9	10	11	12
13	14	15	16
17	18	19	20
21	22	23	24

Halloween Math Task Cards: Answer Key

Grade 3 · Medium

The answers online

1. 6	**2.** $\frac{1}{6}$	**3.** 6
4. 10:00	**5.** 9:00	**6.** 40
7. 8	**8.** $\frac{5}{8}$	**9.** 12
10. 4	**11.** $\frac{1}{12}$	**12.** 6:00
13. 14	**14.** 7	**15.** 10:30
16. $\frac{5}{6}$	**17.** 54	**18.** 9:30
19. 5	**20.** $\frac{1}{8}$	**21.** 11:00
22. 4	**23.** 8	**24.** 16