Task card 1 Halloween Math

Ben shares 32 pumpkin muffins equally among 8 friends. How many pumpkin muffins does each friend get?

Task card 2 Halloween Math

A pumpkin cake is cut into 12 equal slices. The family eats 1 slice. What fraction of the pumpkin cake did they eat?



Task card 3 Halloween Math

Noah starts trick-or-treating at 5:30. Noah walks around for 4 hours. What time does Noah get home?



Task card 4 Halloween Math

At the Halloween party there are 9 tables. 4 people sit at each table. How many people are there?

Task card 5 Halloween Math

A pumpkin cake is cut into 12 equal slices. The family eats 11 slices. What fraction of the pumpkin cake did they eat?

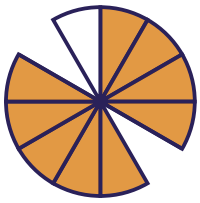

Task card 6 Halloween Math

At the Halloween party there are 8 tables. 2 people sit at each table. How many people are there?

Task card 7 Halloween Math

Ben shares 18 cupcakes equally among 3 friends. How many cupcakes does each friend get?

Task card 8 Halloween Math

Ella starts trick-or-treating at 4:00. Ella walks around for 3 hours. What time does Ella get home?



Task card 9 Halloween Math

Leo starts trick-or-treating at 6:00. Leo walks around for 2 hours. What time does Leo get home?



Task card 10 Halloween Math

Ava starts trick-or-treating at 6:30. Ava walks around for 2 hours. What time does Ava get home?



Task card 11 Halloween Math

A pumpkin cake is cut into 12 equal slices. The family eats 5 slices. What fraction of the pumpkin cake did they eat?

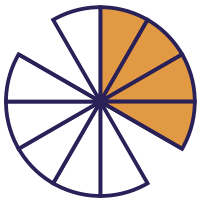

Task card 12 Halloween Math

Omar shares 48 cupcakes equally among 6 friends. How many cupcakes does each friend get?

Task card 13 Halloween Math

Omar shares 50 spider cookies equally among 5 friends. How many spider cookies does each friend get?

Task card 14 Halloween Math

At the Halloween party there are 2 tables. 4 people sit at each table. How many people are there?

Task card 15 Halloween Math

A pumpkin cake is cut into 12 equal slices. The family eats 7 slices. What fraction of the pumpkin cake did they eat?

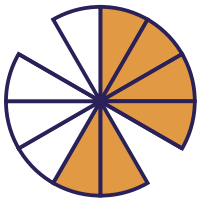

Task card 16 Halloween Math

At the Halloween party there are 7 tables. 10 people sit at each table. How many people are there?

Task card 17 Halloween Math

A pumpkin cake is cut into 10 equal slices. The family eats 7 slices. What fraction of the pumpkin cake did they eat?

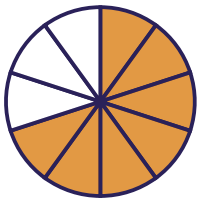

Task card 18 Halloween Math

Lily starts trick-or-treating at 6:30. Lily walks around for 3 hours. What time does Lily get home?



Task card 19 Halloween Math

At the Halloween party there are 7 tables. 7 people sit at each table. How many people are there?

Task card 20 Halloween Math

Zoe starts trick-or-treating at 6:30. Zoe walks around for 4 hours. What time does Zoe get home?



Task card 21 Halloween Math

Zoe shares 54 pumpkin muffins equally among 9 friends. How many pumpkin muffins does each friend get?

Task card 22 Halloween Math

At the Halloween party there are 5 tables. 2 people sit at each table. How many people are there?

Task card 23 Halloween Math

A pumpkin cake is cut into 6 equal slices. The family eats 1 slice. What fraction of the pumpkin cake did they eat?

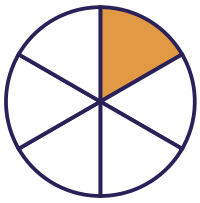

Task card 24 Halloween Math

Ella shares 12 spider cookies equally among 6 friends. How many spider cookies does each friend get?

Halloween Math Task Cards

Recording sheet · Grade 3 · Read each story and solve. Write times like 3:00 and fractions like 3/8.

Name: _____ Date: _____

Scan to check your answers

1	2	3	4
5	6	7	8
9	10	11	12
13	14	15	16
17	18	19	20
21	22	23	24

Halloween Math Task Cards: Answer Key

Grade 3 · Hard

The answers online

1. 4	**2.** $\frac{1}{12}$	**3.** 9:30
4. 36	**5.** $\frac{11}{12}$	**6.** 16
7. 6	**8.** 7:00	**9.** 8:00
10. 8:30	**11.** $\frac{5}{12}$	**12.** 8
13. 10	**14.** 8	**15.** $\frac{7}{12}$
16. 70	**17.** $\frac{7}{10}$	**18.** 9:30
19. 49	**20.** 10:30	**21.** 6
22. 10	**23.** $\frac{1}{6}$	**24.** 2