Task card 1 Halloween Math

Lily shares 9 pumpkin muffins equally among 3 friends. How many pumpkin muffins does each friend get?

Task card 2 Halloween Math

Lily starts trick-or-treating at 4:00. Lily walks around for 3 hours. What time does Lily get home?



Task card 3 Halloween Math

Lily shares 12 cupcakes equally among 4 friends. How many cupcakes does each friend get?

Task card 4 Halloween Math

Ben starts trick-or-treating at 6:00. Ben walks around for 4 hours. What time does Ben get home?



Task card 5 Halloween Math

At the Halloween party there are 9 tables. 4 people sit at each table. How many people are there?

Task card 6 Halloween Math

A pumpkin cake is cut into 8 equal slices. The family eats 1 slice. What fraction of the pumpkin cake did they eat?

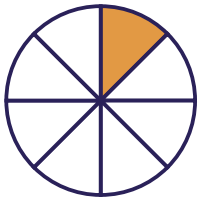

Task card 7 Halloween Math

A pumpkin cake is cut into 6 equal slices. The family eats 5 slices. What fraction of the pumpkin cake did they eat?

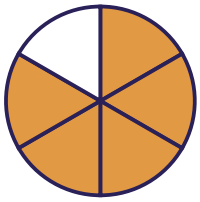

Task card 8 Halloween Math

At the Halloween party there are 6 tables. 3 people sit at each table. How many people are there?

Task card 9 Halloween Math

Zoe starts trick-or-treating at 4:00. Zoe walks around for 2 hours. What time does Zoe get home?



Task card 10 Halloween Math

A pumpkin cake is cut into 6 equal slices. The family eats 1 slice. What fraction of the pumpkin cake did they eat?

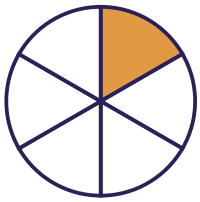

Task card 11 Halloween Math

At the Halloween party there are 3 tables. 6 people sit at each table. How many people are there?

Task card 12 Halloween Math

Mia shares 12 cupcakes equally among 2 friends. How many cupcakes does each friend get?

Task card 13 Halloween Math

Leo shares 6 cupcakes equally among 2 friends. How many cupcakes does each friend get?

Task card 14 Halloween Math

At the Halloween party there are 5 tables. 6 people sit at each table. How many people are there?

Task card 15 Halloween Math

A pumpkin cake is cut into 4 equal slices. The family eats 3 slices. What fraction of the pumpkin cake did they eat?



Task card 16 Halloween Math

Lily starts trick-or-treating at 6:00. Lily walks around for 3 hours. What time does Lily get home?



Task card 17 Halloween Math

At the Halloween party there are 3 tables. 3 people sit at each table. How many people are there?

Task card 18 Halloween Math

At the Halloween party there are 8 tables. 2 people sit at each table. How many people are there?

Task card 19 Halloween Math

Sam starts trick-or-treating at 4:00. Sam walks around for 5 hours. What time does Sam get home?



Task card 20 Halloween Math

Ella shares 20 cupcakes equally among 4 friends. How many cupcakes does each friend get?

Task card 21 Halloween Math

Leo shares 28 cupcakes equally among 7 friends. How many cupcakes does each friend get?

Task card 22 Halloween Math

A pumpkin cake is cut into 8 equal slices. The family eats 3 slices. What fraction of the pumpkin cake did they eat?

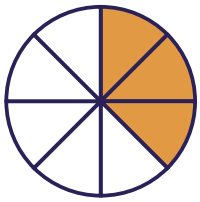

Task card 23 Halloween Math

Noah starts trick-or-treating at 6:00. Noah walks around for 4 hours. What time does Noah get home?



Task card 24 Halloween Math

Sam shares 14 spider cookies equally among 7 friends. How many spider cookies does each friend get?

Halloween Math Task Cards

Recording sheet · Grade 3 · Read each story and solve. Write times like 3:00 and fractions like 3/8.

Name: _____ Date: _____

Scan to check your answers

1	2	3	4
5	6	7	8
9	10	11	12
13	14	15	16
17	18	19	20
21	22	23	24

Halloween Math Task Cards: Answer Key

Grade 3 · Easy

The answers online

1. 3	**2.** 7:00	**3.** 3
4. 10:00	**5.** 36	**6.** $\frac{1}{8}$
7. $\frac{5}{6}$	**8.** 18	**9.** 6:00
10. $\frac{1}{6}$	**11.** 18	**12.** 6
13. 3	**14.** 30	**15.** $\frac{3}{4}$
16. 9:00	**17.** 9	**18.** 16
19. 9:00	**20.** 5	**21.** 4
22. $\frac{3}{8}$	**23.** 10:00	**24.** 2