Halloween Math · 1

At the Halloween party there are 3 tables. 2 people sit at each table. How many people are there?

Halloween Math · 2

A pumpkin cake is cut into 6 equal slices. The family eats 1 slice. What fraction of the pumpkin cake did they eat?

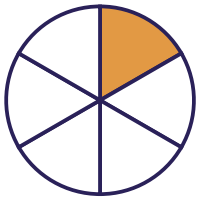

Halloween Math · 3

Ava shares 36 cupcakes equally among 6 friends. How many cupcakes does each friend get?

Halloween Math · 4

Ben starts trick-or-treating at 6:00. Ben walks around for 4 hours. What time does Ben get home?



Halloween Math · 5

Noah starts trick-or-treating at 5:00. Noah walks around for 4 hours. What time does Noah get home?



Halloween Math · 6

At the Halloween party there are 8 tables. 5 people sit at each table. How many people are there?

Halloween Math · 7

Noah shares 72 spider cookies equally among 9 friends. How many spider cookies does each friend get?

Halloween Math · 8

A pumpkin cake is cut into 8 equal slices. The family eats 5 slices. What fraction of the pumpkin cake did they eat?

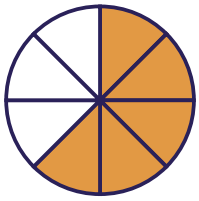

Halloween Math · 2

ANSWER

$\frac{1}{6}$

Halloween Math · 1

ANSWER

6

Halloween Math · 4

ANSWER

10:00

Halloween Math · 3

ANSWER

6

Halloween Math · 6

ANSWER

40

Halloween Math · 5

ANSWER

9:00

Halloween Math · 8

ANSWER

$\frac{5}{8}$

Halloween Math · 7

ANSWER

8

Halloween Math · 9

At the Halloween party there are 2 tables. 6 people sit at each table. How many people are there?

Halloween Math · 10

Noah shares 16 spider cookies equally among 4 friends. How many spider cookies does each friend get?

Halloween Math · 11

A pumpkin cake is cut into 12 equal slices. The family eats 1 slice. What fraction of the pumpkin cake did they eat?



Halloween Math · 12

Ella starts trick-or-treating at 4:00. Ella walks around for 2 hours. What time does Ella get home?



Halloween Math · 13

At the Halloween party there are 7 tables. 2 people sit at each table. How many people are there?

Halloween Math · 14

Ella shares 63 cupcakes equally among 9 friends. How many cupcakes does each friend get?

Halloween Math · 15

Ava starts trick-or-treating at 6:30. Ava walks around for 4 hours. What time does Ava get home?



Halloween Math · 16

A pumpkin cake is cut into 6 equal slices. The family eats 5 slices. What fraction of the pumpkin cake did they eat?

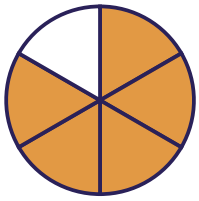

Halloween Math · 10

ANSWER

4

Halloween Math · 9

ANSWER

12

Halloween Math · 12

ANSWER

6:00

Halloween Math · 11

ANSWER

$$\frac{1}{12}$$

Halloween Math · 14

ANSWER

7

Halloween Math · 13

ANSWER

14

Halloween Math · 16

ANSWER

$$\frac{5}{6}$$

Halloween Math · 15

ANSWER

10:30

Halloween Math · 17

At the Halloween party there are 6 tables. 9 people sit at each table. How many people are there?

Halloween Math · 18

Zoe starts trick-or-treating at 5:30. Zoe walks around for 4 hours. What time does Zoe get home?



Halloween Math · 19

Leo shares 25 pumpkin muffins equally among 5 friends. How many pumpkin muffins does each friend get?

Halloween Math · 20

A pumpkin cake is cut into 8 equal slices. The family eats 1 slice. What fraction of the pumpkin cake did they eat?

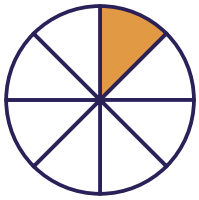

Halloween Math · 21

Noah starts trick-or-treating at 6:00. Noah walks around for 5 hours. What time does Noah get home?



Halloween Math · 22

Ella shares 20 pumpkin muffins equally among 5 friends. How many pumpkin muffins does each friend get?

Halloween Math · 23

At the Halloween party there are 4 tables. 2 people sit at each table. How many people are there?

Halloween Math · 24

At the Halloween party there are 2 tables. 8 people sit at each table. How many people are there?

Halloween Math · 18

ANSWER

9:30

Halloween Math · 17

ANSWER

54

Halloween Math · 20

ANSWER

$$\frac{1}{8}$$

Halloween Math · 19

ANSWER

5

Halloween Math · 22

ANSWER

4

Halloween Math · 21

ANSWER

11:00

Halloween Math · 24

ANSWER

16

Halloween Math · 23

ANSWER

8