Halloween Math · 1

Ben shares 32 pumpkin muffins equally among 8 friends. How many pumpkin muffins does each friend get?

Halloween Math · 2

A pumpkin cake is cut into 12 equal slices. The family eats 1 slice. What fraction of the pumpkin cake did they eat?



Halloween Math · 3

Noah starts trick-or-treating at 5:30. Noah walks around for 4 hours. What time does Noah get home?



Halloween Math · 4

At the Halloween party there are 9 tables. 4 people sit at each table. How many people are there?

Halloween Math · 5

A pumpkin cake is cut into 12 equal slices. The family eats 11 slices. What fraction of the pumpkin cake did they eat?

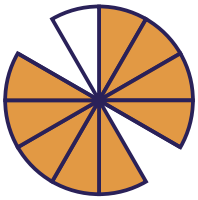

Halloween Math · 6

At the Halloween party there are 8 tables. 2 people sit at each table. How many people are there?

Halloween Math · 7

Ben shares 18 cupcakes equally among 3 friends. How many cupcakes does each friend get?

Halloween Math · 8

Ella starts trick-or-treating at 4:00. Ella walks around for 3 hours. What time does Ella get home?



Halloween Math · 2

ANSWER

$\frac{1}{12}$

Halloween Math · 1

ANSWER

4

Halloween Math · 4

ANSWER

36

Halloween Math · 3

ANSWER

9:30

Halloween Math · 6

ANSWER

16

Halloween Math · 5

ANSWER

$\frac{11}{12}$

Halloween Math · 8

ANSWER

7:00

Halloween Math · 7

ANSWER

6

Halloween Math · 9

Leo starts trick-or-treating at 6:00. Leo walks around for 2 hours. What time does Leo get home?



Halloween Math · 10

Ava starts trick-or-treating at 6:30. Ava walks around for 2 hours. What time does Ava get home?



Halloween Math · 11

A pumpkin cake is cut into 12 equal slices. The family eats 5 slices. What fraction of the pumpkin cake did they eat?

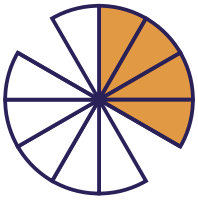

Halloween Math · 12

Omar shares 48 cupcakes equally among 6 friends. How many cupcakes does each friend get?

Halloween Math · 13

Omar shares 50 spider cookies equally among 5 friends. How many spider cookies does each friend get?

Halloween Math · 14

At the Halloween party there are 2 tables. 4 people sit at each table. How many people are there?

Halloween Math · 15

A pumpkin cake is cut into 12 equal slices. The family eats 7 slices. What fraction of the pumpkin cake did they eat?

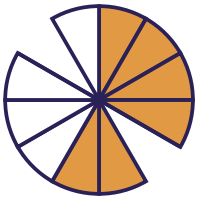

Halloween Math · 16

At the Halloween party there are 7 tables. 10 people sit at each table. How many people are there?

Halloween Math · 10

ANSWER

8:30

Halloween Math · 9

ANSWER

8:00

Halloween Math · 12

ANSWER

8

Halloween Math · 11

ANSWER

$$\frac{5}{12}$$

Halloween Math · 14

ANSWER

8

Halloween Math · 13

ANSWER

10

Halloween Math · 16

ANSWER

70

Halloween Math · 15

ANSWER

$$\frac{7}{12}$$

Halloween Math · 17

A pumpkin cake is cut into 10 equal slices. The family eats 7 slices. What fraction of the pumpkin cake did they eat?

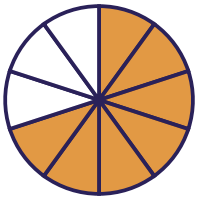

Halloween Math · 18

Lily starts trick-or-treating at 6:30. Lily walks around for 3 hours. What time does Lily get home?



Halloween Math · 19

At the Halloween party there are 7 tables. 7 people sit at each table. How many people are there?

Halloween Math · 20

Zoe starts trick-or-treating at 6:30. Zoe walks around for 4 hours. What time does Zoe get home?



Halloween Math · 21

Zoe shares 54 pumpkin muffins equally among 9 friends. How many pumpkin muffins does each friend get?

Halloween Math · 22

At the Halloween party there are 5 tables. 2 people sit at each table. How many people are there?

Halloween Math · 23

A pumpkin cake is cut into 6 equal slices. The family eats 1 slice. What fraction of the pumpkin cake did they eat?

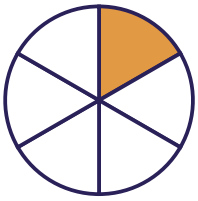

Halloween Math · 24

Ella shares 12 spider cookies equally among 6 friends. How many spider cookies does each friend get?

Halloween Math · 18

ANSWER

9:30

Halloween Math · 17

ANSWER

$$\frac{7}{10}$$

Halloween Math · 20

ANSWER

10:30

Halloween Math · 19

ANSWER

49

Halloween Math · 22

ANSWER

10

Halloween Math · 21

ANSWER

6

Halloween Math · 24

ANSWER

2

Halloween Math · 23

ANSWER

$$\frac{1}{6}$$