Halloween Math · 1

Lily shares 9 pumpkin muffins equally among 3 friends. How many pumpkin muffins does each friend get?

Halloween Math · 2

Lily starts trick-or-treating at 4:00. Lily walks around for 3 hours. What time does Lily get home?



Halloween Math · 3

Lily shares 12 cupcakes equally among 4 friends. How many cupcakes does each friend get?

Halloween Math · 4

Ben starts trick-or-treating at 6:00. Ben walks around for 4 hours. What time does Ben get home?



Halloween Math · 5

At the Halloween party there are 9 tables. 4 people sit at each table. How many people are there?

Halloween Math · 6

A pumpkin cake is cut into 8 equal slices. The family eats 1 slice. What fraction of the pumpkin cake did they eat?

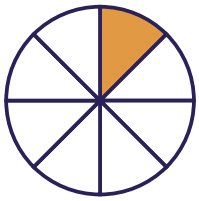

Halloween Math · 7

A pumpkin cake is cut into 6 equal slices. The family eats 5 slices. What fraction of the pumpkin cake did they eat?

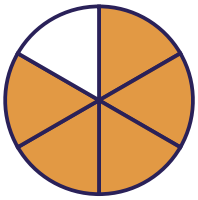

Halloween Math · 8

At the Halloween party there are 6 tables. 3 people sit at each table. How many people are there?

Halloween Math · 2

ANSWER

7:00

Halloween Math · 1

ANSWER

3

Halloween Math · 4

ANSWER

10:00

Halloween Math · 3

ANSWER

3

Halloween Math · 6

ANSWER

$\frac{1}{8}$

Halloween Math · 5

ANSWER

36

Halloween Math · 8

ANSWER

18

Halloween Math · 7

ANSWER

$\frac{5}{6}$

Halloween Math · 9

Zoe starts trick-or-treating at 4:00. Zoe walks around for 2 hours. What time does Zoe get home?



Halloween Math · 10

A pumpkin cake is cut into 6 equal slices. The family eats 1 slice. What fraction of the pumpkin cake did they eat?

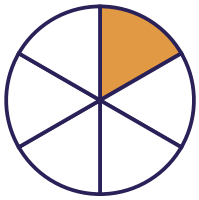

Halloween Math · 11

At the Halloween party there are 3 tables. 6 people sit at each table. How many people are there?

Halloween Math · 12

Mia shares 12 cupcakes equally among 2 friends. How many cupcakes does each friend get?

Halloween Math · 13

Leo shares 6 cupcakes equally among 2 friends. How many cupcakes does each friend get?

Halloween Math · 14

At the Halloween party there are 5 tables. 6 people sit at each table. How many people are there?

Halloween Math · 15

A pumpkin cake is cut into 4 equal slices. The family eats 3 slices. What fraction of the pumpkin cake did they eat?



Halloween Math · 16

Lily starts trick-or-treating at 6:00. Lily walks around for 3 hours. What time does Lily get home?



Halloween Math · 10

ANSWER

$\frac{1}{6}$

Halloween Math · 9

ANSWER

6:00

Halloween Math · 12

ANSWER

6

Halloween Math · 11

ANSWER

18

Halloween Math · 14

ANSWER

30

Halloween Math · 13

ANSWER

3

Halloween Math · 16

ANSWER

9:00

Halloween Math · 15

ANSWER

$\frac{3}{4}$

Halloween Math · 17

At the Halloween party there are 3 tables. 3 people sit at each table. How many people are there?

Halloween Math · 18

At the Halloween party there are 8 tables. 2 people sit at each table. How many people are there?

Halloween Math · 19

Sam starts trick-or-treating at 4:00. Sam walks around for 5 hours. What time does Sam get home?



Halloween Math · 20

Ella shares 20 cupcakes equally among 4 friends. How many cupcakes does each friend get?

Halloween Math · 21

Leo shares 28 cupcakes equally among 7 friends. How many cupcakes does each friend get?

Halloween Math · 22

A pumpkin cake is cut into 8 equal slices. The family eats 3 slices. What fraction of the pumpkin cake did they eat?

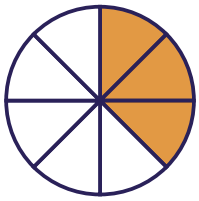

Halloween Math · 23

Noah starts trick-or-treating at 6:00. Noah walks around for 4 hours. What time does Noah get home?



Halloween Math · 24

Sam shares 14 spider cookies equally among 7 friends. How many spider cookies does each friend get?

Halloween Math · 18

ANSWER

16

Halloween Math · 17

ANSWER

9

Halloween Math · 20

ANSWER

5

Halloween Math · 19

ANSWER

9:00

Halloween Math · 22

ANSWER

$$\frac{3}{8}$$

Halloween Math · 21

ANSWER

4

Halloween Math · 24

ANSWER

2

Halloween Math · 23

ANSWER

10:00