Task card 1 Classifying Polygons

What is the name of a polygon with 6 sides?

Task card 2 Classifying Polygons

What is the name of a polygon with 3 sides?

Task card 3 Classifying Polygons

What is the name of a polygon with 8 sides?

Task card 4 Classifying Polygons

Count the sides. What is the name of this polygon?

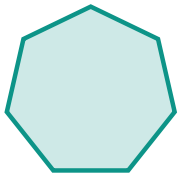

Task card 5 Classifying Polygons

How many sides does this polygon have?



Task card 6 Classifying Polygons

How many sides does a quadrilateral have?

Task card 7 Classifying Polygons

How many corners does a hexagon have?

Task card 8 Classifying Polygons

Which polygon has more sides: a quadrilateral or an octagon?

Task card 9 Classifying Polygons

What is the name of a polygon with 5 sides?

Task card 10 Classifying Polygons

What is the name of a polygon with 4 sides?

Task card 11 Classifying Polygons

Count the sides. What is the name of this polygon?



Task card 12 Classifying Polygons

How many sides does this polygon have?



Task card 13 Classifying Polygons

How many sides does a heptagon have?

Task card 14 Classifying Polygons

Which polygon has fewer sides: an octagon or a triangle?

Task card 15 Classifying Polygons

How many sides does this polygon have?

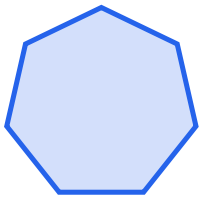

Task card 16 Classifying Polygons

How many sides does a hexagon have?

Task card 17 Classifying Polygons

How many corners does a triangle have?

Task card 18 Classifying Polygons

Which polygon has more sides: a heptagon or a quadrilateral?

Task card 19 Classifying Polygons

What is the name of a polygon with 7 sides?

Task card 20 Classifying Polygons

Count the sides. What is the name of this polygon?



Task card 21 Classifying Polygons

How many sides does this polygon have?



Task card 22 Classifying Polygons

How many corners does a pentagon have?

Task card 23 Classifying Polygons

Which polygon has more sides: a quadrilateral or a hexagon?

Task card 24 Classifying Polygons

Count the sides. What is the name of this polygon?



Classifying Polygons Task Cards

Recording sheet · Grade 3 · A polygon is named for its number of sides. Write the name of the polygon, or the number that is asked for.

Name: _____ Date: _____

Scan to check your answers

1	2	3	4
5	6	7	8
9	10	11	12
13	14	15	16
17	18	19	20
21	22	23	24

Classifying Polygons Task Cards: Answer Key

Grade 3 · Easy

The answers online

1. hexagon	**2.** triangle	**3.** octagon
4. heptagon	**5.** 5	**6.** 4
7. 6	**8.** octagon	**9.** pentagon
10. quadrilateral	**11.** triangle	**12.** 8
13. 7	**14.** triangle	**15.** 7
16. 6	**17.** 3	**18.** heptagon
19. heptagon	**20.** quadrilateral	**21.** 5
22. 5	**23.** hexagon	**24.** hexagon