Classifying Polygons · 1

What is the name of a polygon with 7 sides?

Classifying Polygons · 2

How many sides does a pentagon have?

Classifying Polygons · 3

Count the sides. What is the name of this polygon?



Classifying Polygons · 4

How many sides does this polygon have?

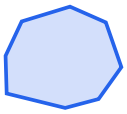

Classifying Polygons · 5

A polygon has 3 corners. What is its name?

Classifying Polygons · 6

How many corners does a hexagon have?

Classifying Polygons · 7

Which polygon has more sides: a triangle or an octagon?

Classifying Polygons · 8

How many sides do a quadrilateral and a hexagon have in all?

Classifying Polygons · 2

ANSWER

5

Classifying Polygons · 1

ANSWER

heptagon

Classifying Polygons · 4

ANSWER

8

Classifying Polygons · 3

ANSWER

quadrilateral

Classifying Polygons · 6

ANSWER

6

Classifying Polygons · 5

ANSWER

triangle

Classifying Polygons · 8

ANSWER

10

Classifying Polygons · 7

ANSWER

octagon

Classifying Polygons · 9

What is the name of a polygon with 5 sides?

Classifying Polygons · 10

How many sides does a hexagon have?

Classifying Polygons · 11

Count the sides. What is the name of this polygon?



Classifying Polygons · 12

How many sides does this polygon have?

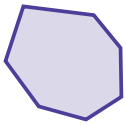

Classifying Polygons · 13

A polygon has 8 corners. What is its name?

Classifying Polygons · 14

How many corners does a quadrilateral have?

Classifying Polygons · 15

Which polygon has more sides: a pentagon or a quadrilateral?

Classifying Polygons · 16

How many sides do a heptagon and a hexagon have in all?

Classifying Polygons · 10

ANSWER

6

Classifying Polygons · 9

ANSWER

pentagon

Classifying Polygons · 12

ANSWER

7

Classifying Polygons · 11

ANSWER

triangle

Classifying Polygons · 14

ANSWER

4

Classifying Polygons · 13

ANSWER

octagon

Classifying Polygons · 16

ANSWER

13

Classifying Polygons · 15

ANSWER

pentagon

Classifying Polygons · 17

How many sides does a quadrilateral have?

Classifying Polygons · 18

Count the sides. What is the name of this polygon?

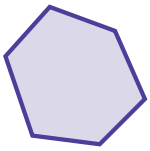

Classifying Polygons · 19

How many sides does this polygon have?

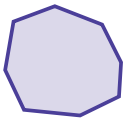

Classifying Polygons · 20

How many corners does a pentagon have?

Classifying Polygons · 21

Which polygon has more sides: a triangle or a heptagon?

Classifying Polygons · 22

How many sides do a pentagon and a hexagon have in all?

Classifying Polygons · 23

What is the name of a polygon with 8 sides?

Classifying Polygons · 24

Count the sides. What is the name of this polygon?



Classifying Polygons · 18

ANSWER

hexagon

Classifying Polygons · 17

ANSWER

4

Classifying Polygons · 20

ANSWER

5

Classifying Polygons · 19

ANSWER

8

Classifying Polygons · 22

ANSWER

11

Classifying Polygons · 21

ANSWER

heptagon

Classifying Polygons · 24

ANSWER

heptagon

Classifying Polygons · 23

ANSWER

octagon