Classifying Polygons · 1

What is the name of a polygon with 7 sides?

Classifying Polygons · 2

What is the name of a polygon with 3 sides?

Classifying Polygons · 3

Count the sides. What is the name of this polygon?

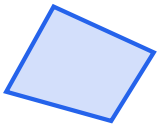

Classifying Polygons · 4

Count the sides. What is the name of this polygon?

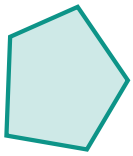

Classifying Polygons · 5

How many sides does this polygon have?

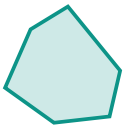

Classifying Polygons · 6

How many sides does an octagon have?

Classifying Polygons · 7

A polygon has 7 corners. What is its name?

Classifying Polygons · 8

How many sides do a triangle and a pentagon have in all?

Classifying Polygons · 2

ANSWER

triangle

Classifying Polygons · 1

ANSWER

heptagon

Classifying Polygons · 4

ANSWER

pentagon

Classifying Polygons · 3

ANSWER

quadrilateral

Classifying Polygons · 6

ANSWER

8

Classifying Polygons · 5

ANSWER

6

Classifying Polygons · 8

ANSWER

8

Classifying Polygons · 7

ANSWER

heptagon

Classifying Polygons · 9

What is the name of a polygon with 4 sides?

Classifying Polygons · 10

What is the name of a polygon with 6 sides?

Classifying Polygons · 11

Count the sides. What is the name of this polygon?

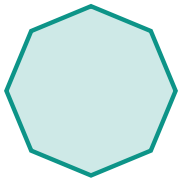

Classifying Polygons · 12

Count the sides. What is the name of this polygon?



Classifying Polygons · 13

How many sides does this polygon have?

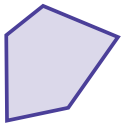

Classifying Polygons · 14

How many sides does a heptagon have?

Classifying Polygons · 15

A polygon has 6 corners. What is its name?

Classifying Polygons · 16

How many sides do a quadrilateral and a heptagon have in all?

Classifying Polygons · 10

ANSWER

hexagon

Classifying Polygons · 9

ANSWER

quadrilateral

Classifying Polygons · 12

ANSWER

triangle

Classifying Polygons · 11

ANSWER

octagon

Classifying Polygons · 14

ANSWER

7

Classifying Polygons · 13

ANSWER

5

Classifying Polygons · 16

ANSWER

11

Classifying Polygons · 15

ANSWER

hexagon

Classifying Polygons · 17

Count the sides. What is the name of this polygon?



Classifying Polygons · 18

How many sides does this polygon have?



Classifying Polygons · 19

A polygon has 8 corners. What is its name?

Classifying Polygons · 20

How many corners does a pentagon have?

Classifying Polygons · 21

Which polygon has fewer sides: a pentagon or a heptagon?

Classifying Polygons · 22

How many sides do a quadrilateral and a hexagon have in all?

Classifying Polygons · 23

Count the sides. What is the name of this polygon?

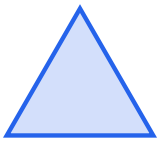

Classifying Polygons · 24

Count the sides. What is the name of this polygon?

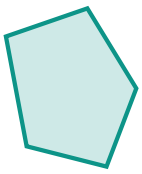

Classifying Polygons · 18

ANSWER

6

Classifying Polygons · 17

ANSWER

quadrilateral

Classifying Polygons · 20

ANSWER

5

Classifying Polygons · 19

ANSWER

octagon

Classifying Polygons · 22

ANSWER

10

Classifying Polygons · 21

ANSWER

pentagon

Classifying Polygons · 24

ANSWER

pentagon

Classifying Polygons · 23

ANSWER

triangle