Classifying Polygons · 1

What is the name of a polygon with 6 sides?

Classifying Polygons · 2

What is the name of a polygon with 3 sides?

Classifying Polygons · 3

What is the name of a polygon with 8 sides?

Classifying Polygons · 4

Count the sides. What is the name of this polygon?

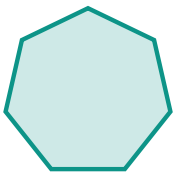

Classifying Polygons · 5

How many sides does this polygon have?



Classifying Polygons · 6

How many sides does a quadrilateral have?

Classifying Polygons · 7

How many corners does a hexagon have?

Classifying Polygons · 8

Which polygon has more sides: a quadrilateral or an octagon?

Classifying Polygons · 2

ANSWER

triangle

Classifying Polygons · 1

ANSWER

hexagon

Classifying Polygons · 4

ANSWER

heptagon

Classifying Polygons · 3

ANSWER

octagon

Classifying Polygons · 6

ANSWER

4

Classifying Polygons · 5

ANSWER

5

Classifying Polygons · 8

ANSWER

octagon

Classifying Polygons · 7

ANSWER

6

Classifying Polygons · 9

What is the name of a polygon with 5 sides?

Classifying Polygons · 10

What is the name of a polygon with 4 sides?

Classifying Polygons · 11

Count the sides. What is the name of this polygon?

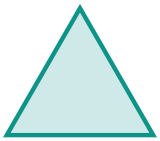

Classifying Polygons · 12

How many sides does this polygon have?



Classifying Polygons · 13

How many sides does a heptagon have?

Classifying Polygons · 14

Which polygon has fewer sides: an octagon or a triangle?

Classifying Polygons · 15

How many sides does this polygon have?

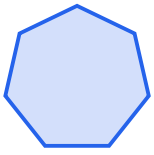

Classifying Polygons · 16

How many sides does a hexagon have?

Classifying Polygons · 10

ANSWER

quadrilateral

Classifying Polygons · 9

ANSWER

pentagon

Classifying Polygons · 12

ANSWER

8

Classifying Polygons · 11

ANSWER

triangle

Classifying Polygons · 14

ANSWER

triangle

Classifying Polygons · 13

ANSWER

7

Classifying Polygons · 16

ANSWER

6

Classifying Polygons · 15

ANSWER

7

Classifying Polygons · 17

How many corners does a triangle have?

Classifying Polygons · 18

Which polygon has more sides: a heptagon or a quadrilateral?

Classifying Polygons · 19

What is the name of a polygon with 7 sides?

Classifying Polygons · 20

Count the sides. What is the name of this polygon?



Classifying Polygons · 21

How many sides does this polygon have?



Classifying Polygons · 22

How many corners does a pentagon have?

Classifying Polygons · 23

Which polygon has more sides: a quadrilateral or a hexagon?

Classifying Polygons · 24

Count the sides. What is the name of this polygon?



Classifying Polygons · 18

ANSWER

heptagon

Classifying Polygons · 17

ANSWER

3

Classifying Polygons · 20

ANSWER

quadrilateral

Classifying Polygons · 19

ANSWER

heptagon

Classifying Polygons · 22

ANSWER

5

Classifying Polygons · 21

ANSWER

5

Classifying Polygons · 24

ANSWER

hexagon

Classifying Polygons · 23

ANSWER

hexagon