Task card 1 Fractions on a Number Line

Point A is at $\frac{__}{6}$. What is the missing numerator?



Task card 2 Fractions on a Number Line

Which point is at $\frac{4}{6}$? Write A, B or C.

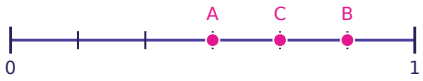

Task card 3 Fractions on a Number Line

Point A is at $\frac{__}{2}$. What is the missing numerator?

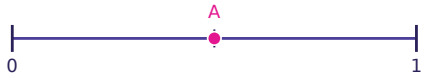

Task card 4 Fractions on a Number Line

The space from 0 to 1 is split into equal parts. What fraction names the length of one part?



Task card 5 Fractions on a Number Line

Point A is at $\frac{__}{3}$. What is the missing numerator?



Task card 6 Fractions on a Number Line

Which point is at $\frac{2}{4}$? Write A, B or C.

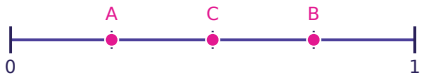

Task card 7 Fractions on a Number Line

Point A is at $\frac{\quad}{6}$. What is the missing numerator?



Task card 8 Fractions on a Number Line

Which point is at $\frac{5}{6}$? Write A, B or C.

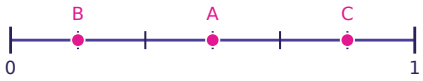

Task card 9 Fractions on a Number Line

Point A is at $\frac{\quad}{2}$. What is the missing numerator?

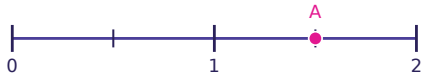

Task card 10 Fractions on a Number Line

Which point is at $\frac{5}{6}$? Write A, B or C.

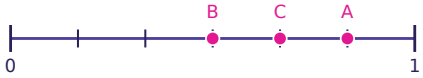

Task card 11 Fractions on a Number Line

Point A is at $\frac{\quad}{6}$. What is the missing numerator?



Task card 12 Fractions on a Number Line

The space from 0 to 1 is split into equal parts. What fraction names the length of one part?



Task card 13 Fractions on a Number Line

Point A is at $\frac{\quad}{8}$. What is the missing numerator?



Task card 14 Fractions on a Number Line

Which point is at $\frac{13}{8}$? Write A, B or C.



Task card 15 Fractions on a Number Line

Which point is at $\frac{5}{8}$? Write A, B or C.

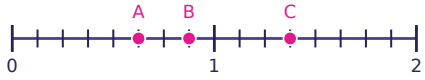

Task card 16 Fractions on a Number Line

Point A is at $\frac{\quad}{4}$. What is the missing numerator?

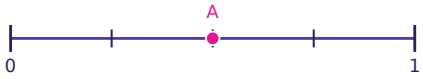

Task card 17 Fractions on a Number Line

Which point is at $\frac{5}{8}$? Write A, B or C.



Task card 18 Fractions on a Number Line

Point A is at $\frac{\quad}{4}$. What is the missing numerator?

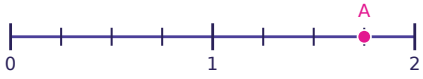

Task card 19 Fractions on a Number Line

The space from 0 to 1 is split into equal parts. What fraction names the length of one part?



Task card 20 Fractions on a Number Line

Point A is at $\frac{\quad}{3}$. What is the missing numerator?



Task card 21 Fractions on a Number Line

Which point is at $\frac{2}{4}$? Write A, B or C.

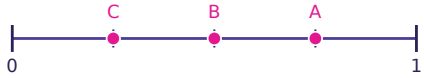

Task card 22 Fractions on a Number Line

Point A is at $\frac{\quad}{6}$. What is the missing numerator?



Task card 23 Fractions on a Number Line

Which point is at $\frac{3}{4}$? Write A, B or C.

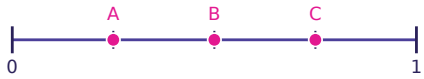

Task card 24 Fractions on a Number Line

Which point is at $\frac{2}{4}$? Write A, B or C.

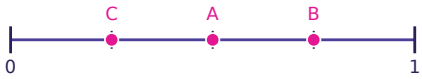

Fractions on a Number Line Task Cards

Recording sheet · Grade 3 · Use the number line to answer each question.

Name: _____ Date: _____

Scan to check your answers

1	2	3	4
5	6	7	8
9	10	11	12
13	14	15	16
17	18	19	20
21	22	23	24

Fractions on a Number Line Task Cards: Answer Key

Grade 3 · Medium

The answers online

1. 4	**2.** C	**3.** 1
4. $\frac{1}{6}$	**5.** 2	**6.** C
7. 1	**8.** C	**9.** 3
10. A	**11.** 5	**12.** $\frac{1}{3}$
13. 7	**14.** B	**15.** A
16. 2	**17.** C	**18.** 7
19. $\frac{1}{8}$	**20.** 1	**21.** B
22. 2	**23.** C	**24.** A