Fractions on a Number Line · 1

Point A is at $\frac{__}{2}$. What is the missing numerator?

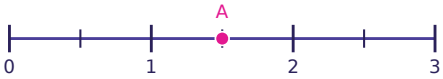

Fractions on a Number Line · 2

Which point is at $\frac{3}{4}$? Write A, B or C.



Fractions on a Number Line · 3

Point A is at $\frac{__}{8}$. What is the missing numerator?



Fractions on a Number Line · 4

The space from 0 to 1 is split into equal parts. What fraction names the length of one part?



Fractions on a Number Line · 5

Point A is at $\frac{__}{3}$. What is the missing numerator?

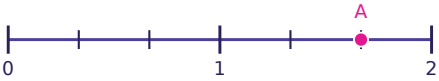

Fractions on a Number Line · 6

Which point is at $\frac{3}{4}$? Write A, B or C.



Fractions on a Number Line · 7

Point A is at $\frac{__}{8}$. What is the missing numerator?



Fractions on a Number Line · 8

Which point is at $\frac{5}{2}$? Write A, B or C.

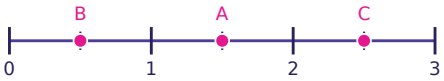

Fractions on a Number Line · 2

ANSWER

A

Fractions on a Number Line · 1

ANSWER

3

Fractions on a Number Line · 4

ANSWER

$\frac{1}{6}$

Fractions on a Number Line · 3

ANSWER

12

Fractions on a Number Line · 6

ANSWER

A

Fractions on a Number Line · 5

ANSWER

5

Fractions on a Number Line · 8

ANSWER

C

Fractions on a Number Line · 7

ANSWER

10

Point A is at $\frac{\quad}{4}$. What is the missing numerator?

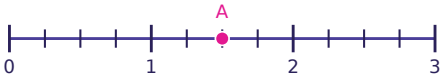

Which point is at $\frac{5}{4}$? Write A, B or C.

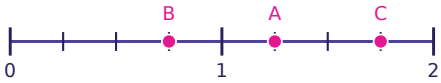

The space from 0 to 1 is split into equal parts. What fraction names the length of one part?



Point A is at $\frac{\quad}{3}$. What is the missing numerator?



Which point is at $\frac{3}{4}$? Write A, B or C.

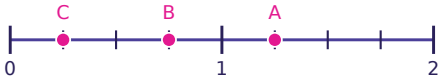

Point A is at $\frac{\quad}{2}$. What is the missing numerator?



Which point is at $\frac{11}{8}$? Write A, B or C.

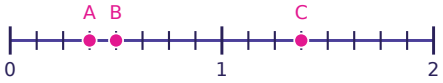

Point A is at $\frac{\quad}{3}$. What is the missing numerator?

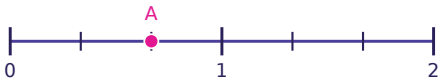

Fractions on a Number Line · 10

ANSWER

A

Fractions on a Number Line · 9

ANSWER

6

Fractions on a Number Line · 12

ANSWER

8

Fractions on a Number Line · 11

ANSWER

$$\frac{1}{2}$$

Fractions on a Number Line · 14

ANSWER

5

Fractions on a Number Line · 13

ANSWER

B

Fractions on a Number Line · 16

ANSWER

2

Fractions on a Number Line · 15

ANSWER

C

Fractions on a Number Line · 17

Which point is at $\frac{1}{8}$? Write A, B or C.

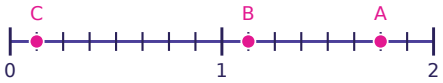

Fractions on a Number Line · 18

Point A is at $\frac{\quad}{3}$. What is the missing numerator?

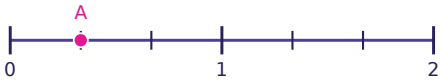

Fractions on a Number Line · 19

The space from 0 to 1 is split into equal parts. What fraction names the length of one part?



Fractions on a Number Line · 20

Point A is at $\frac{\quad}{3}$. What is the missing numerator?



Fractions on a Number Line · 21

Which point is at $\frac{1}{2}$? Write A, B or C.

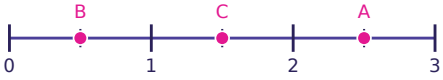

Fractions on a Number Line · 22

Point A is at $\frac{\quad}{2}$. What is the missing numerator?

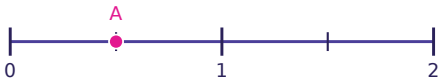

Fractions on a Number Line · 23

Which point is at $\frac{2}{4}$? Write A, B or C.

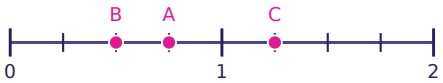

Fractions on a Number Line · 24

Point A is at $\frac{\quad}{6}$. What is the missing numerator?



Fractions on a Number Line · 18

ANSWER

1

Fractions on a Number Line · 17

ANSWER

C

Fractions on a Number Line · 20

ANSWER

5

Fractions on a Number Line · 19

ANSWER

$\frac{1}{8}$

Fractions on a Number Line · 22

ANSWER

1

Fractions on a Number Line · 21

ANSWER

B

Fractions on a Number Line · 24

ANSWER

4

Fractions on a Number Line · 23

ANSWER

B