Task card 1 Fractions Basics (Mixed Review)

What fraction of the bar is shaded?



Task card 2 Fractions Basics (Mixed Review)

Compare: $\frac{1}{2}$ ___ $\frac{1}{2}$ (use <, >, or =)

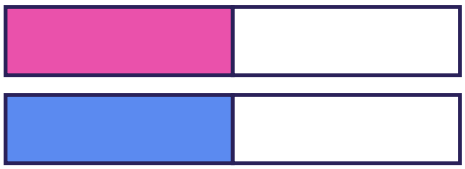

Task card 3 Fractions Basics (Mixed Review)

What fraction of the bar is shaded?



Task card 4 Fractions Basics (Mixed Review)

Compare: $\frac{1}{3}$ ___ $\frac{1}{3}$ (use <, >, or =)

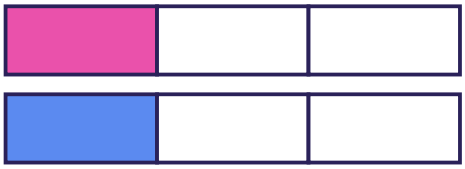

Task card 5 Fractions Basics (Mixed Review)

What fraction of the bar is shaded?



Task card 6 Fractions Basics (Mixed Review)

Compare: $\frac{2}{3}$ ___ $\frac{2}{3}$ (use <, >, or =)

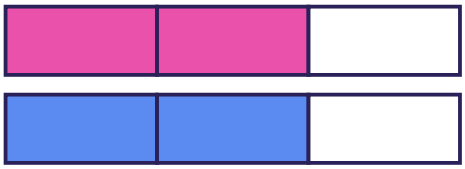

Task card 7 Fractions Basics (Mixed Review)

What fraction of the bar is shaded?



Task card 8 Fractions Basics (Mixed Review)

Compare: $\frac{3}{5}$ ___ $\frac{1}{5}$ (use <, >, or =)

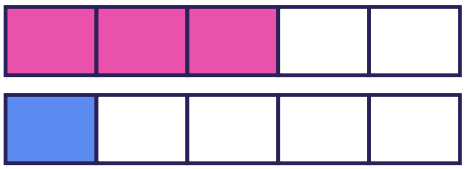

Task card 9 Fractions Basics (Mixed Review)

Compare: $\frac{1}{5}$ ___ $\frac{1}{5}$ (use <, >, or =)

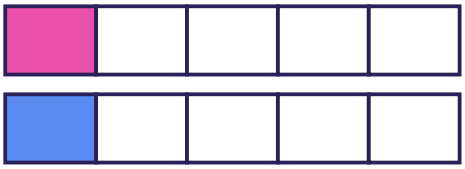

Task card 10 Fractions Basics (Mixed Review)

What fraction of the bar is shaded?



Task card 11 Fractions Basics (Mixed Review)

Compare: $\frac{6}{7}$ ___ $\frac{4}{7}$ (use <, >, or =)

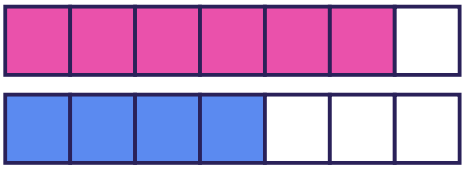

Task card 12 Fractions Basics (Mixed Review)

What fraction of the bar is shaded?



Task card 13 Fractions Basics (Mixed Review)

Compare: $\frac{1}{4}$ ___ $\frac{1}{4}$ (use <, >, or =)

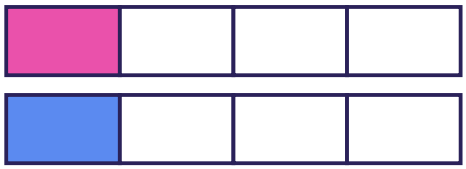

Task card 14 Fractions Basics (Mixed Review)

What fraction of the bar is shaded?



Task card 15 Fractions Basics (Mixed Review)

Compare: $\frac{4}{6}$ ___ $\frac{5}{6}$ (use <, >, or =)

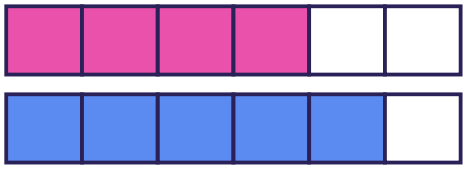

Task card 16 Fractions Basics (Mixed Review)

What fraction of the bar is shaded?



Task card 17 Fractions Basics (Mixed Review)

Compare: $\frac{2}{8}$ ___ $\frac{2}{8}$ (use <, >, or =)

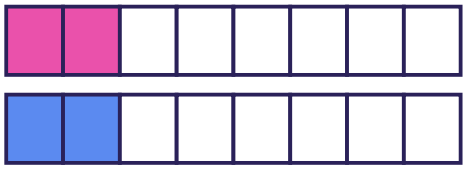

Task card 18 Fractions Basics (Mixed Review)

Compare: $\frac{2}{3}$ ___ $\frac{1}{3}$ (use <, >, or =)

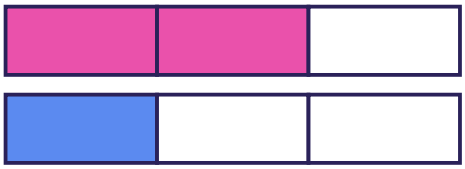

Task card 19 Fractions Basics (Mixed Review)

Compare: $\frac{4}{5}$ ___ $\frac{3}{5}$ (use <, >, or =)

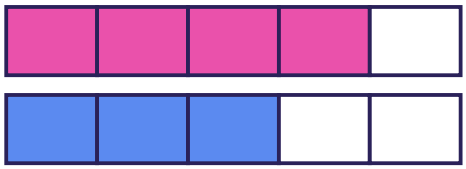

Task card 20 Fractions Basics (Mixed Review)

What fraction of the bar is shaded?



Task card 21 Fractions Basics (Mixed Review)

Compare: $\frac{5}{7}$ ___ $\frac{3}{7}$ (use <, >, or =)

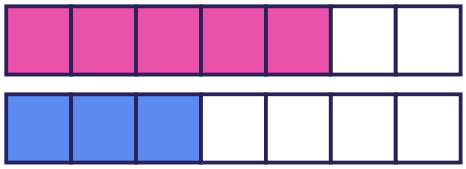

Task card 22 Fractions Basics (Mixed Review)

Compare: $\frac{4}{6}$ ___ $\frac{3}{6}$ (use <, >, or =)

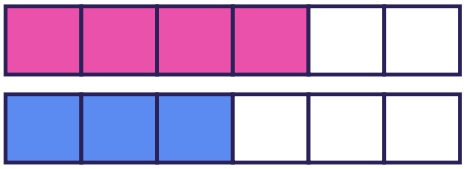

Task card 23 Fractions Basics (Mixed Review)

What fraction of the bar is shaded?



Task card 24 Fractions Basics (Mixed Review)

What fraction of the bar is shaded?



Fractions Basics (Mixed Review) Task Cards

Recording sheet · Grade 3 · Answer each question.

Name: _____ Date: _____

Scan to check your answers

1	2	3	4
5	6	7	8
9	10	11	12
13	14	15	16
17	18	19	20
21	22	23	24

Fractions Basics (Mixed Review) Task Cards: Answer Key

Grade 3 · Medium

The answers online

1. $\frac{2}{5}$	**2.** =	**3.** $\frac{1}{2}$
4. =	**5.** $\frac{1}{3}$	**6.** =
7. $\frac{2}{3}$	**8.** >	**9.** =
10. $\frac{5}{7}$	**11.** >	**12.** $\frac{3}{4}$
13. =	**14.** $\frac{1}{7}$	**15.** <
16. $\frac{1}{5}$	**17.** =	**18.** >
19. >	**20.** $\frac{6}{7}$	**21.** >
22. >	**23.** $\frac{4}{6}$	**24.** $\frac{1}{6}$