Fractions Basics (Mixed Review) · 1

What fraction of the bar is shaded?



Fractions Basics (Mixed Review) · 2

Compare: $\frac{1}{3}$ ___ $\frac{2}{3}$ (use <, >, or =)

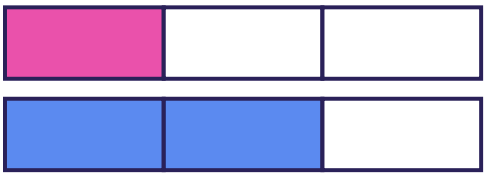

Fractions Basics (Mixed Review) · 3

What fraction of the bar is shaded?



Fractions Basics (Mixed Review) · 4

Compare: $\frac{2}{3}$ ___ $\frac{2}{3}$ (use <, >, or =)

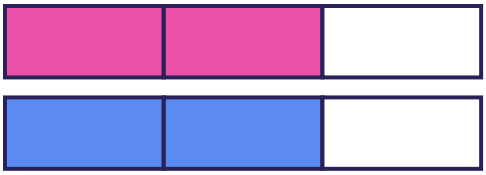

Fractions Basics (Mixed Review) · 5

What fraction of the bar is shaded?



Fractions Basics (Mixed Review) · 6

Compare: $\frac{1}{2}$ ___ $\frac{1}{2}$ (use <, >, or =)

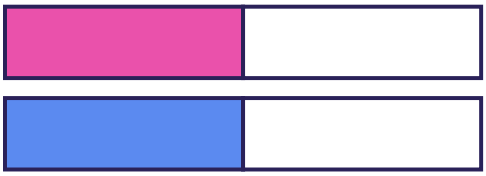

Fractions Basics (Mixed Review) · 7

Compare: $\frac{2}{3}$ ___ $\frac{1}{3}$ (use <, >, or =)

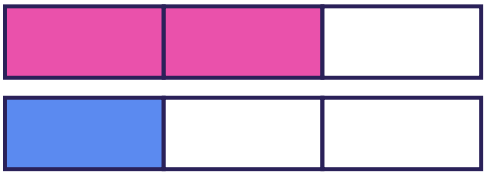

Fractions Basics (Mixed Review) · 8

Compare: $\frac{1}{3}$ ___ $\frac{1}{3}$ (use <, >, or =)

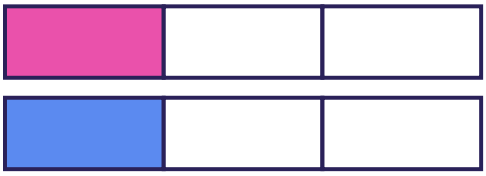

Fractions Basics (Mixed Review) · 2

ANSWER

$<$

Fractions Basics (Mixed Review) · 1

ANSWER

$\frac{1}{2}$

Fractions Basics (Mixed Review) · 4

ANSWER

$=$

Fractions Basics (Mixed Review) · 3

ANSWER

$\frac{1}{3}$

Fractions Basics (Mixed Review) · 6

ANSWER

$=$

Fractions Basics (Mixed Review) · 5

ANSWER

$\frac{2}{3}$

Fractions Basics (Mixed Review) · 8

ANSWER

$=$

Fractions Basics (Mixed Review) · 7

ANSWER

$>$

Compare: $\frac{2}{4}$ ___ $\frac{2}{4}$ (use <, >, or =)

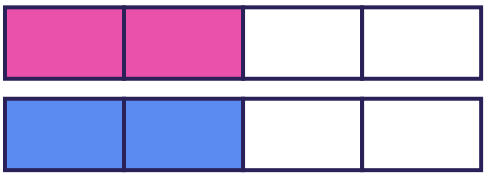

What fraction of the bar is shaded?



What fraction of the bar is shaded?



Compare: $\frac{1}{4}$ ___ $\frac{3}{4}$ (use <, >, or =)

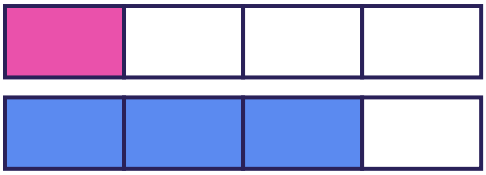

Compare: $\frac{2}{5}$ ___ $\frac{4}{5}$ (use <, >, or =)

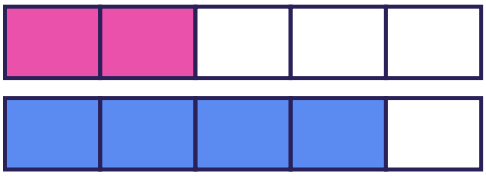

What fraction of the bar is shaded?



Compare: $\frac{1}{5}$ ___ $\frac{3}{5}$ (use <, >, or =)

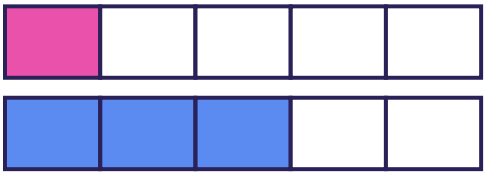

What fraction of the bar is shaded?



Fractions Basics (Mixed Review) · 10

ANSWER

$\frac{3}{4}$

Fractions Basics (Mixed Review) · 9

ANSWER

=

Fractions Basics (Mixed Review) · 12

ANSWER

<

Fractions Basics (Mixed Review) · 11

ANSWER

$\frac{1}{4}$

Fractions Basics (Mixed Review) · 14

ANSWER

$\frac{1}{5}$

Fractions Basics (Mixed Review) · 13

ANSWER

<

Fractions Basics (Mixed Review) · 16

ANSWER

$\frac{2}{4}$

Fractions Basics (Mixed Review) · 15

ANSWER

<

Compare: $\frac{2}{4}$ ___ $\frac{1}{4}$ (use <, >, or =)

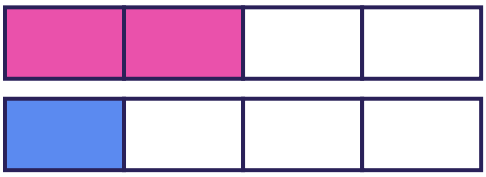

Compare: $\frac{1}{4}$ ___ $\frac{1}{4}$ (use <, >, or =)

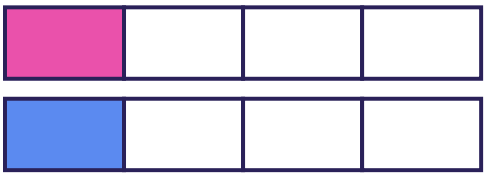

What fraction of the bar is shaded?



What fraction of the bar is shaded?



Compare: $\frac{3}{5}$ ___ $\frac{2}{5}$ (use <, >, or =)

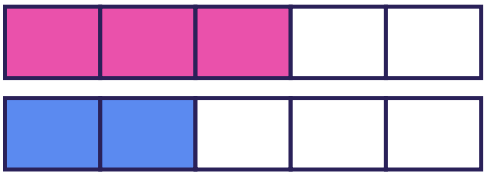

Compare: $\frac{2}{4}$ ___ $\frac{3}{4}$ (use <, >, or =)

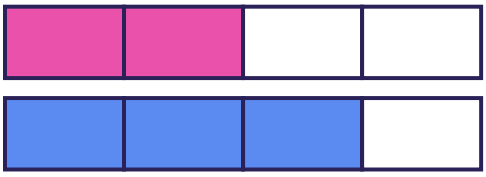

Compare: $\frac{3}{4}$ ___ $\frac{3}{4}$ (use <, >, or =)

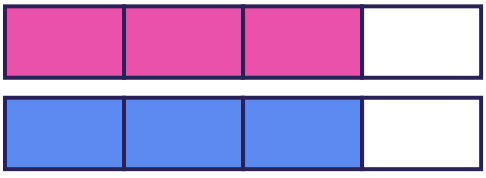

Compare: $\frac{2}{5}$ ___ $\frac{1}{5}$ (use <, >, or =)

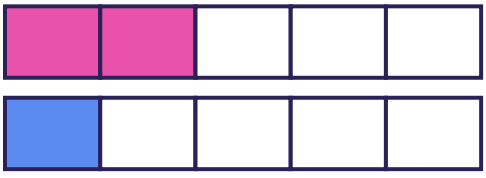

Fractions Basics (Mixed Review) · 18

ANSWER

=

Fractions Basics (Mixed Review) · 17

ANSWER

>

Fractions Basics (Mixed Review) · 20

ANSWER

$\frac{2}{5}$

Fractions Basics (Mixed Review) · 19

ANSWER

$\frac{3}{5}$

Fractions Basics (Mixed Review) · 22

ANSWER

<

Fractions Basics (Mixed Review) · 21

ANSWER

>

Fractions Basics (Mixed Review) · 24

ANSWER

>

Fractions Basics (Mixed Review) · 23

ANSWER

=