Task card 1 Equivalent Fractions with Models

$$\frac{1}{2} = \frac{\quad}{4}$$

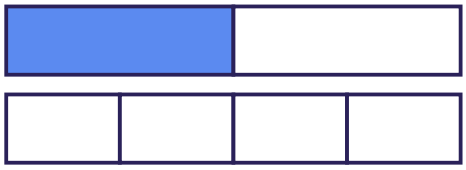

Task card 2 Equivalent Fractions with Models

$$\frac{2}{6} = \frac{\quad}{3}$$

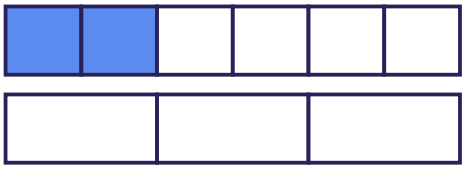

Task card 3 Equivalent Fractions with Models

Is $\frac{2}{4}$ equal to $\frac{5}{8}$? Write yes or no.

Task card 4 Equivalent Fractions with Models

$\frac{1}{2}$ of the first circle is shaded. How many parts of the second circle must be shaded to show the same amount? $\frac{\quad}{4}$



Task card 5 Equivalent Fractions with Models

$$\frac{1}{2} = \frac{\quad}{6}$$

Task card 6 Equivalent Fractions with Models

$$\frac{3}{6} = \frac{\quad}{2}$$



Task card 7 Equivalent Fractions with Models

Is $\frac{2}{4}$ equal to $\frac{4}{8}$? Write yes or no.

Task card 8 Equivalent Fractions with Models

$$\frac{1}{2} = \frac{2}{__}$$

Task card 9 Equivalent Fractions with Models

$$\frac{1}{3} = \frac{__}{6}$$

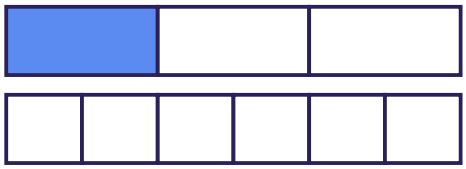

Task card 10 Equivalent Fractions with Models

$$\frac{2}{4} = \frac{__}{2}$$



Task card 11 Equivalent Fractions with Models

Is $\frac{1}{2}$ equal to $\frac{3}{6}$? Write yes or no.

Task card 12 Equivalent Fractions with Models

$\frac{1}{2}$ of the first circle is shaded. How many parts of the second circle must be shaded to show the same amount? $\frac{__}{4}$

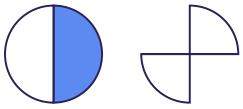

Task card 13 Equivalent Fractions with Models

$$\frac{1}{2} = \frac{\quad}{8}$$

Task card 14 Equivalent Fractions with Models

$$\frac{4}{6} = \frac{\quad}{3}$$

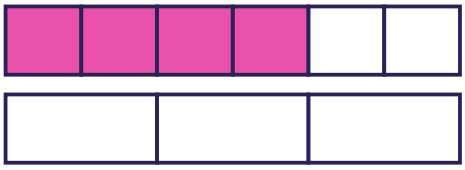

Task card 15 Equivalent Fractions with Models

Is $\frac{1}{2}$ equal to $\frac{4}{8}$? Write yes or no.

Task card 16 Equivalent Fractions with Models

$$\frac{1}{2} = \frac{\quad}{4}$$

Task card 17 Equivalent Fractions with Models

$$\frac{1}{2} = \frac{\quad}{6}$$

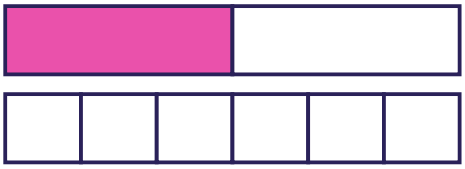

Task card 18 Equivalent Fractions with Models

$$\frac{2}{8} = \frac{\quad}{4}$$

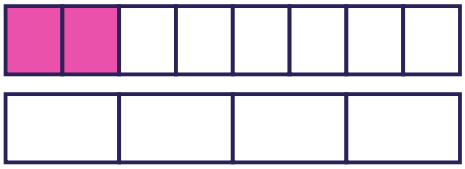

Task card 19 Equivalent Fractions with Models

Is $\frac{1}{3}$ equal to $\frac{2}{6}$? Write yes or no.

Task card 20 Equivalent Fractions with Models

$\frac{1}{2}$ of the first circle is shaded. How many parts of the second circle must be shaded to show the same amount? $\frac{__}{6}$

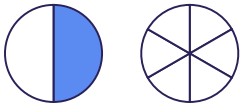

Task card 21 Equivalent Fractions with Models

$\frac{4}{8} = \frac{__}{2}$

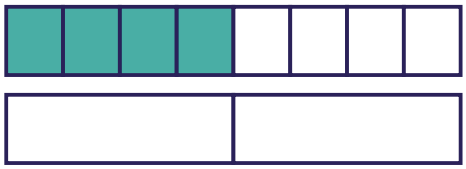

Task card 22 Equivalent Fractions with Models

Is $\frac{3}{4}$ equal to $\frac{6}{8}$? Write yes or no.

Task card 23 Equivalent Fractions with Models

$\frac{1}{2} = \frac{3}{__}$

Task card 24 Equivalent Fractions with Models

Is $\frac{1}{2}$ equal to $\frac{3}{4}$? Write yes or no.

Equivalent Fractions with Models Task Cards

Recording sheet · Grade 3 · The shapes in each problem are the same size. Find the missing number.

Name: _____ Date: _____

Scan to check your answers

1	2	3	4
5	6	7	8
9	10	11	12
13	14	15	16
17	18	19	20
21	22	23	24

Equivalent Fractions with Models Task Cards: Answer Key

Grade 3 · Medium

The answers online

1. 2	**2.** 1	**3.** no
4. 2	**5.** 3	**6.** 1
7. yes	**8.** 4	**9.** 2
10. 1	**11.** yes	**12.** 2
13. 4	**14.** 2	**15.** yes
16. 2	**17.** 3	**18.** 1
19. yes	**20.** 3	**21.** 1
22. yes	**23.** 6	**24.** no